Metodo di matematica pa enseñansa primario

buki di contesta

Conta cu mi

schrift di compas

3

Departamento di Enseñansa di Aruba

1 **cuanto bo ta mira?**
conta y marca.

1 • 2 •• 3 ••• 4 •••• 5 ••••• 6 ••••••

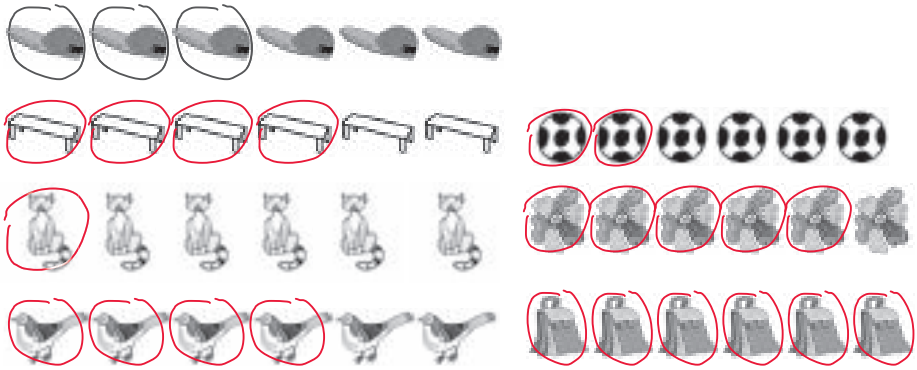

2

unda bo ta mira 5?
marca un cruz.

	X		X	

3

unda tin mes hopi?
conecta cu otro.

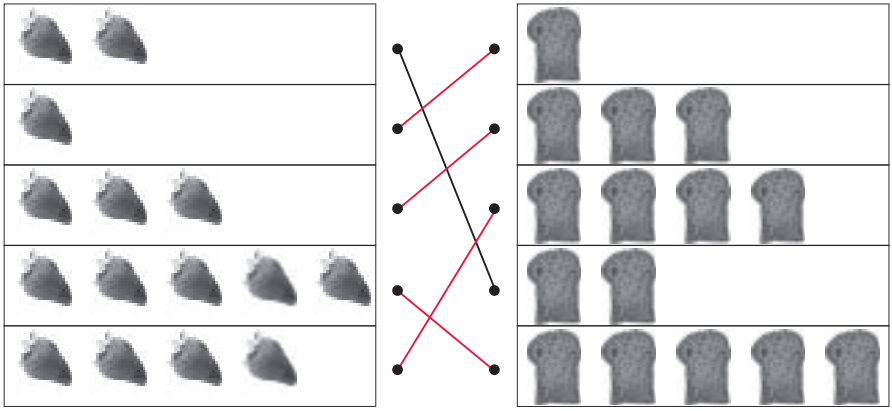

4

cuanto tin?
marca un ronchi.



1 2 3 4 5 6

1 2 3 4 5 6

1 2 3 4 5 6

1 2 3 4 5 6

1 **ban conta.**
tin 5?
marca un cruz.

5? | X | | si | no

5? | | X | si | no

5? | X | | si | no

5? | X | | si | no

5? | X | | si | no

5? | | X | si | no

2 **conecta cu otro.**

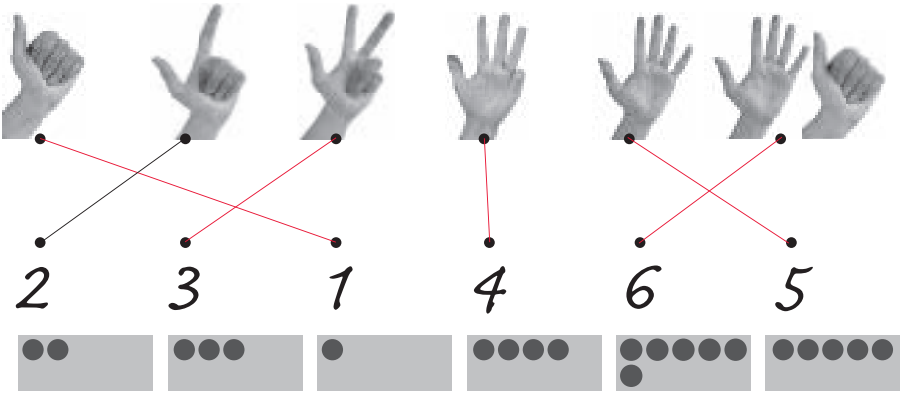

3 kleur mes hopi.

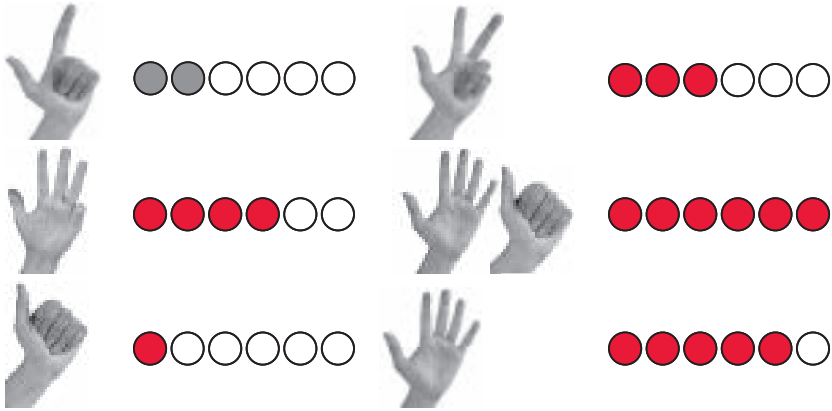

4 marca cada biaha 3.



5 marca cada biaha 5.



1 **unda bo ta mira 3?**
marca un cruz.

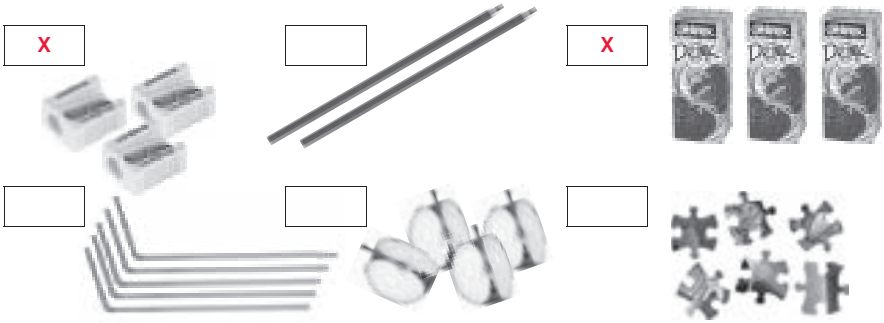

2 **unda bo ta mira 6?**
marca un cruz.

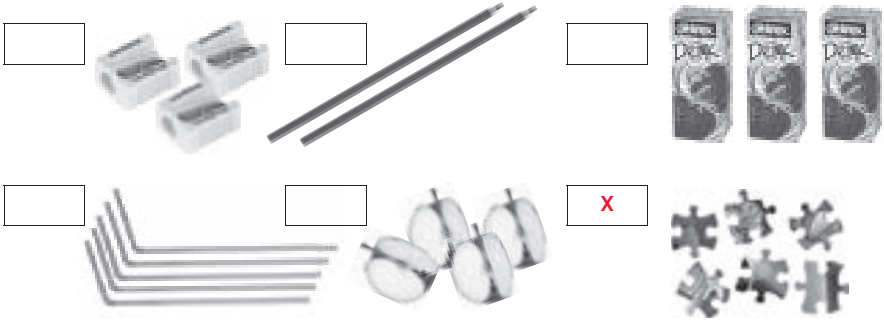

3 **kleur mes hopi.**



4 conecta cu otro.

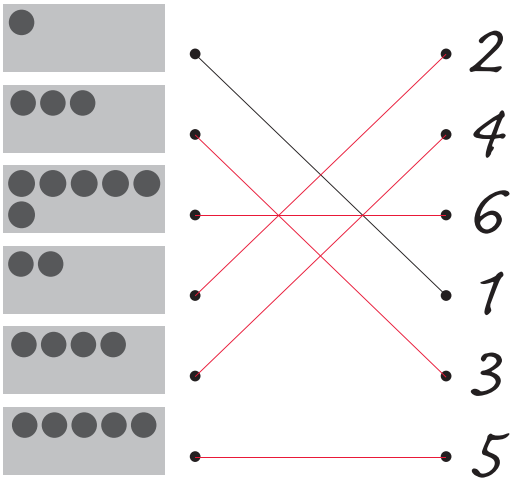

5 pinta mes hopi.

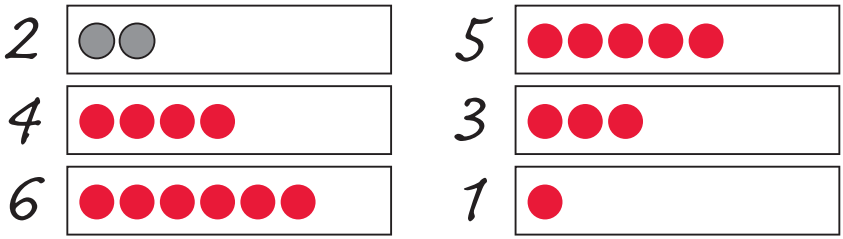

6 marca cada biaha 4.

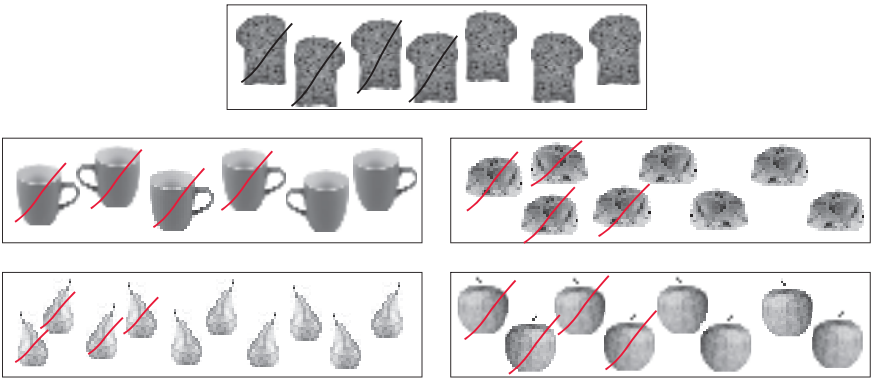

1 **conta riba dede.**
cua number ta pas?
conecta cu otro.

2 **kleur mes hopi.**

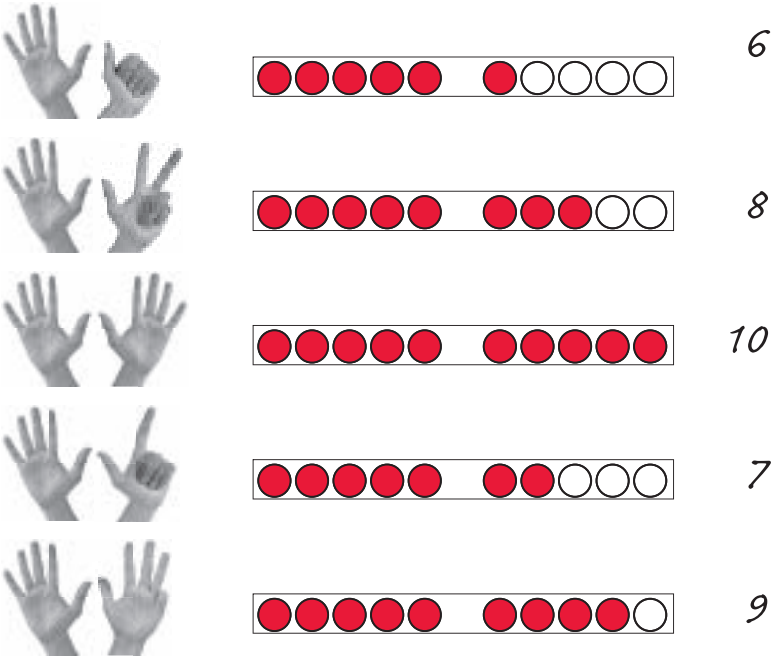

3 **unda bo ta mira 7?**
marca un cruz.

			X
	X		

4 **unda bo ta mira 9?**
marca un cruz.

	X		
			X

5 **marca cada biaha 8.**

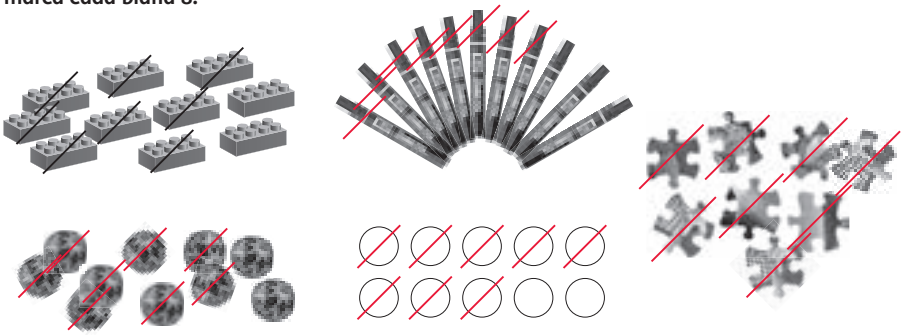

1

ban conta.
tin 7?
marca un cruz.

7?

si	no
X	

7?

si	no
	X

7?

si	no
	X

7?

si	no
	X

7?

si	no
X	

7?

si	no
X	

2

cuanto tin?
kleur mes hopi ronchi.

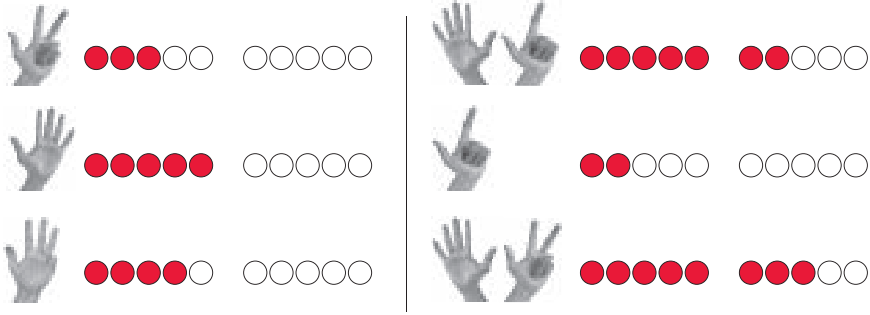

3

cuanto tin?
marca un ronchi.

1 2 3 4 5 6 7 8 9 10

1 2 3 4 5 6 7 8 9 10

1 2 3 4 5 6 7 8 9 10

1 2 3 4 5 6 7 8 9 10

1 2 3 4 5 6 7 8 9 10

1 2 3 4 5 6 7 8 9 10

4

conecta cu otro.
tin suficiente tayo?

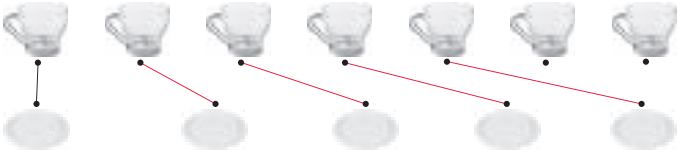

☐ si
☒ no

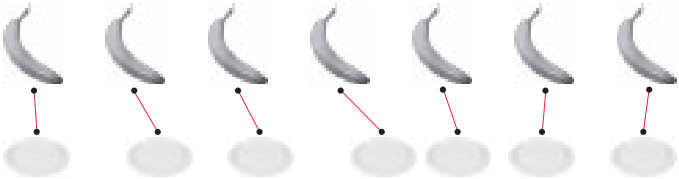

☒ si
☐ no

5

unda tin mes hopi?
conecta cu otro.

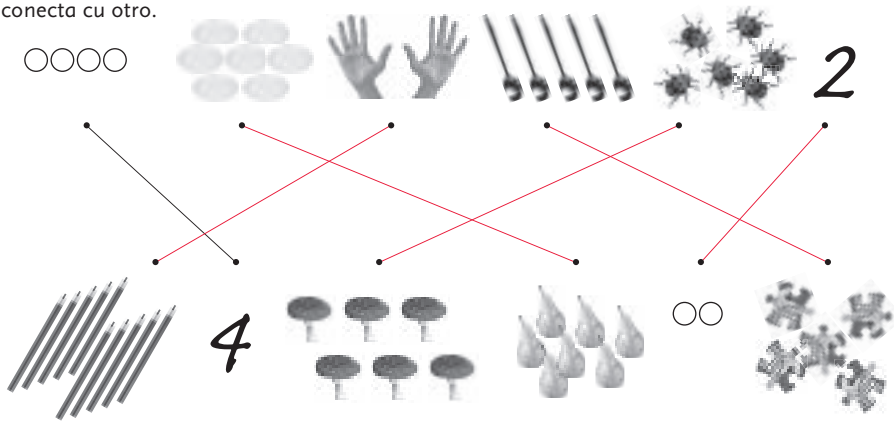

1 **cuanto tin?**
kleur mes hopi.

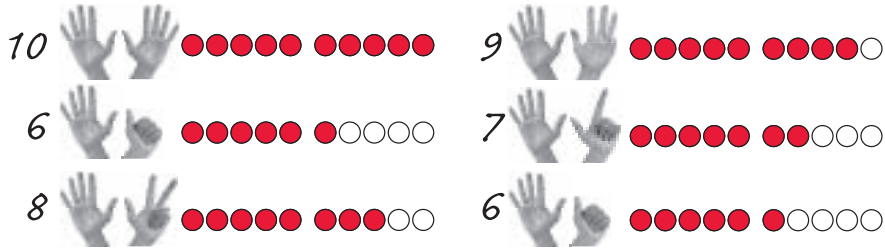

2 **conecta cu otro.**

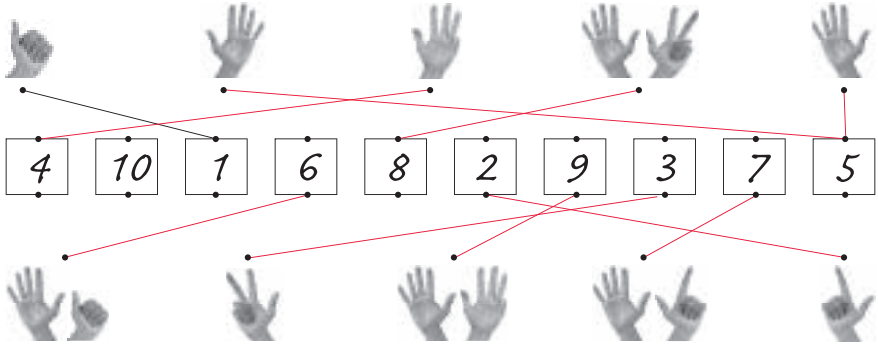

3 **marca cada biaha 5.**



4 **marca cada biaha 7.**



5 **marca cada biaha 8.**



6 **marca cada biaha 9.**



7 **cua number ta pas?**
marca un ronchi.

1 2 3 4 5 6 7 8 9 10

1 2 3 4 5 6 7 8 9 10

1 2 3 4 5 6 7 8 9 10

1 2 3 4 5 6 7 8 9 10

1 2 3 4 5 6 7 8 9 10

1 2 3 4 5 6 7 8 9 10

1

kico bo ta ripara?
cuanto mucha tin?

1 2 3 4 5 6 7 8 9 10

4 y 4 hunto ta 8

5 y 4 hunto ta 9

5 y 5 hunto ta 10

2

cuanto dede tin?
kleur mes hopi ronchi.

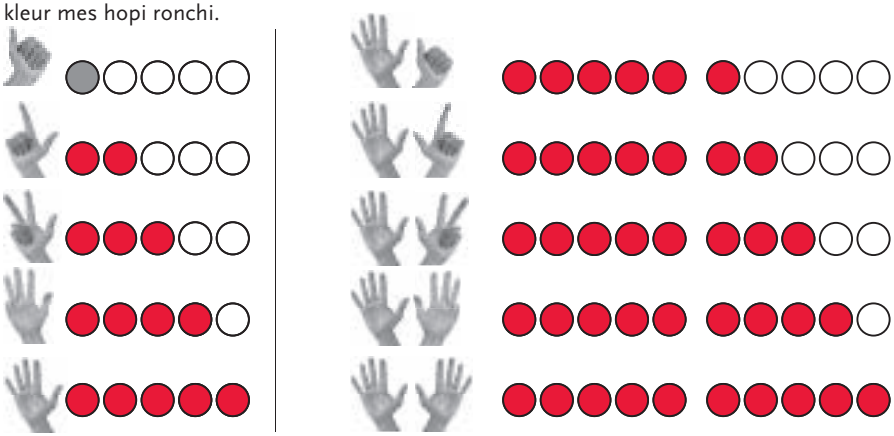

3

cuanto dede tin?
skirbi e number.

1 2 3 4 5 6 7 8 9 10

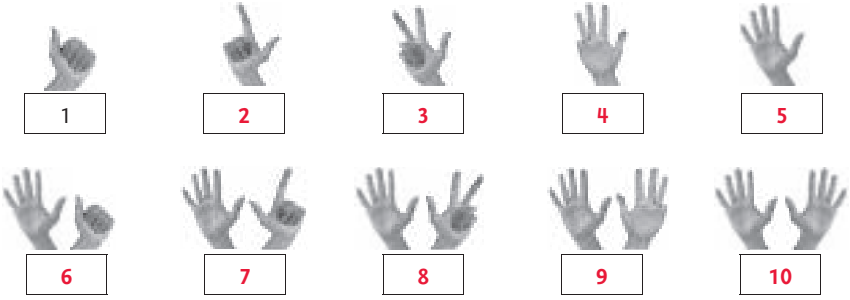

4

cuanto dede tin?
kleur mes hopi ronchi.



5

conecta 2 biaha.

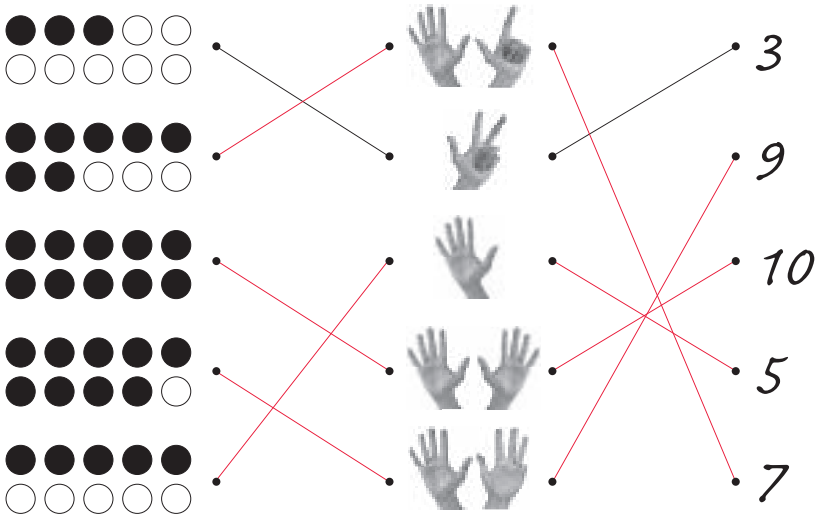

6

unda bo ta mira 5?
marca un cruz.

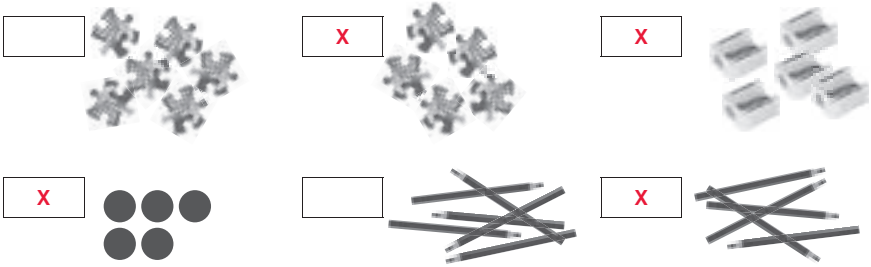

1 conecta 2 biaha.

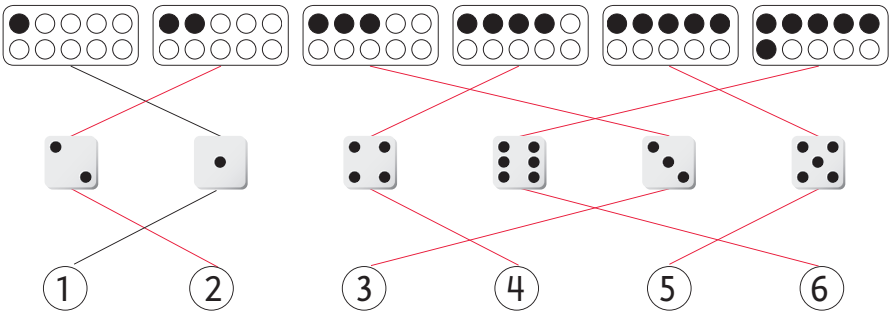

2 na unda e pion ta yega?

marca un cruz.

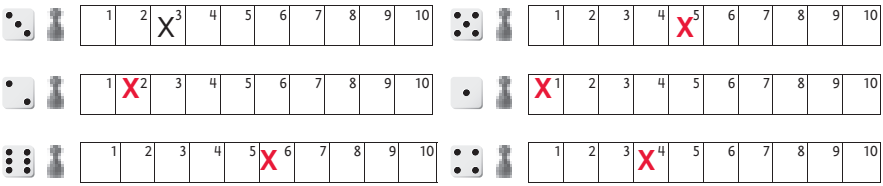

3 bo ta tira 2 dou.

na unda e pion ta yega?

marca un cruz.

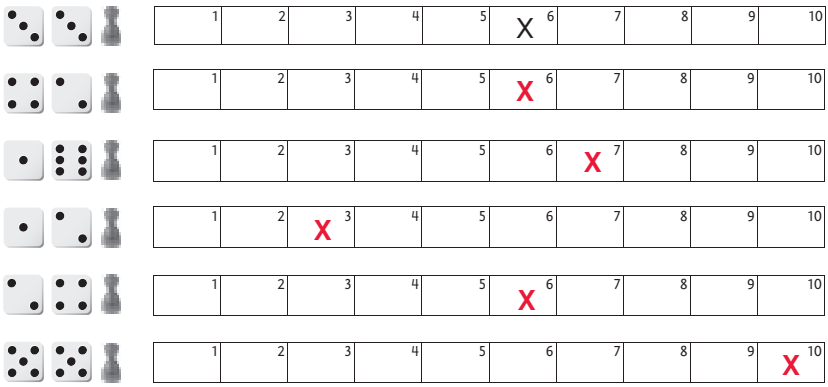

4

cuanto chuculati tin?
conecta cu otro.

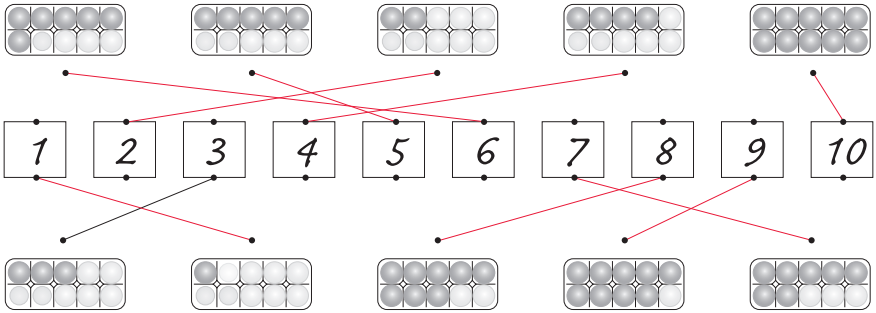

5

cuanto chuculati tin?
conecta cu otro.

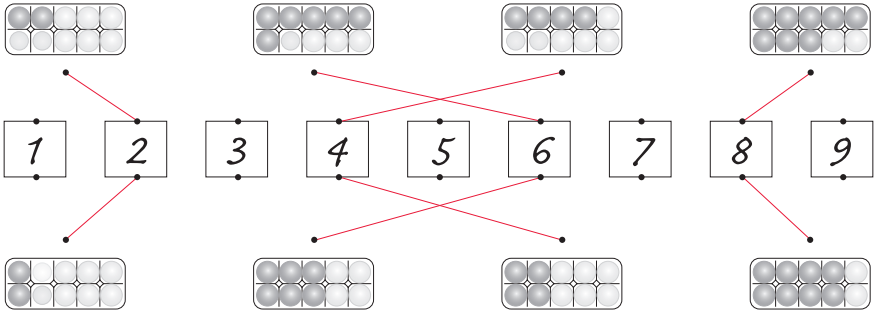

6

marca e number cu no ta pas.

1 2 ~~4~~ 3

6	~~4~~	7	8
3	~~7~~	4	5
7	~~6~~	8	9
5	6	~~8~~	7

4	5	6	~~9~~
2	3	4	~~6~~
8	~~6~~	9	10
1	~~5~~	2	3

1

cuanto dede tin?
kleur mes hopi ronchi.

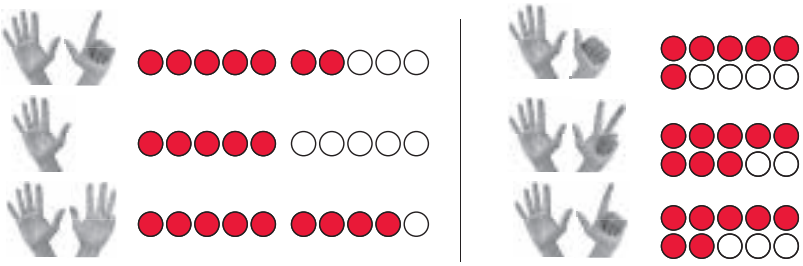

2

cuanto dede tin?
skirbi e number.

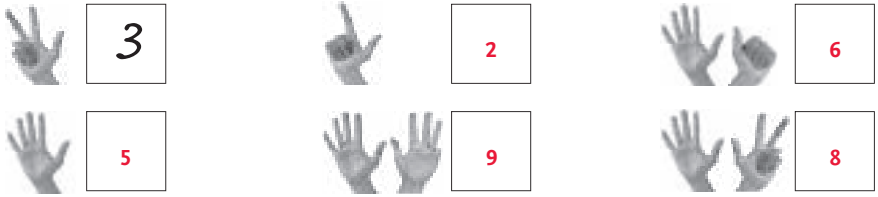

3

tin 5 di cada un?
marca si of no.



4

tin 10 di cada un?
marca si of no.



5

na unda e pion ta yega?
marca un cruz.

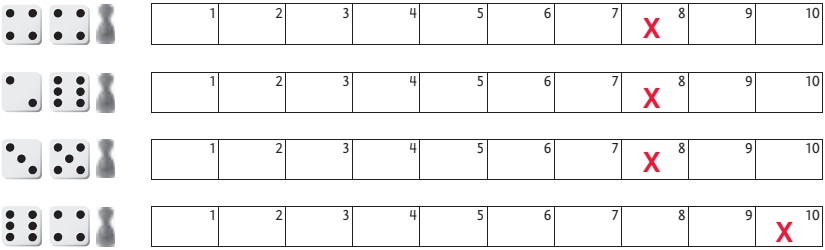

6

cuanto ronchi tin?
conecta cu otro.

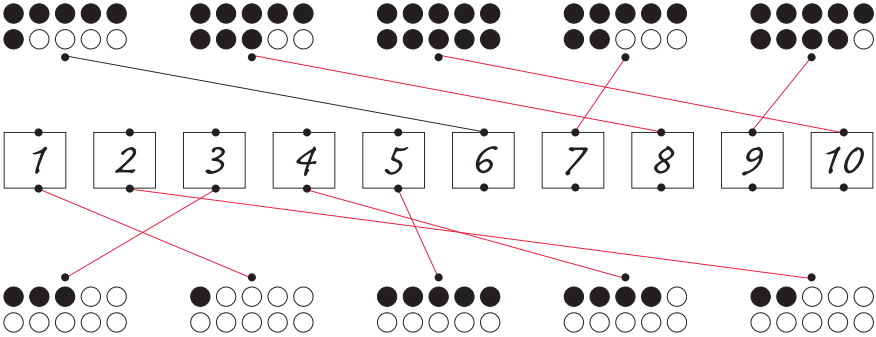

7

marca e number cu no ta pas.

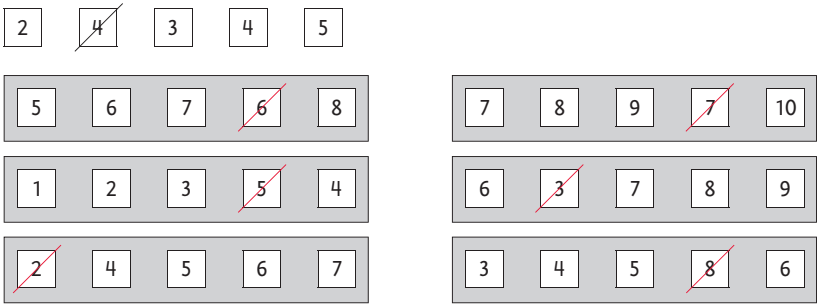

1 **cuanto placa bo tin?**
kico bo por cumpra?
conecta cu otro.

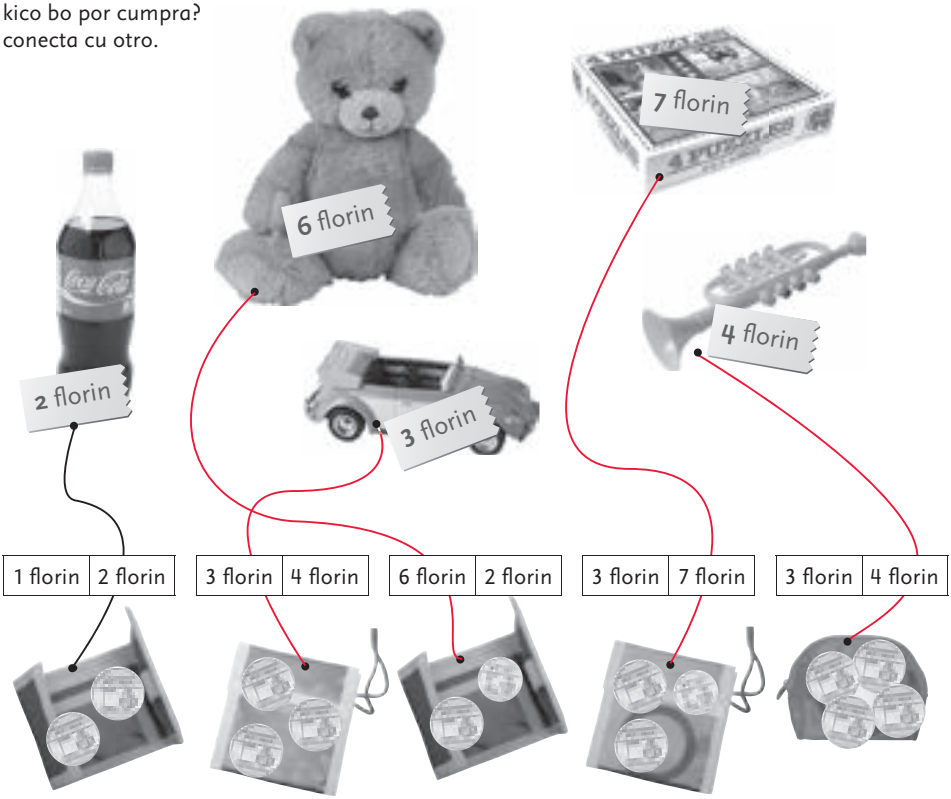

2 **con bo ta paga?**
kleur e monedanan.

2 florin	1	1	1	1	1	1	1	1	1	1
8 florin	1	1	1	1	1	1	1	1	1	1
5 florin	1	1	1	1	1	1	1	1	1	1
6 florin	1	1	1	1	1	1	1	1	1	1
4 florin	1	1	1	1	1	1	1	1	1	1
7 florin	1	1	1	1	1	1	1	1	1	1

3

con bo ta paga?
kleur e monedanan.

6 florin	5	1	1	1	1	1
9 florin	5	1	1	1	1	1
8 florin	5	1	1	1	1	1
10 florin	5	1	1	1	1	1
7 florin	5	1	1	1	1	1

4

unda tin 1 mas?
marca un cruz.

X of

of X

of X

X of

5

cuanto florin tin?

5 florin


8 florin

6 florin

4 florin

4 florin

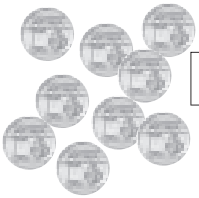
9 florin

1

hunto tin 5 kiniki.
cuanto kiniki tin banda di e bleki?
pinta nan.



2

con bo ta split?
yena e numbernan.

● ● ○	2	1
● ○ ○	1	2

● ● ○ ○	2	2
● ○ ○ ○	1	3
● ● ● ○	3	1

3

con bo ta split?
yena e numbernan.

● ● ● ○ ○	3	2
● ● ○ ○ ○	2	3
● ● ● ● ○	4	1
● ○ ○ ○ ○	1	4

4

kleur con bo ta split.
uza cada biaha 2 colo.

●	○	○	1	2
●	●	○	2	1

●	○	○	○	1	3
●	●	○	○	2	2
●	●	●	○	3	1

●	○	○	○	○	1	4
●	●	○	○	○	2	3
●	●	●	○	○	3	2
●	●	●	●	○	4	1

5

na unda e pion ta yega?
marca un cruz.

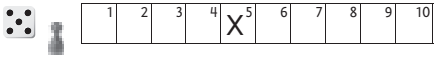

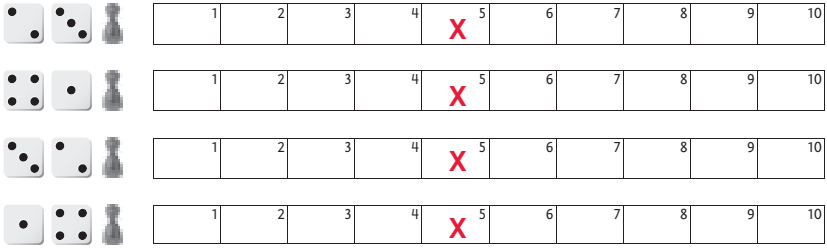

6

cua dou ta pas?
conecta cu otro.



1

con bo ta paga?
kleur e monedanan.

3 florin	1 1 1 1 1 1 1 1 1 1
6 florin	1 1 1 1 1 1 1 1 1 1
9 florin	1 1 1 1 1 1 1 1 1 1

2

cuanto bo por cumpra?
kleur e blekinan.

2 florin	f2	f2	f2	f2	f2	f2
4 florin	f2	f2	f2	f2	f2	f2
6 florin	f2	f2	f2	f2	f2	f2
10 florin	f2	f2	f2	f2	f2	f2

3

cuanto florin tin?
conecta cu otro.

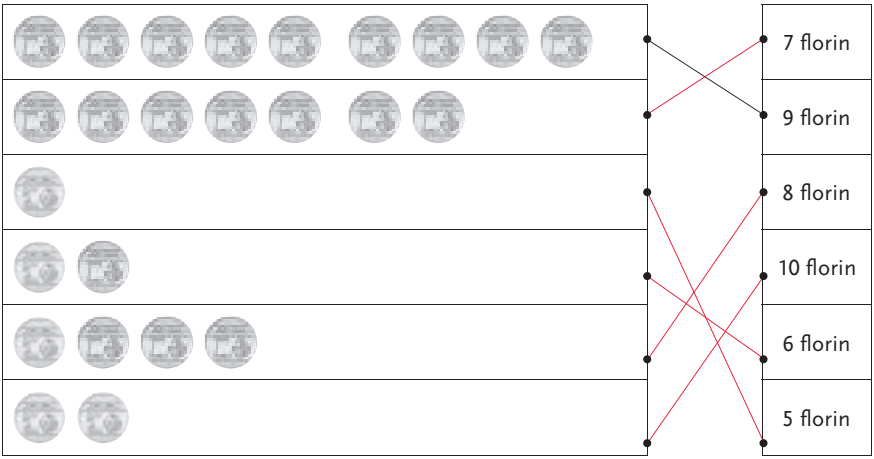

4 **con bo ta split?**
yena e numbernan.

● ○ ○	1	2
● ● ● ○ ○	3	2
● ● ○ ○	2	2
● ● ● ○	3	1
● ● ● ● ○	4	1
● ○ ○ ○	1	3
● ● ○ ○ ○	2	3

5 **unda tin mes hopi?**
duna e hokinan e mesun colo.



6 **pinta cada biaha 2 mas.**

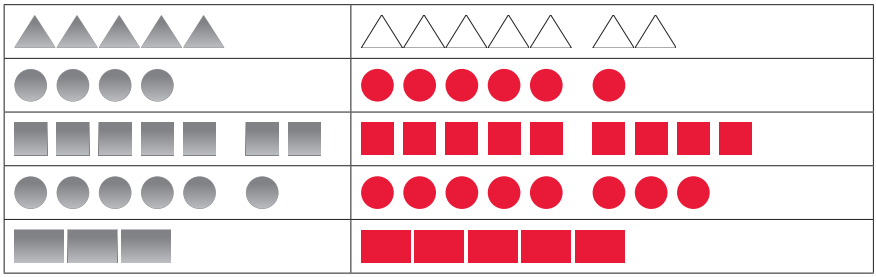

1 **kleur e numbernan.**

2 **con largo nan ta?**
pinta un strepi.
marca e number cu un ronchi.

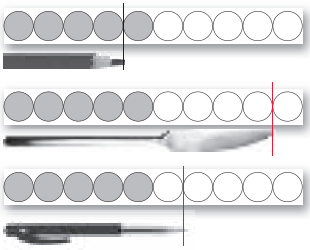

1 2 3 4 5 6 7 8 9 10

1 2 3 4 5 6 7 8 9 10

1 2 3 4 5 6 7 8 9 10

3 **con largo nan ta?**
pinta un strepi.
skirbi e number den e hoki.

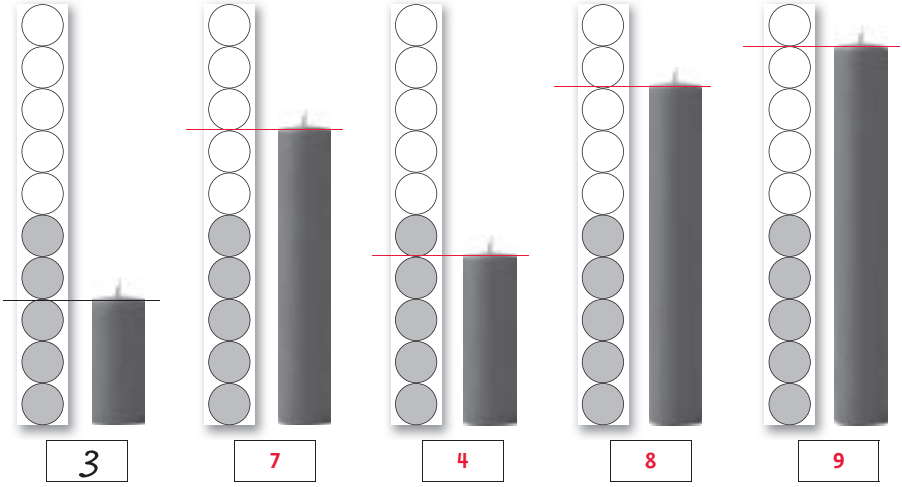

4

con largo e pidanan ta?
pinta un strepi.
despues yena e number.

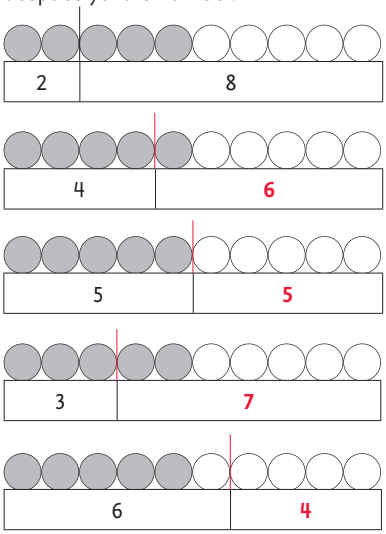

5

con largo e pidanan ta?

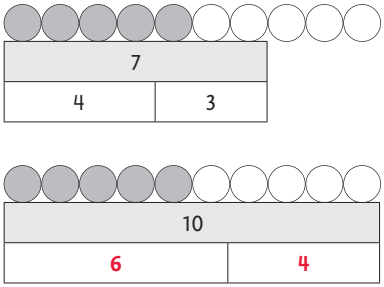

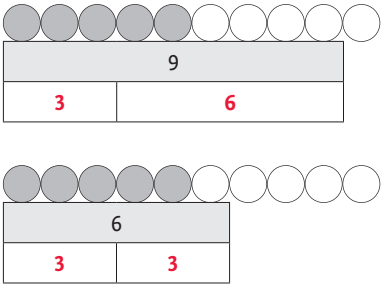

6

completa e rijnan.

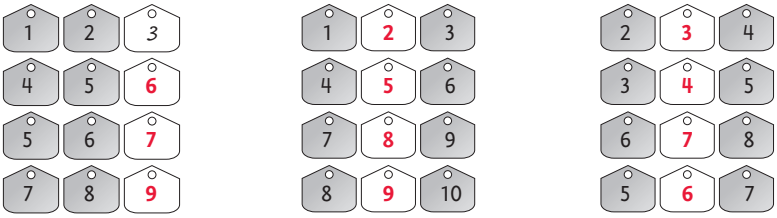

1 **pone e blokinan mescos.**
cuanto bloki bo ta uza?



3 5 5 4 5

2 **cua di nan ta mescos?**
duna nan e mesun colo.

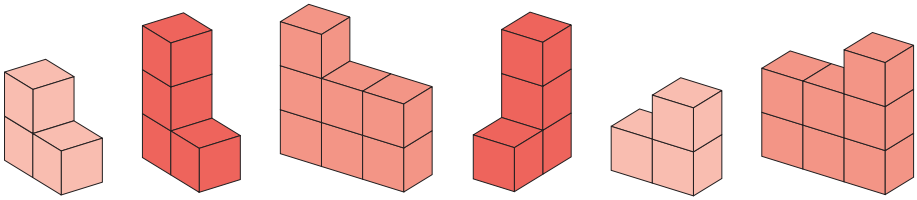

3 **cuanto bloki tin?**
pone e blokinan mescos.

4 6 8 10

abo mes pinta awor.
cuanto bloki tin?

4

cuanto bloki tin den e caha?
cuanto bloki tin banda di e caha?

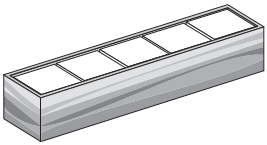

5 | 0

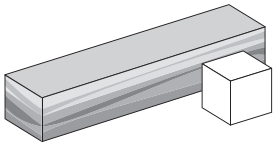

4 | 1

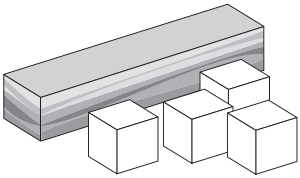

1 | 4

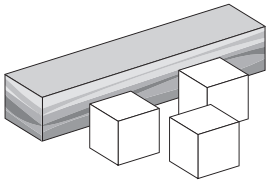

2 | 3

5

cuanto bloki tin den e caha?
cuanto bloki tin banda di e caha?

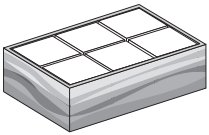

6 | 0

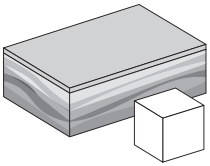

5 | 1

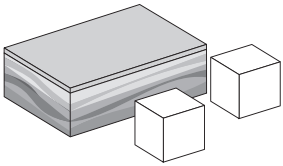

4 | 2

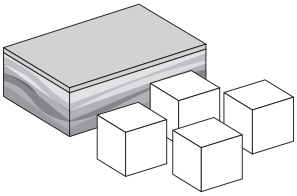

2 | 4

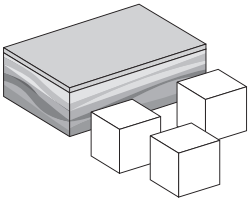

3 | 3

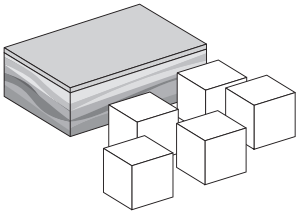

1 | 5

1 con largo nan ta?

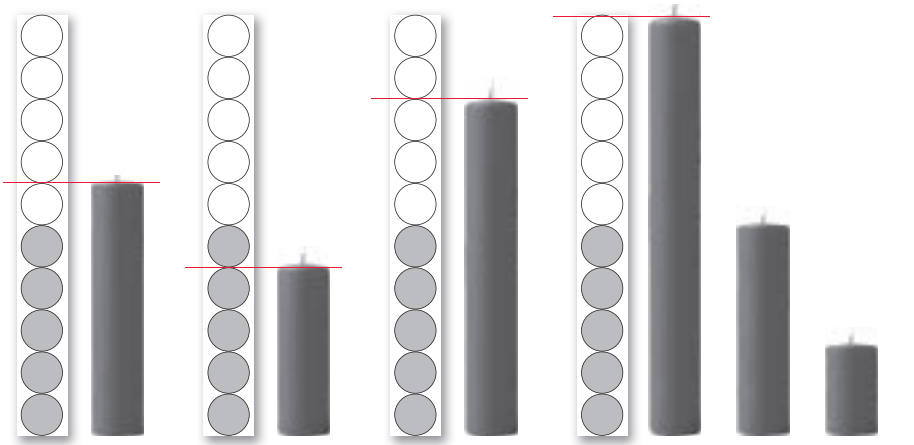

6 – 7 – 8	4 – 5 – 6	7 – 8 – 9	8 – 9 – 10	5	2

2 con largo cada pida ta?

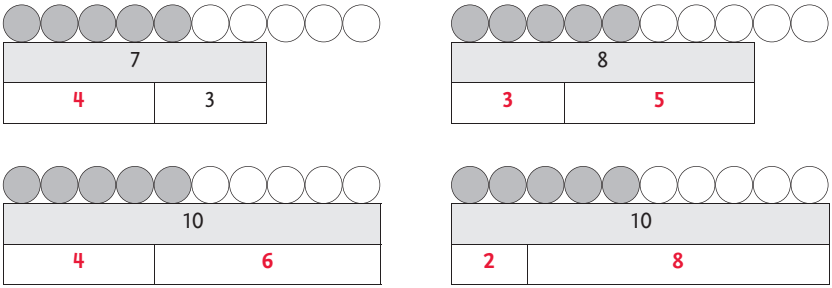

7	
4	3

8	
3	5

10	
4	6

10	
2	8

3 cuanto bloki tin den e caha?

cuanto bloki tin banda di e caha?

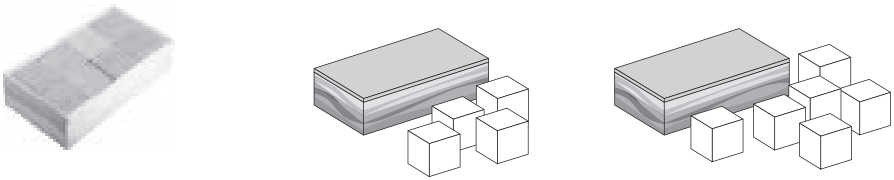

8	0	4	4	2	6

4

kleur con bo ta split.
uza cada biaha 2 colo.

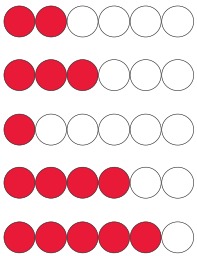

2	4
3	3
1	5
4	2
5	1

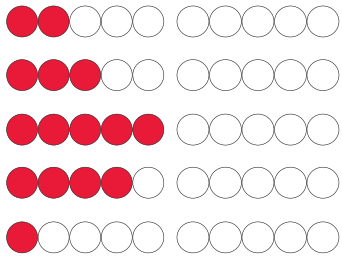

2	8
3	7
5	5
4	6
1	9

5

completa e rijnan.

1	2	**3**	7	**8**	9	6	**7**	8	**4**	5	6
4	5	**6**	8	**9**	10	3	**4**	5	**3**	4	5
5	6	**7**	1	**2**	3	2	**3**	4	**1**	2	3
7	8	**9**	4	**5**	6	5	**6**	7	**6**	7	8

6

conecta e numbernan.
cuminsa na 1.

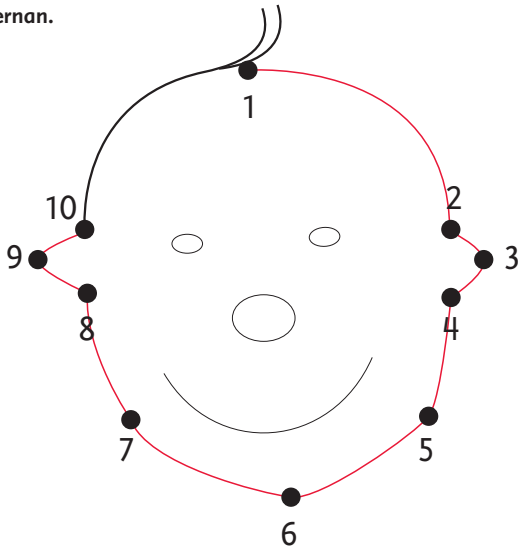

1

unda cu bo bira ta number bo ta mira.
yena e numbernan.

8 florin

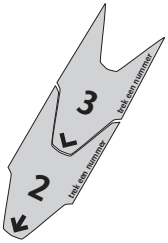

3 or

8 pia

7 tret



8 cralchi

2

cuanto tin hunto?

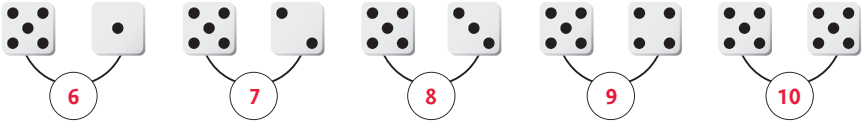

3

hunto tin 5.
pinta e wowonan.



4 cuanto tin?

	kleur mes hopi.	skirbi.
		5
		7
		9
		10

5 cuanto webo tin den e caha?

6

4

2

5

6 cuanto cuki tin den e caha?

10

8



6



4

7



5



3



1

1 **den cua hoki nan ta costa 5 florin?**
kleur e hoki.



2 **cuanto nan ta costa?**

3 **cuanto florin tin den e cartera?**
bo tin 5 florin:

bo ta mira:



den e cartera tin:

3 florin

bo ta mira:

den e cartera tin:

4 florin

bo ta mira:

den e cartera tin:

1 florin

bo ta mira:

den e cartera tin:

2 florin

4 cuanto dede tin?

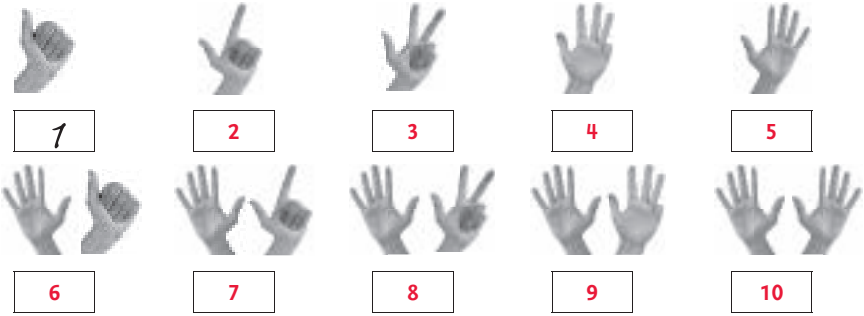

5 kleur cada biaha 1 ronchi mas.

4	kleur 1 mas.	●●●●● ○○○○○
6	kleur 1 mas.	●●●●● ●●○○○
7	kleur 1 mas.	●●●●● ●●●○○
9	kleur 1 mas.	●●●●● ●●●●●
3	kleur 1 mas.	●●●●○ ○○○○○
5	kleur 1 mas.	●●●●● ●○○○○
8	kleur 1 mas.	●●●●● ●●●●○

6 kleur cada biaha 1 ronchi menos.

10	kleur 1 menos.	●●●●● ●●●●○
6	kleur 1 menos.	●●●●● ○○○○○
7	kleur 1 menos.	●●●●● ●○○○○
9	kleur 1 menos.	●●●●● ●●●○○
3	kleur 1 menos.	●●○○○ ○○○○○

1 **traha grupo.**

traha grupo di 5.

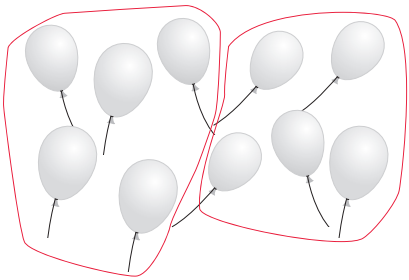

traha grupo di 7.



2 **traha grupo di 6.**

3 **cuanto tin hunto?**



4 **unda tin 5 kiniki?**

marca un cruz.

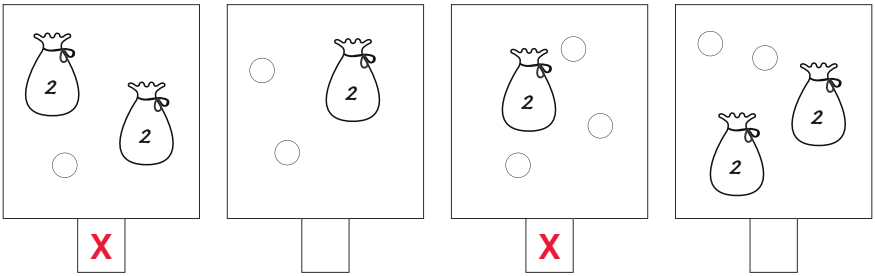

5 completa e rij.

4 5 **6**	1 2 **3**	8 9 **10**
6 7 **8**	5 6 **7**	3 4 **5**

6 cuanto bloki tin den e caha?



9	**4**	**6**	**8**

7 cua di nan tin mes hopi bloki?

conecta cu otro.

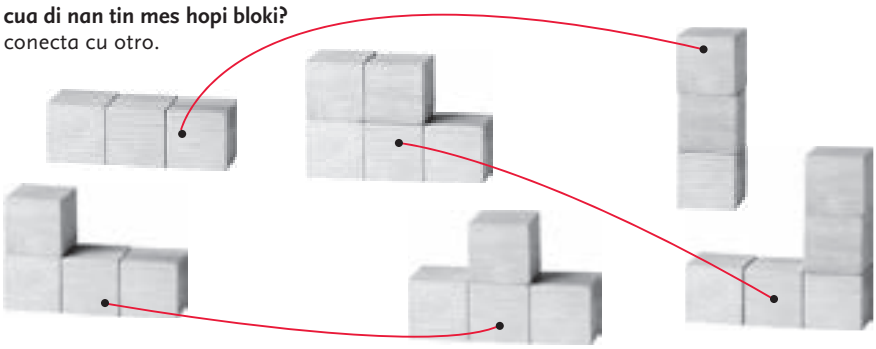

8 pinta e wowonan.

1 2 3 4 5 6

1

split 6.
kleur e ronchinan.

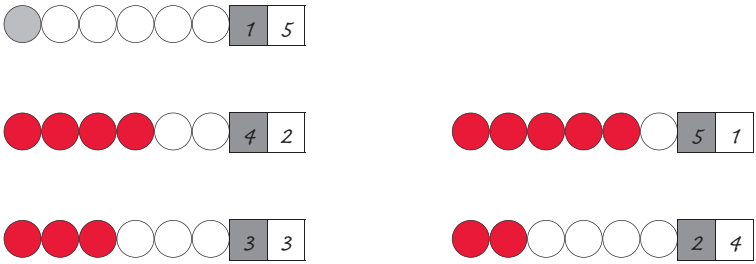

2

con largo cada pida ta?
yena e numbernan.

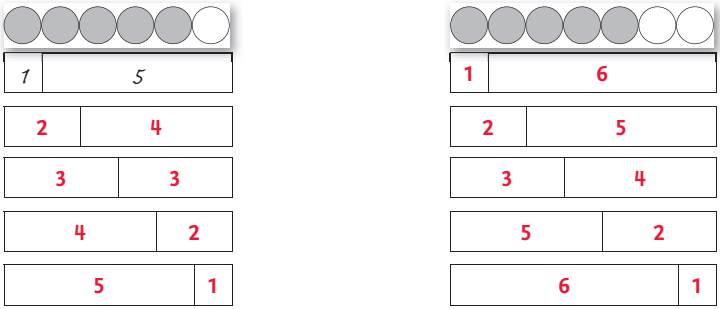

3

pinta e wowonan.

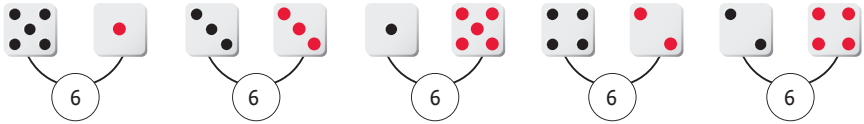

4

pinta e wowonan.

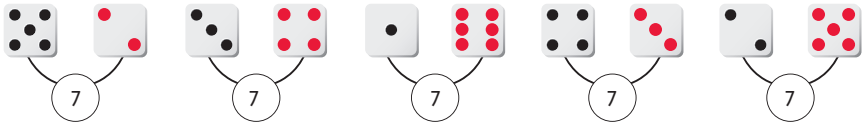

5 **con largo cada pida ta?**
yena e numbernan.

2	6
3	5
4	4
5	3
6	2

1	8
3	6
4	5
6	3
7	2

6 **kleur e monedanan.**

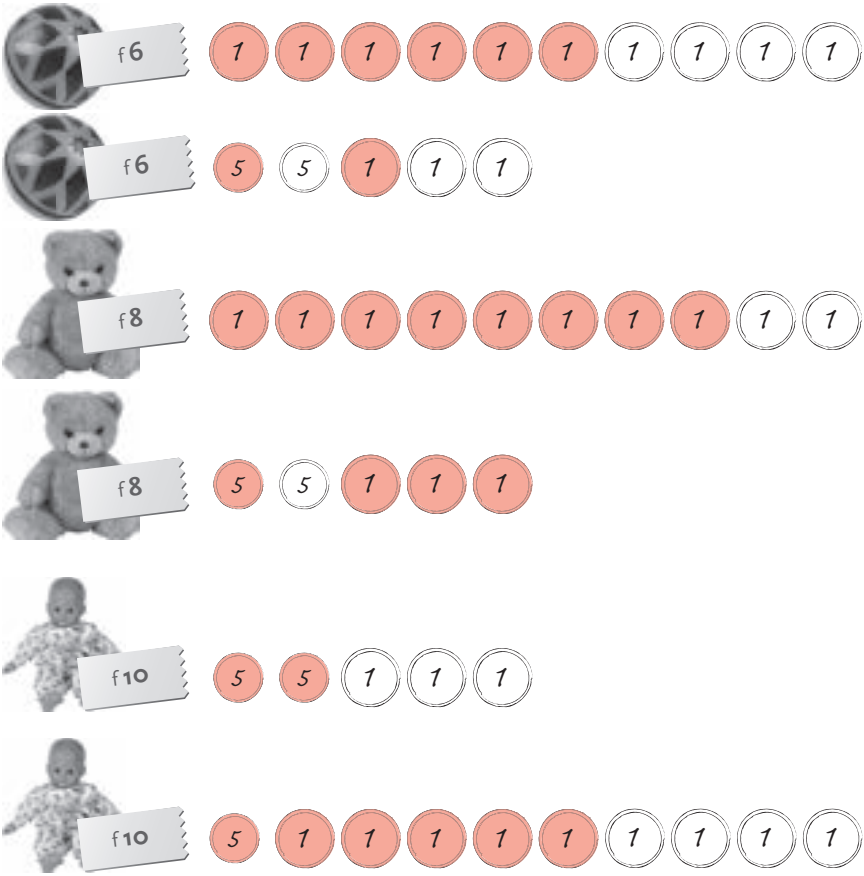

1 **split 5.**
conecta cu otro.

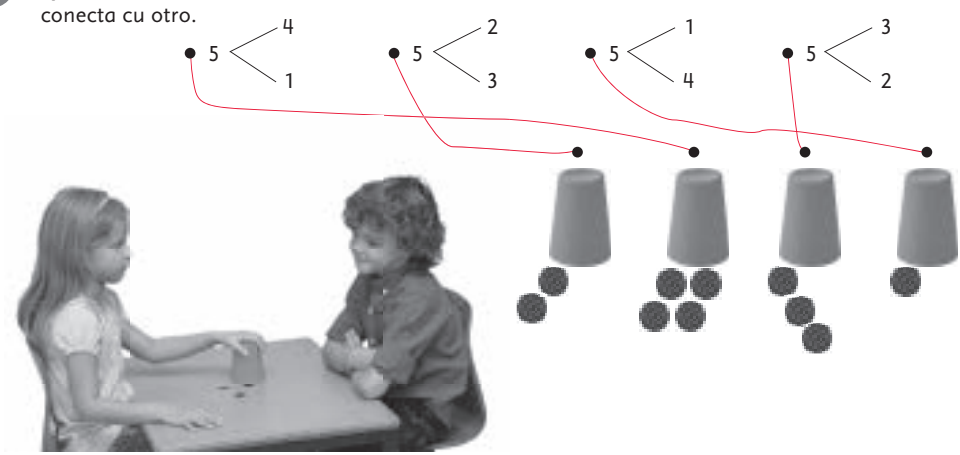

2 **split 6.**
pinta e blokinan.

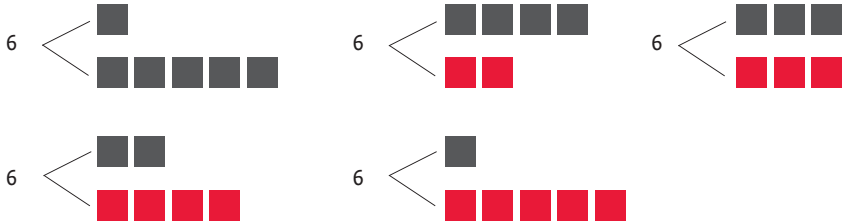

3 **split 7.**
conecta cu otro.

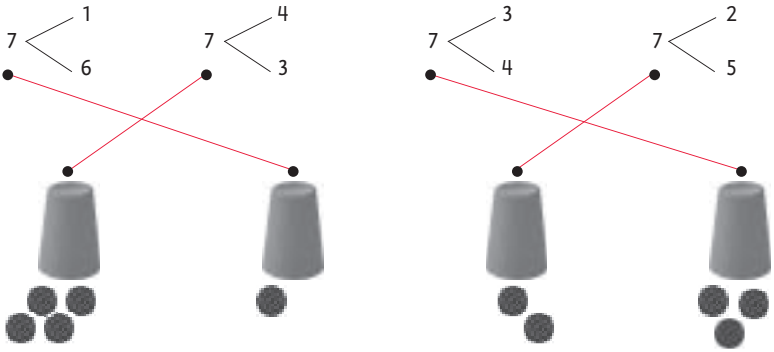

4

split 5.
pinta e streanan.

5

split 9.
pinta e blokinan.

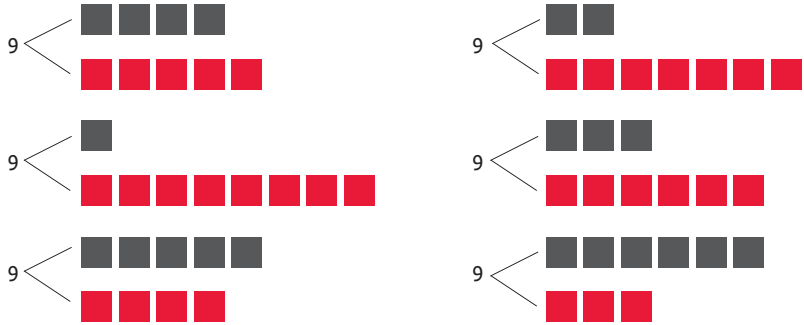

6

split 10.
pinta e strepi.

3 y 7

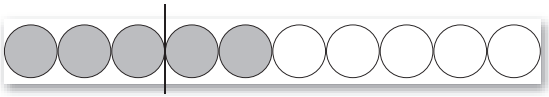

5 y 5

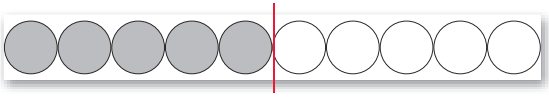

4 y 6

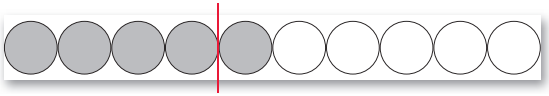

2 y 8

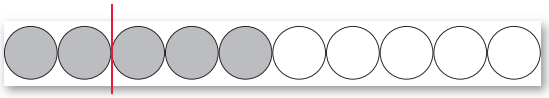

6 y 4

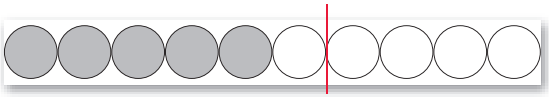

1 **con largo cada pida ta?**
yena e numbernan.

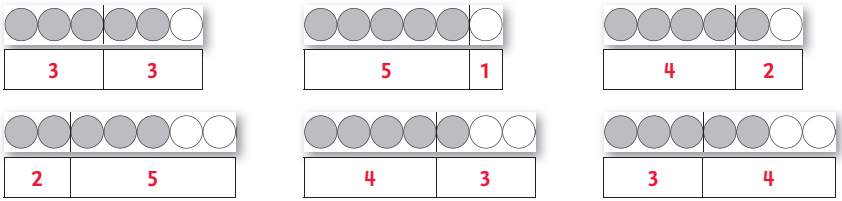

2 **pinta con bo ta split.**

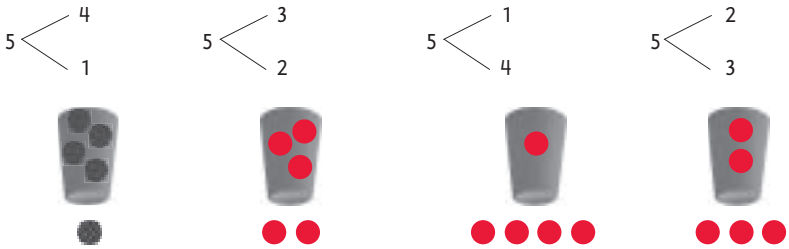

3 **split 7.**
pinta e blokinan.

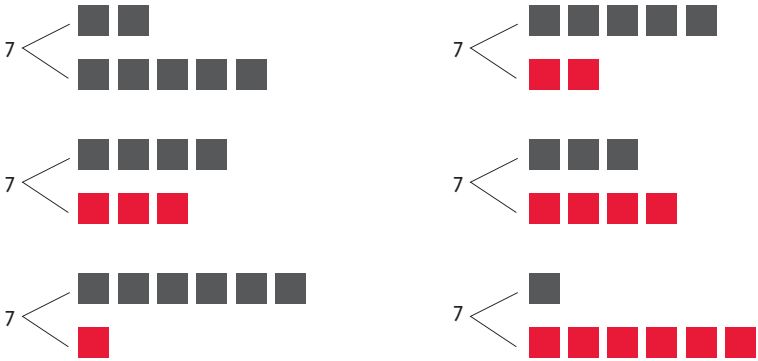

4 **abo mes split 10.**
con largo cada pida ta? **mas cu 1 contesta.**
pinta e strepi y yena e numbernan.

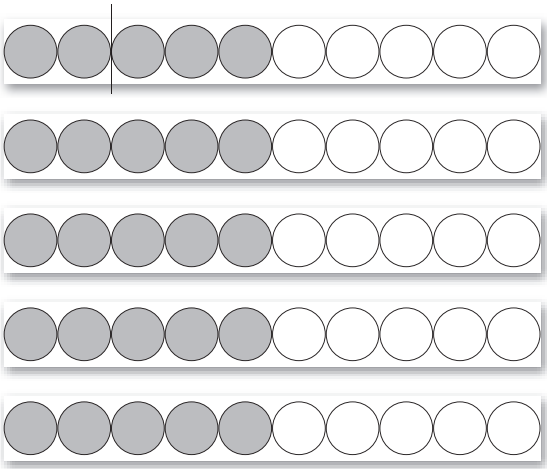

2 y 8

y

y

y

y

5 **cuanto tin hunto?**

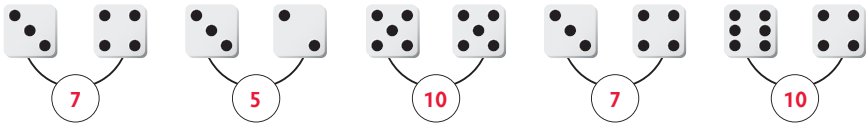

6 **pinta e wowonan.**

7 **split 9.** **mas cu 1 contesta.**
pinta bloki.

1 cuant'or tin?

marca un cruz.

- [x] 3 or
- [ ] 4 or
- [ ] 5 or

- [ ] 3 or
- [x] 4 or
- [ ] 5 or

- [x] 12 or
- [ ] 1 or
- [ ] 6 or

- [ ] 12 or
- [ ] 1 or
- [x] 6 or

- [ ] 12 or
- [ ] 2 or
- [x] 1 or

- [ ] 8 or
- [x] 7 or
- [ ] 6 or

- [ ] 4 or
- [x] 5 or
- [ ] 3 or

- [ ] 3 or
- [ ] 8 or
- [x] 9 or

2 cuant'or tin?

1 or

2 or

3 or

4 or

5 or

6 or

7 or

8 or

9 or

10 or

11 or

12 or

3

pinta e man chikito.
skirbi e numbernan riba e oloshi.

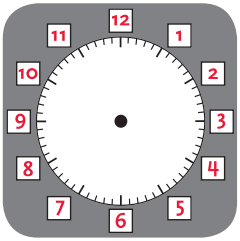

2 or

3 or

4 or

5 or

6 or

7 or

8 or

9 or

10 or

11 or

12 or

4

cuant'or tin?

9 or

2 or

6 or

11 or

4 or

1

cuanto popchi tin?
unda tin mes hopi?
conecta cu otro.

10

5

6

8

7

6

5

7

8

2

cuanto luga tin habri?

5 popchi
5 luga habri

8 popchi
2 luga habri

6 popchi
4 luga habri

7 popchi
3 luga habri

3 popchi
7 luga habri

4 popchi
6 luga habri

6 popchi
4 luga habri

9 popchi
1 luga habri

3 cuanto popchi tin hunto?

5 y 5 hunto ta 10

8 y 2 hunto ta 10

6 y 4 hunto ta 10

4 con largo cada pida ta?

2	8

4	6

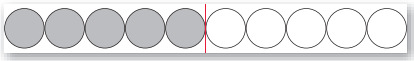

5	5

3	7

6	4

7	3

1 cuant'or tin?

1 or | 7 or | 3 or | 10 or | 12 or

2 pinta e man chikito.

5 or | 6 or | 7 or | 8 or | 4 or

3 cuanto cuki tin hunto?

7 y 3 hunto ta 10

9 y 1 hunto ta 10

4 cuanto cuki tin den e caha?



a 6 b 3 c 7

5

split 10.
pinta e strepi.

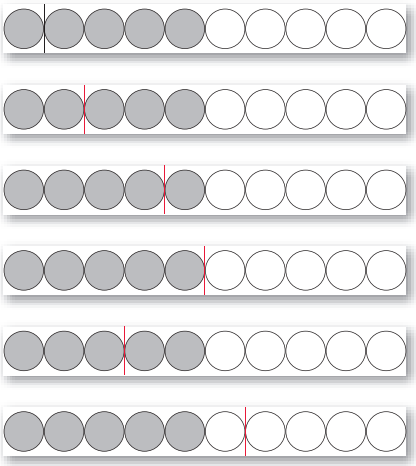

1	9
2	8
4	6
5	5
3	7
6	4

6

split 9.
pinta e blokinan y yena e numbernan.

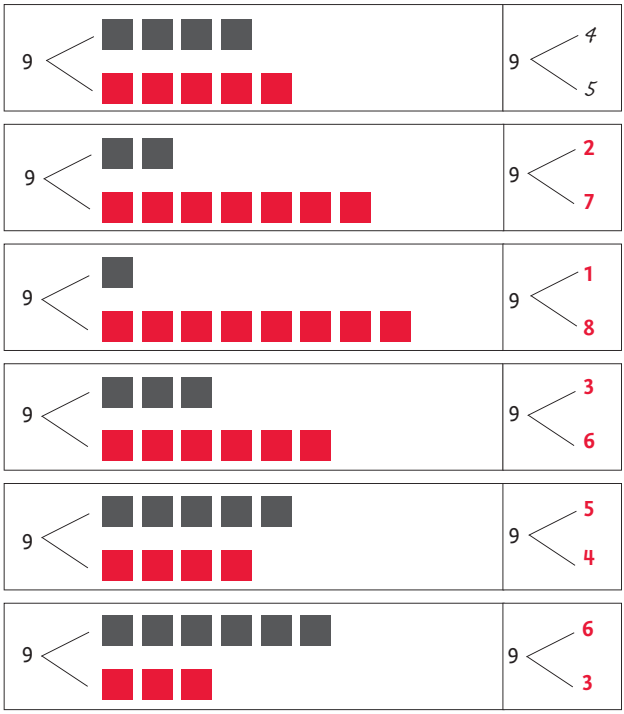

1 cuant'or tin?

2 or

3 or

4 or

6 or

8 or

9 or

10 or

11 or

2 yena e ora.

6 or

7 or

9 or

10 or

3 or

5 or

6 or

7 or

8 or

3

cada biaha 1 ora mas laat.
pinta e man chikito.
skirbi e ora.

1 or | 2 or | 3 or | 4 or | 5 or

4

cada biaha 1 ora mas laat.
pinta e man chikito.
skirbi e ora.

5 or | 6 or | 7 or | 8 or | 9 or

5

1 ora mas tempran.
pinta e man chikito.
skirbi e ora.

3 or | 2 or | 7 or | 6 or

6

split 8.
pinta e streanan y skirbi e numbernan.



1 con largo cada pida ta?

1	9
2	8
3	7
4	6
5	5

6	4
7	3
8	2
9	1
10	

2 con largo cada pida ta?

1	4	5
2	3	5
3	2	5
4	1	5
5		5

1	7	2
2	6	2
3	5	2
4	4	2
5	3	2

3 con largo cada pida ta?

1	5	4
2	4	4
3	3	4
4	2	4
5	1	4

1	6	3
2	5	3
3	4	3
4	3	3
5	2	3

4

cua ta pas cu otro?
conecta.

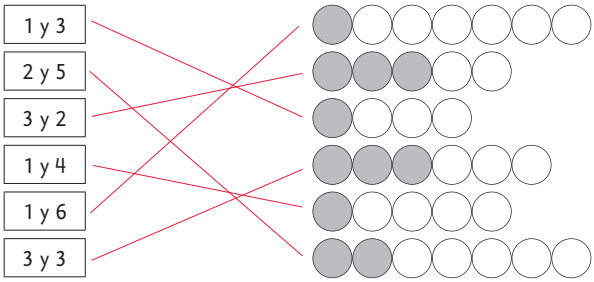

5

cuanto tin hunto?

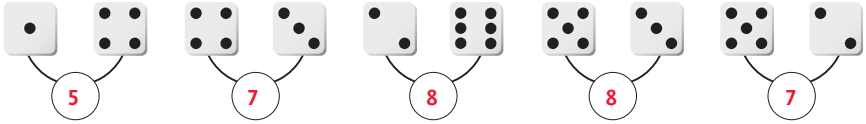

6

split 9.
pinta e kinikinan y skirbi e numbernan.

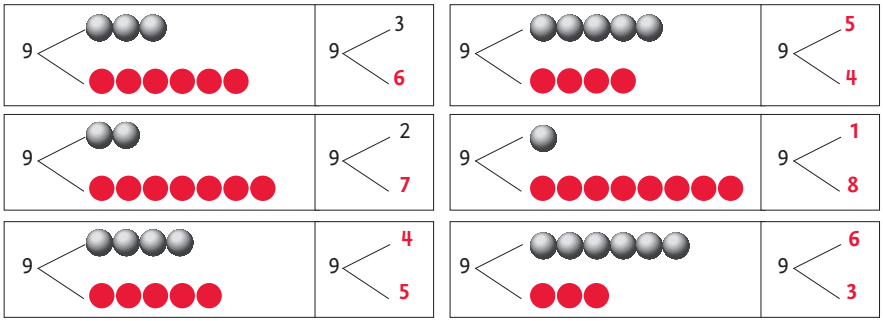

7

cuant'or tin?

7 or	9 or	5 or	3 or	1 or

1 cuant'or tin?

3 or	1 or	11 or	5 or	9 or

2 cada biaha 1 ora mas laat.

pinta e man chikito.
skirbi e ora.

9 or	10 or	11 or	12 or	1 or

3 1 ora mas tempran.

pinta e man chikito.
skirbi e ora.

5 or	4 or	9 or	8 or

4 con largo cada pida ta?

1	8	1
2	7	1
3	6	1
4	5	1

5	4	1
6	3	1
7	2	1
8	1	1

5

split 10.
pinta e blokinan y skirbi e numbernan.

10	10 < 3 / 7
10	10 < 2 / 8
10	10 < 4 / 6
10	10 < 5 / 5
10	10 < 1 / 9
10	10 < 6 / 4

6

cuanto tin hunto?

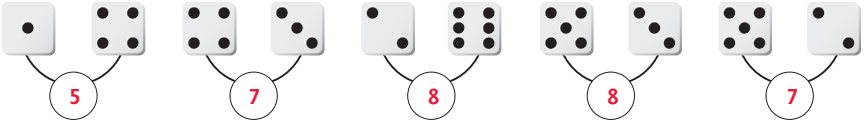

1 **kico bo por cumpra?**
marca un cruz.

X

	X		X	X		
	X		X	X		

2 **kico bo por cumpra?**
marca un cruz.

X

	X	X	X	X		
	X	X	X	X	X	X
	X	X	X	X	X	X
	X	X	X	X		X

3

con bo ta paga?
scrap e monedanan.

5 florin	
5 florin	
6 florin	
6 florin	
7 florin	
8 florin	

4

cuanto placa bo ta haya bek?



bo mester paga.	bo ta duna.	con bo ta rek? pinta y scrap.	bo ta haya bek.
6 florin			4 florin
9 florin			1 florin

1 **con yen nan ta?**
pinta strepi.
yena e hokinan.

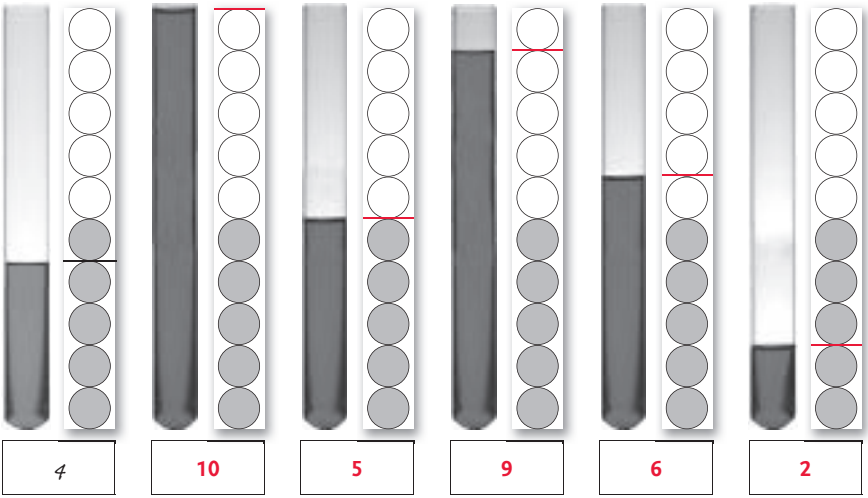

2 **con largo nan ta?**



3

yena e oranan.
riba cua oloshi ta 1 ora mas laat?
marca un cruz.

☐ 1 or

☒ 2 or

☒ 5 or

☐ 4 or

☒ 9 or

☐ 8 or

☐ 11 or

☒ 12 or

4

yena e oranan.
riba cua oloshi ta 1 ora mas tempran?
marca un cruz.

☒ 2 or

☐ 3 or

☐ 5 or

☒ 4 or

☒ 6 or

☐ 7 or

☐ 11 or

☒ 10 or

1 **kico bo por cumpra?**
marca un cruz.



	f3	f4	f6	f7	f5	f8
	X	X			X	
	X	X	X	X	X	X
	X	X	X	X	X	
	X	X	X		X	

2 **cuanto placa bo ta haya bek?**

bo mester paga.	bo ta duna.	con bo ta rek? pinta y scrap.	bo ta haya bek.
8 florin			2 florin
7 florin			3 florin
10 florin			0 florin

3 **pinta 8 florin na dos manera.**

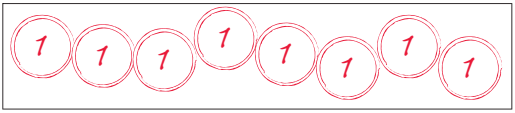

4 **con yen nan ta?**
yena e hokinan.



6 8 4 7 10

5 **midi tur e bandanan.**
yena e hokinan.

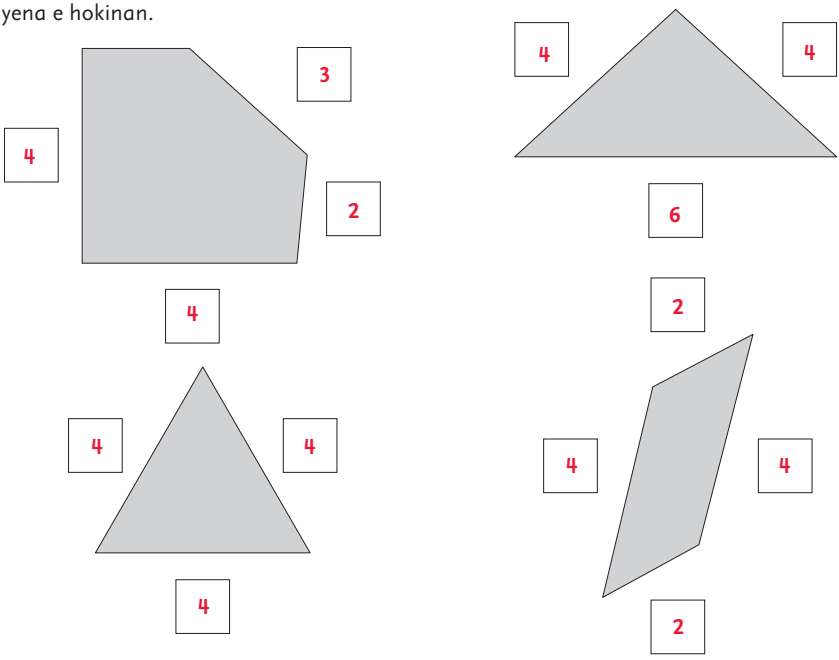

1

haci mescos cu tica.
cuanto ficha tin riba e mesa?

3

2

4

4

2

uza spiel.
pinta y kleur.







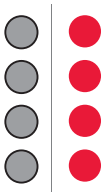

3

uza spiel y pinta.

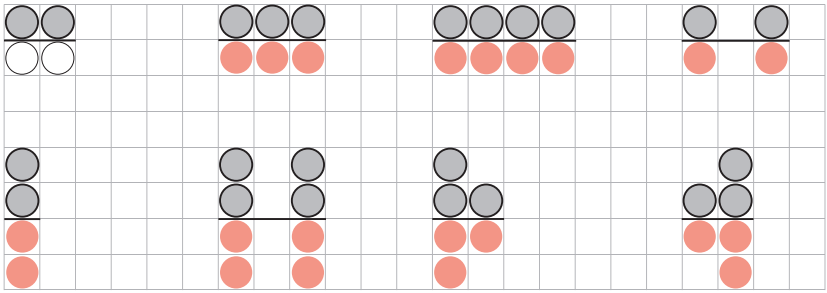

4

uza spiel y skirbi.

5

split 7.
cuanto tin bou di e pechi?
yena e numbernan.



7	3	4
7	2	5
7	5	2
7	4	3

6

split 10.
pinta e blokinan y yena e numbernan.

10	4 / 6	10	2 / 8
10	1 / 9	10	3 / 7
10	5 / 5	10	6 / 4

7

na unda e pion ta yega?
yena e number.

	5								10
							8		
							8		
								9	
									10
						7			
					6				

1 **cuanto pisca tin?**
conta e piscanan.
kleur e ronchinan cu falta.

	11	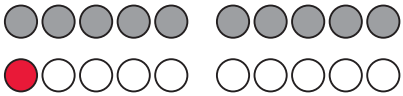
	12	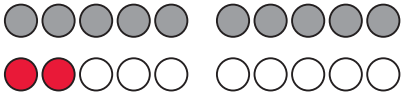
	13	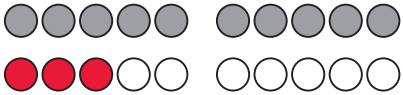
	14	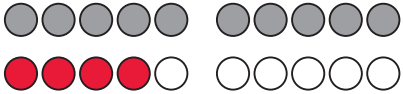
	15	
	16	
	17	
	18	
	19	
	20	

2

cuanto tin?
marca un cruz.

11	12	13	14	15
	X			

11	12	13	14	15
			X	



11	12	13	14	15
		X		

3

cuanto tin?
marca un cruz.

11	12	13	14	15	16	17	18	19	20
					X				

11	12	13	14	15	16	17	18	19	20
								X	

11	12	13	14	15	16	17	18	19	20
							X		

11	12	13	14	15	16	17	18	19	20
							X		

1

uza spiel.
pinta y kleur.

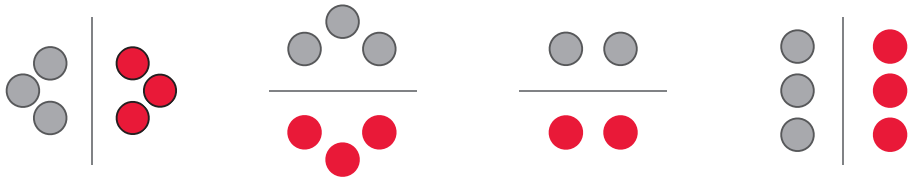

2

uza spiel.
pinta y kleur.



3

uza spiel y pinta.



4

cuanto tin?
marca un cruz.

11	12	13	14	15	16	17	18	19	20
									X

11	12	13	14	15	16	17	18	19	20
							X		

5

split 8.
pinta e blokinan y yena e numbernan.

8		8	4 / 4
8		8	1 / 7
8		8	5 / 3
8		8	2 / 6
8		8	3 / 5
8		8	7 / 1

6

na unda e pion ta yega?
yena e number.

					5			8		10
					5	6				10
					5					10 10
					5				9	10
					5					10 10
					5	6				10
					5		7			10

7

cuant'or tin?
yena e ora.

2 or	8 or	10 or	5 or	9 or

1

con bo ta conta?
conecta e numbernan den e secuencia corecto.

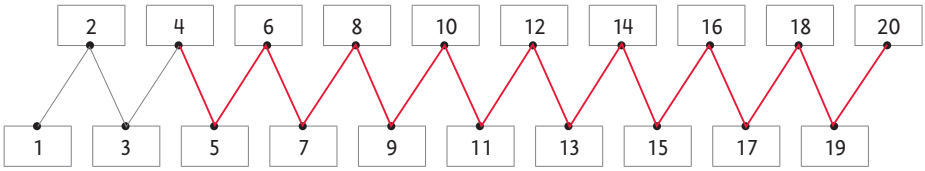

2

marca e number cu no ta pas.

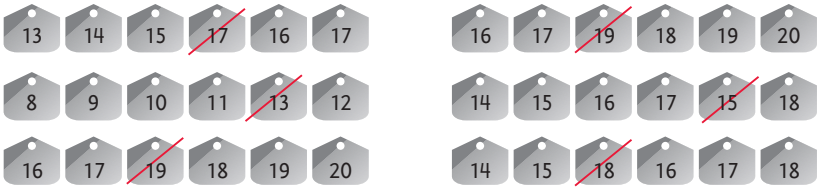

3

yena e numbernan cu falta.

7	8	9	10	11
12	13	14	15	16
16	17	18	19	20
10	11	12	13	14
13	14	15	16	17
16	17	18	19	20
11	12	13	14	15

4

conta.
marca e number cu ta pas.

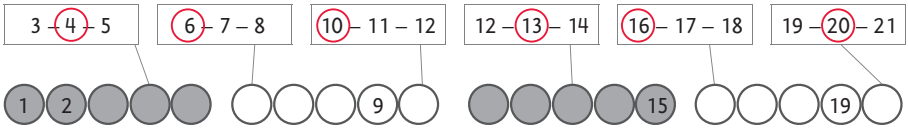

5

conta bay bek.
conecta cu otro.

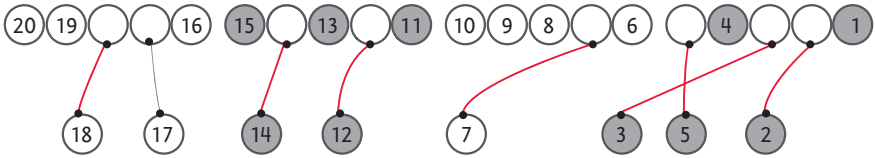

6

conta bay bek.
na unda e pion ta yega?



7

yena e numbernan cu falta.

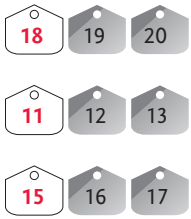

skohe: 16 [ ] 17 [ ] 18 [X]

skohe: 11 [X] 15 [ ] 14 [ ]

skohe: 18 [ ] 15 [X] 14 [ ]

1

cuanto ronchi tin?
conecta cu otro.

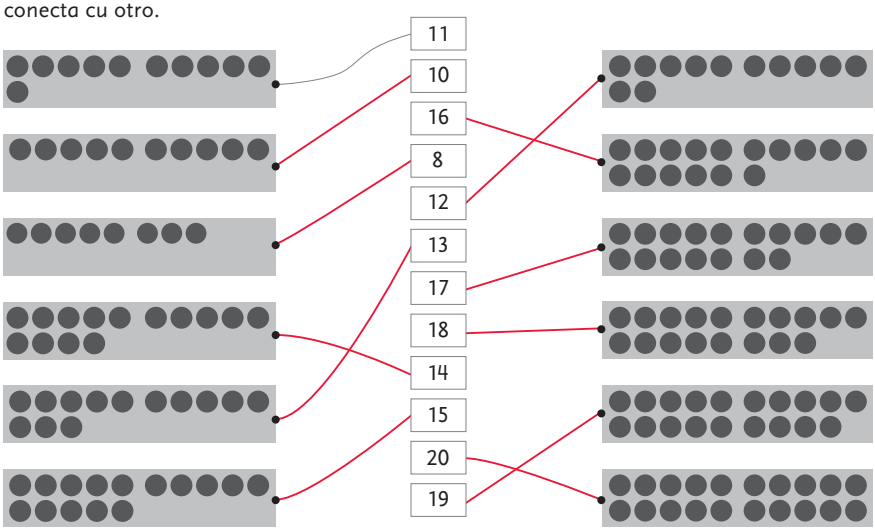

2

cuanto kiniki tin?
conecta cu otro.

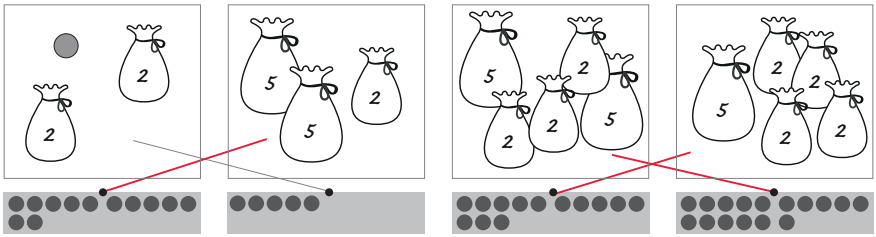

3

cuanto kiniki tin?
conecta cu otro.

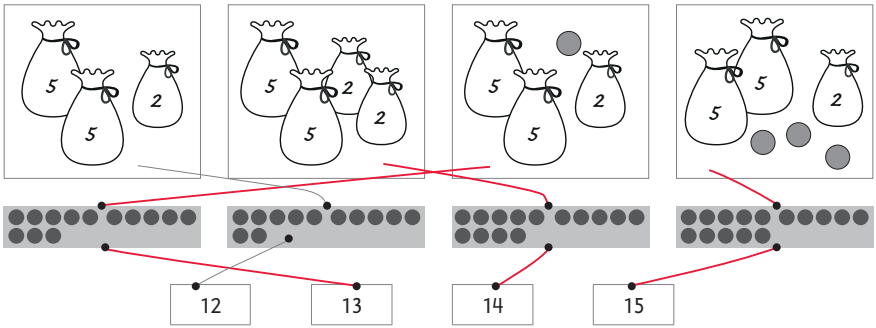

4

cuanto wowo tin hunto?
conecta cu otro.

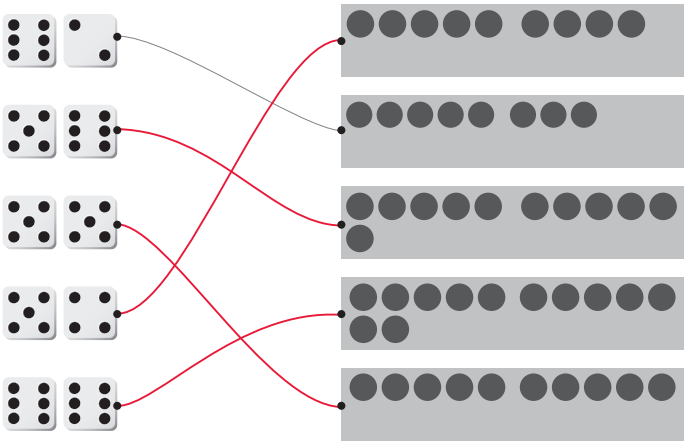

5

yena e numbernan.



6

completa e rijnan.

1

con bo ta conta?
conecta e numbernan den e secuencia corecto.

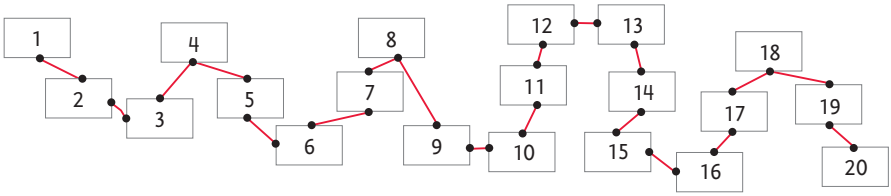

2

conta.
marca e number cu ta pas.

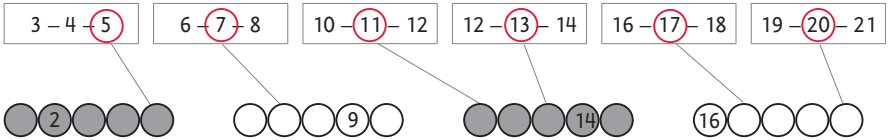

3

cuanto kiniki tin?
conecta cu otro.

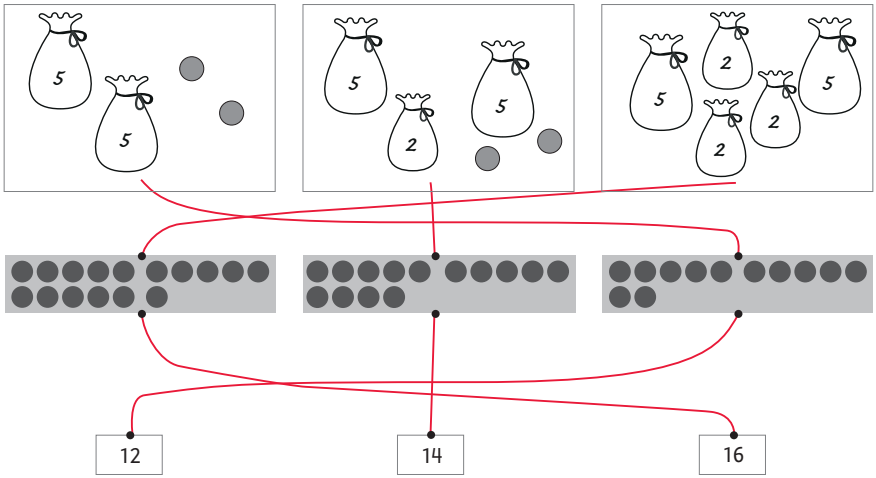

4

conta.
conecta cu otro.

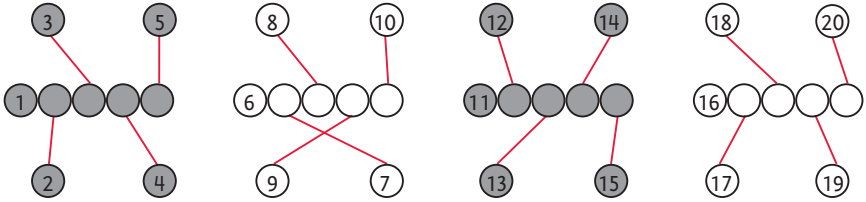

5

na unda e pion ta yega?
yena e number.

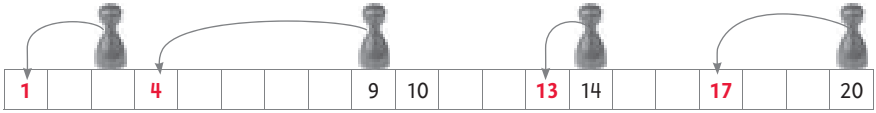

6

cuanto wowo tin hunto?
marca un ronchi.

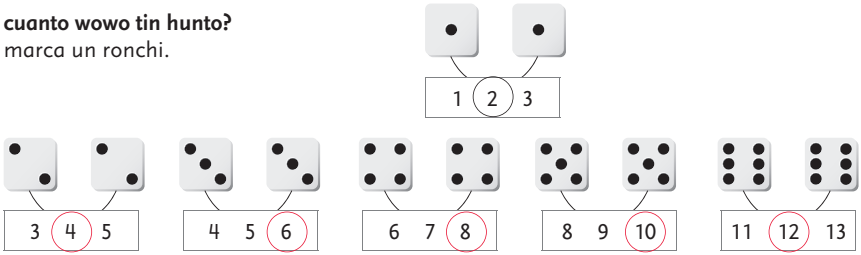

7

cuanto wowo tin hunto?
skirbi e number.

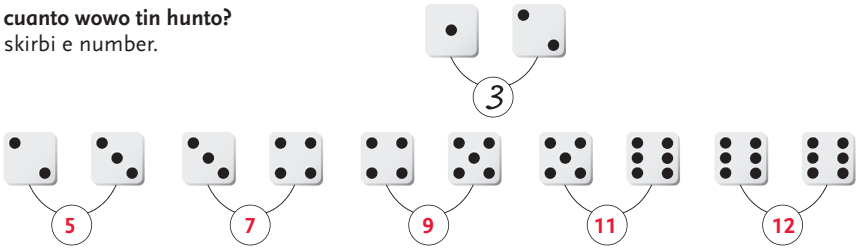

1

unda tin 10 florin?
marca un cruz.



2

cuanto placa tin?
unda tin mas placa?
kleur e hoki.

11 florin | 9 florin | 10 florin | 10 florin

3

unda tin 15 florin?
marca un cruz.



4

unda tin 13 florin?
marca un cruz.

☐		X	
☐		X	
X		☐	

5

split 9 florin.
pinta e monedanan y yena e numbernan.

9 < 1 1 1 1 / 1 1 1 1 1	9 < 4 / 5	9 < 1 1 / 1 1 1 1 1 1 1	9 < 2 / 7
9 < 1 / 1 1 1 1 1 1 1 1 1	9 < 1 / 8	9 < 1 1 1 / 1 1 1 1 1 1	9 < 3 / 6
9 < 1 1 1 1 1 / 1 1 1 1	9 < 5 / 4	9 < 1 1 1 1 1 1 1 1 1 / 1	9 < 8 / 1

6

cuanto placa tin hunto?
marca un ronchi.

(2) 3 4 florin

5 (6) 7 florin

10 11 (12) florin

7 (8) 9 florin

1 **cada biaha mas cerca.**
cua plachi no ta na su luga?
marca un cruz.



☐ ☐ ☒ ☐ ☐ ☐

2 **cua ta mas cerca?**
marca un cruz.

☐ ☒ ☐ ☒

☐ ☒ ☐ ☒

3 **di cortico bay largo.**
marca 2 potlood cu no ta pas.



☐ ☐ ☐ ☒ ☐ ☐ ☒ ☐

4 cua di nan ta mas halto?

marca un cruz.

X



X

X

X

5 completa e rijnan.

1	2	3	4
4	5	6	7
7	8	9	10

11	12	13	14
14	15	16	17
17	18	19	20

6 cuant'or tin?

yena e ora.

3 or

1 or

4 or

6 or

11 or

1

unda tin 11 florin?
marca un cruz.

[X]

[ ]

[X]

[ ]

[ ]

[X]

2

cuanto placa tin hunto?
marca un ronchi.

9 10 11 florin

16 17 18 florin

16 17 18 florin

12 13 14 florin

3

kleur.

11 florin

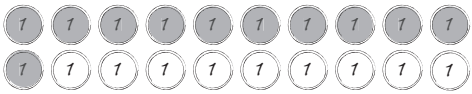

13 florin

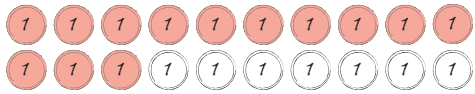

14 florin

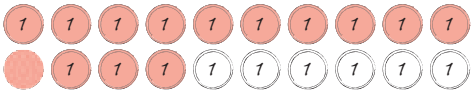

4 **pinta e man chikito.**

3 or	5 or	9 or	10 or	2 or

5 **yena e oranan.**
riba cua oloshi ta 1 ora mas laat?
marca un cruz.

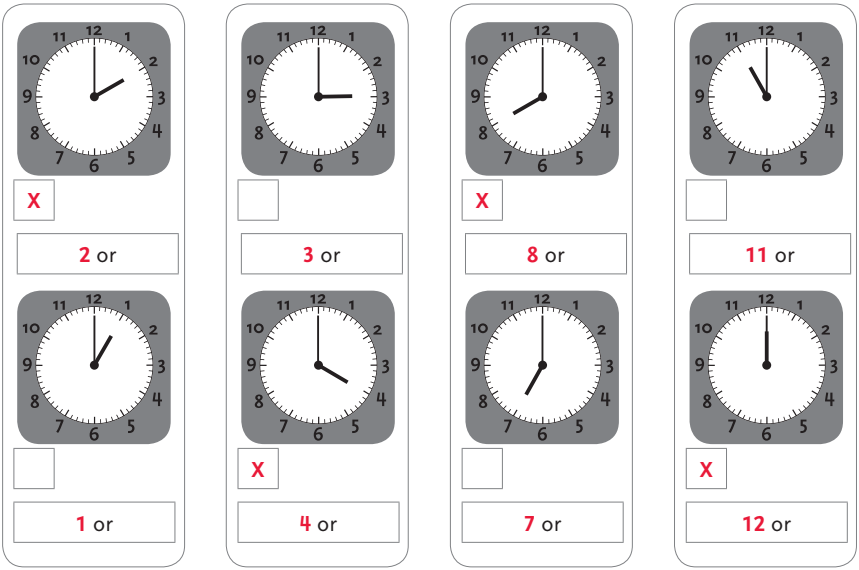

6 **pensa pa bo mes.**
pinta y skirbi. **mas cu 1 contesta.**

or	or	or	or	or

1

split.
conecta cu otro.

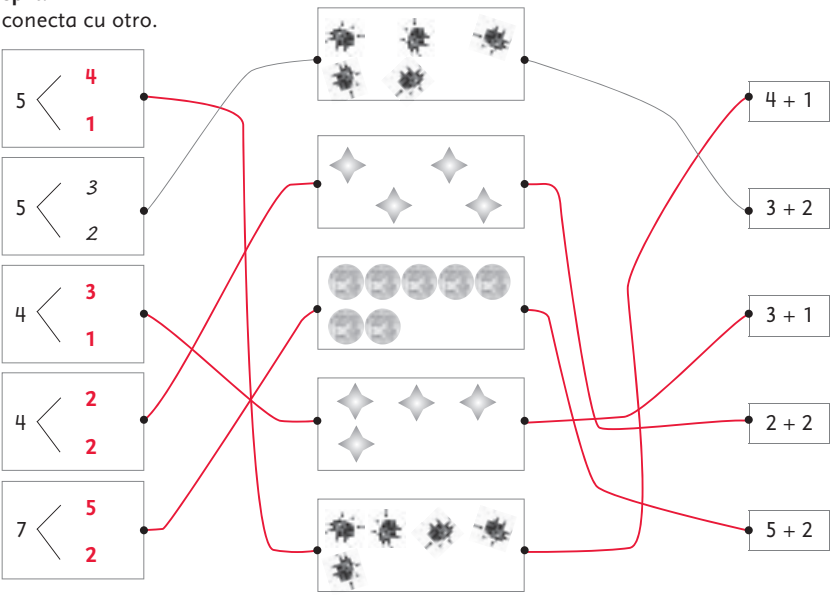

2

split 10.
yena e numbernan.

1	9
2	8
3	7
4	6
5	5

1 + 9
2 + 8
3 + 7
4 + 6
5 + 5

6	4
7	3
8	2
9	1
10	

6 + 4
7 + 3
8 + 2
9 + 1
10 + 0

3 **hotel di split.**
kleur e ronchinan.

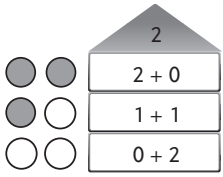

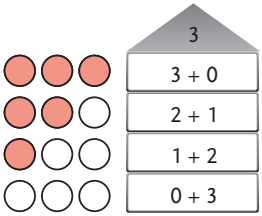

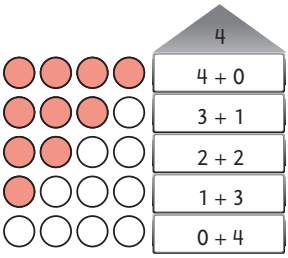

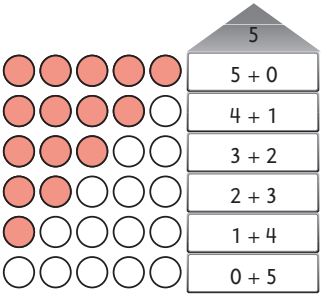

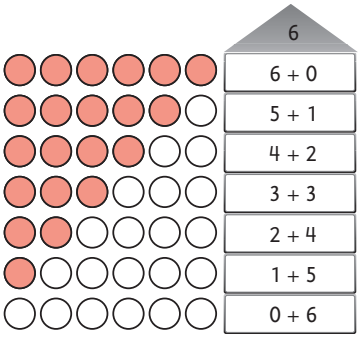

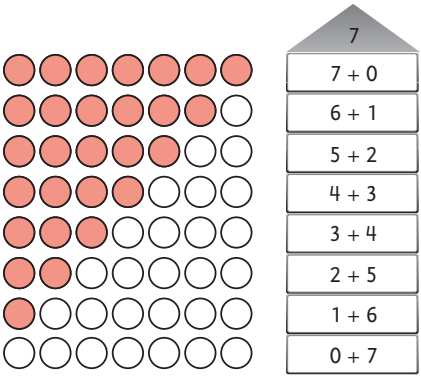

4 **pinta e wowonan.**

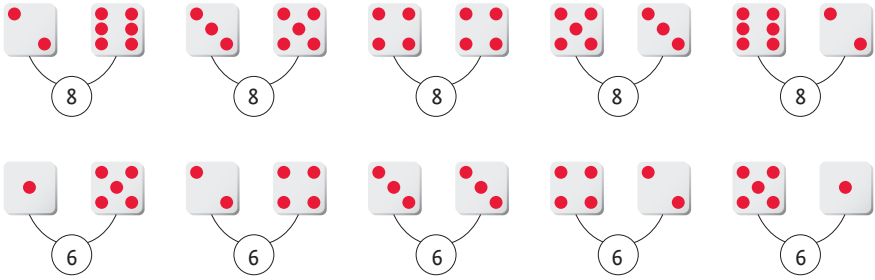

1 **10 florin of 20 florin?**
conecta cu otro.

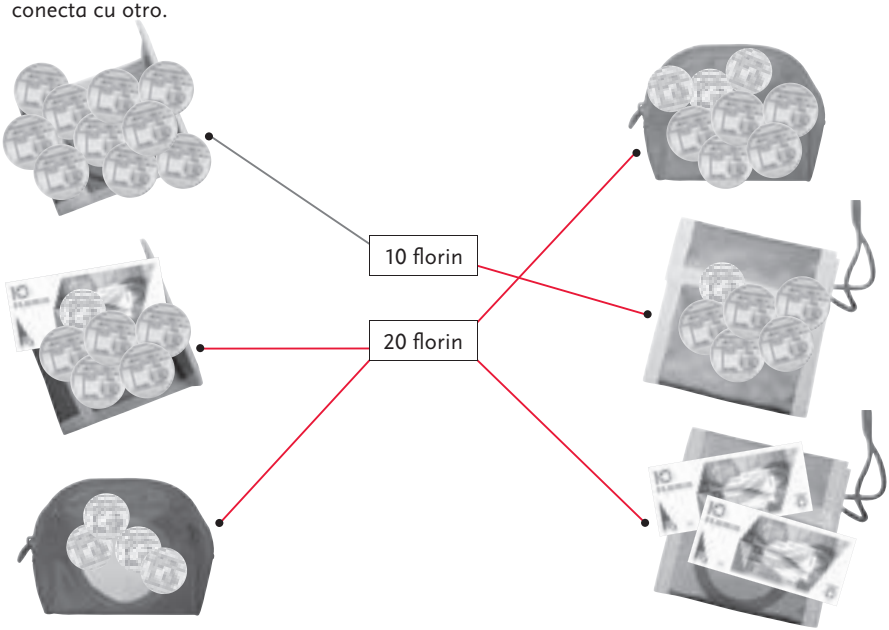

2 **con bo ta paga?**
conecta cu otro.

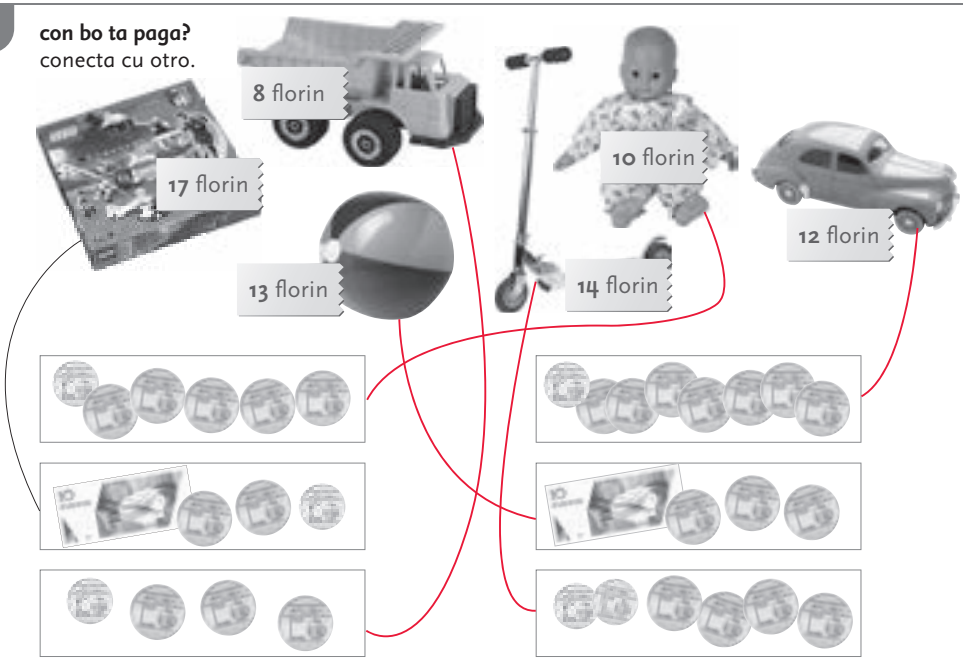

3 **unda tin 10 florin?**
marca un cruz.

☐	☐
X	X
☐	☐

4 **unda tin 20 florin?**
marca un cruz.

☐	X
X	X
☐	X

5 **bo tin 11 florin.**
kico bo por cumpra?
marca un cruz.

8 florin

X si
☐ no

7 florin

X si
☐ no

8 florin

X si
☐ no

18 florin

☐ si
X no

1

split 8.
yena e numbernan.

1	7	1 + 7
2	6	2 + 6
3	5	3 + 5
4	4	4 + 4

5	3	5 + 3
6	2	6 + 2
7	1	7 + 1
8		8 + 0

2

hotel di split. mas cu 1 contesta.
kleur e ronchinan.



10

- 10 + 0
- 9 + 1
- 8 + 2
- 7 + 3
- 6 + 4
- 5 + 5
- 4 + 6
- 3 + 7
- 2 + 8
- 1 + 9
- 0 + 10

3

conta e placa.

18 florin

20 florin

15 florin

14 florin

4

cua di nan ta mas caro?
marca un cruz.

9 florin — X
7 florin — ☐

4 florin — ☐
12 florin — X

12 florin — X
9 florin — ☐

7 florin — X
4 florin — ☐

5

cuant'or tin?
yena e ora.

6 or

9 or

3 or

12 or

1 or

11 or

5 or

7 or

10 or

4 or

1

cuanto baca bo ta mira?
pinta ronchi.
conecta cu otro.

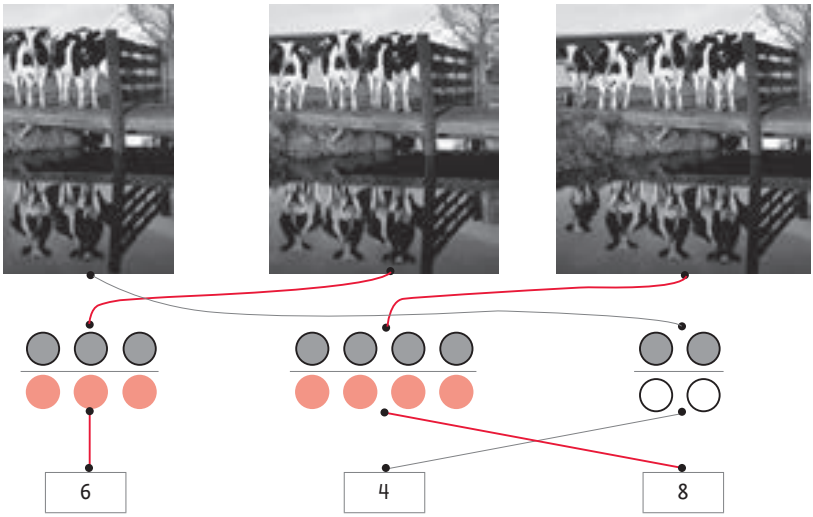

2

uza spiel.
cuanto ronchi bo ta mira?
pinta nan y yena e number.

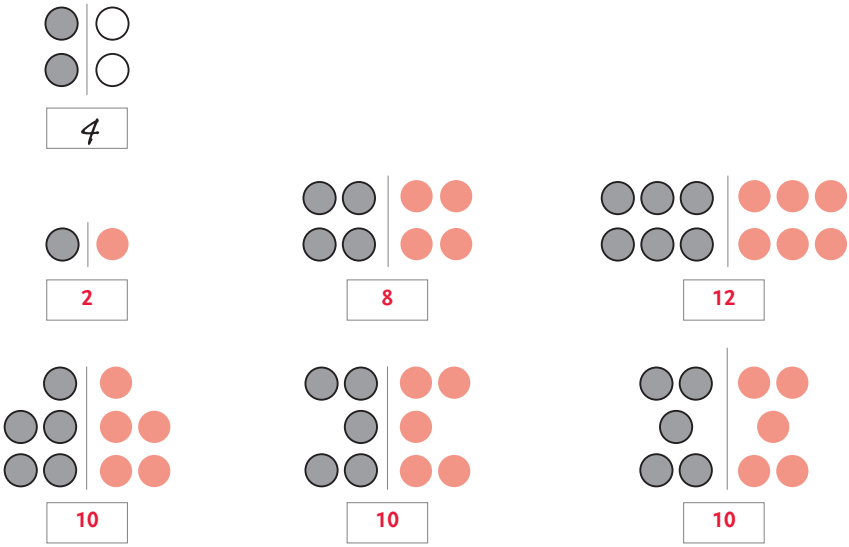

3

cuanto ronchi tin?
yena e numbernan.

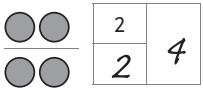

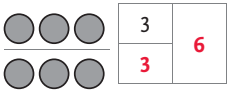

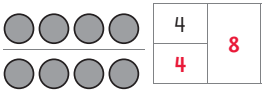

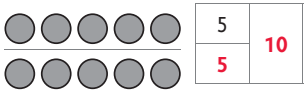

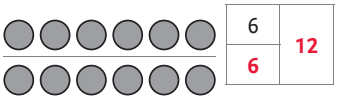

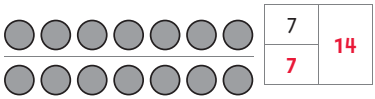

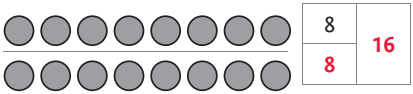

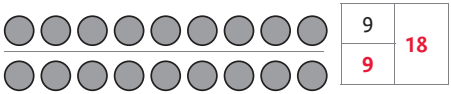

4

split 7.
cuanto tin bou di e pechi?

7 — 1 / 6

7 — 3 / 4

7 — 4 / 3

7 — 5 / 2

5

split 9.
cuanto tin bou di e pechi?



9 — 2 / 7

9 — 6 / 3

9 — 4 / 5

9 — 5 / 4

1 **con largo nan ta?**
pinta strepi y yena number.

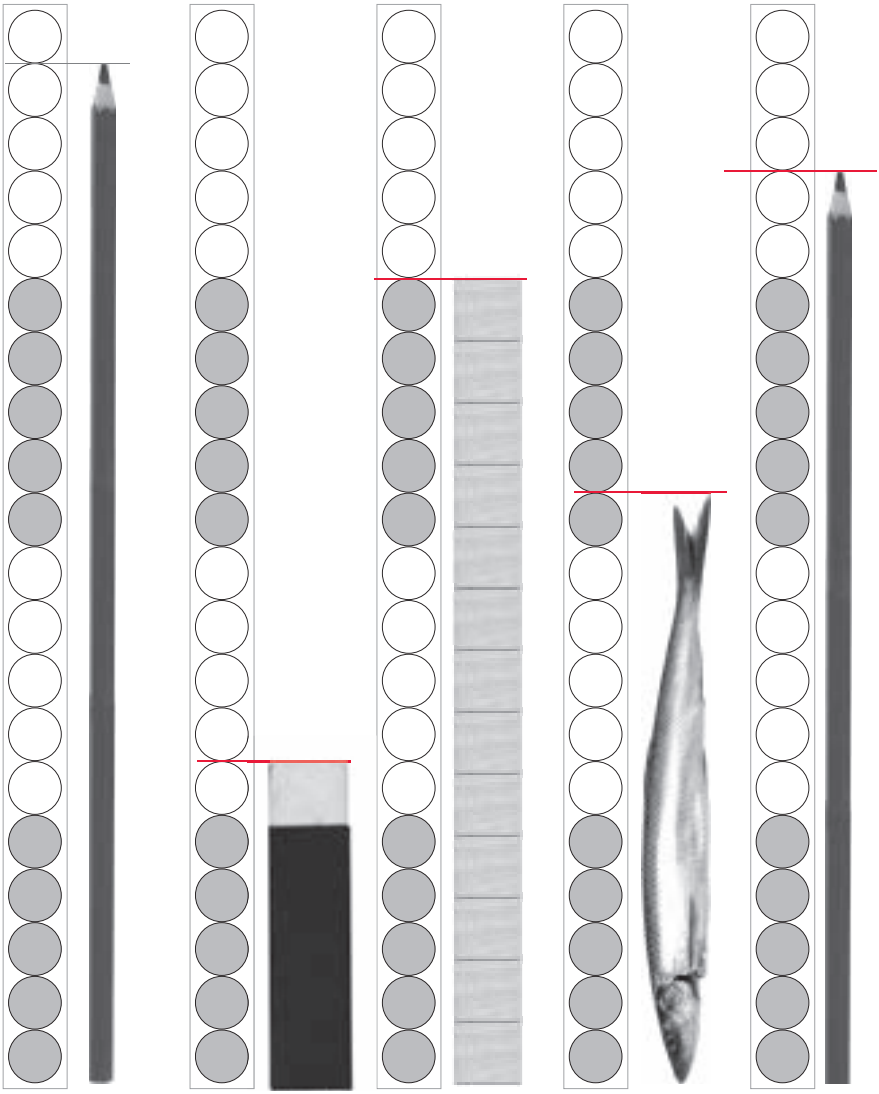

19 | 6 | 15 | 11 | 17

2

kico ta mas grandi?
marca un cruz.

bo cabes of bo man?

[X] [ ]

bo brasa of bo pia?

[ ] [X]

bo buki of bo pen?

[X] [ ]

3

conta.
conecta cu otro.

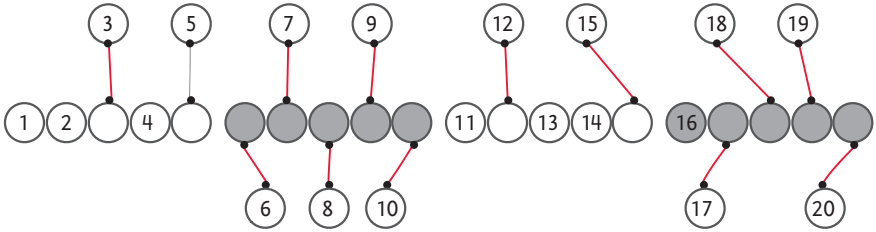

4

conta cu salto.
yena e numbernan prome.
despues kleur 2, 4, 6, 8, 10, 12, 14, 16, 18 y 20.

1	2	3	4	5	6	7	8	9	10
11	12	13	14	15	16	17	18	19	20

5

conta cu salto.
yena e numbernan prome.
despues kleur 1, 3, 5, 7, 9, 11, 13, 15, 17 y 19.

1	2	3	4	5	6	7	8	9	10
11	12	13	14	15	16	17	18	19	20

1

uza spiel.
cuanto ronchi bo ta mira?
pinta nan y yena e number.



4 8 10 6

2

mes hopi.
pinta e ronchinan y yena e numbernan.

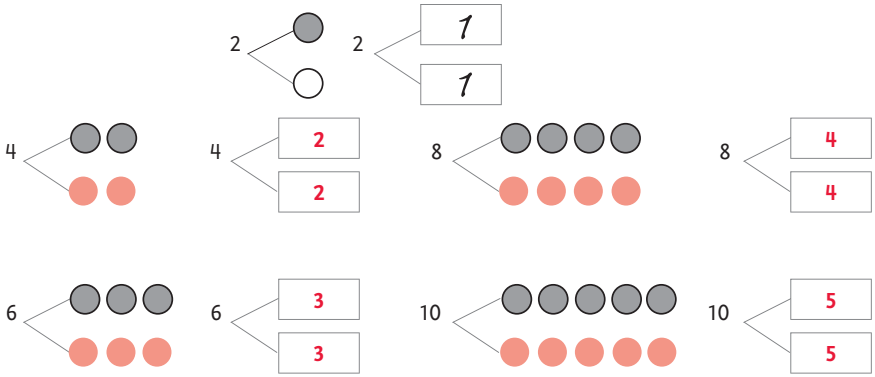

3

con largo nan ta?
yena e numbernan.

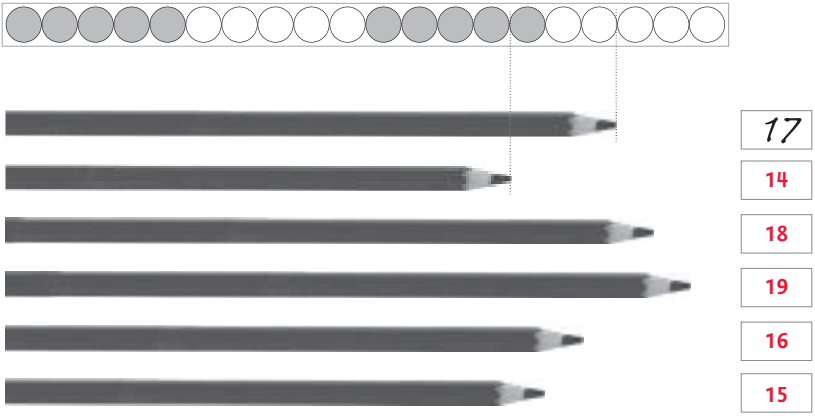

4 **conta.**
conecta cu otro.

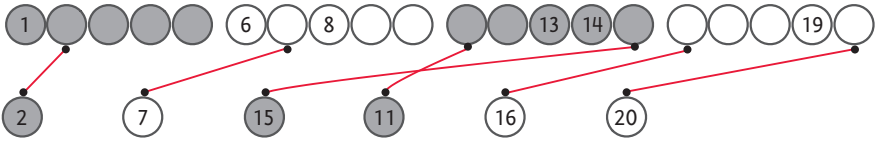

5 **na unda e pion ta yega?**
pinta e flechanan y yena e numbernan.

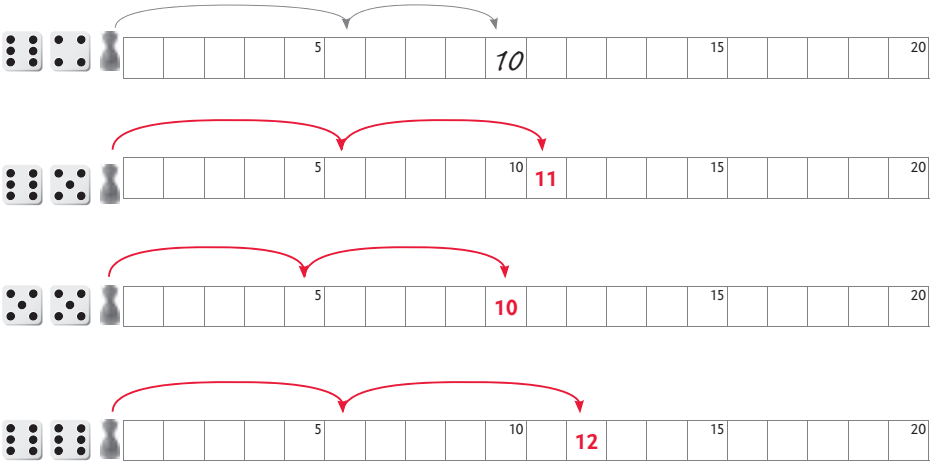

6 **marca e numbernan cu no ta pas.**

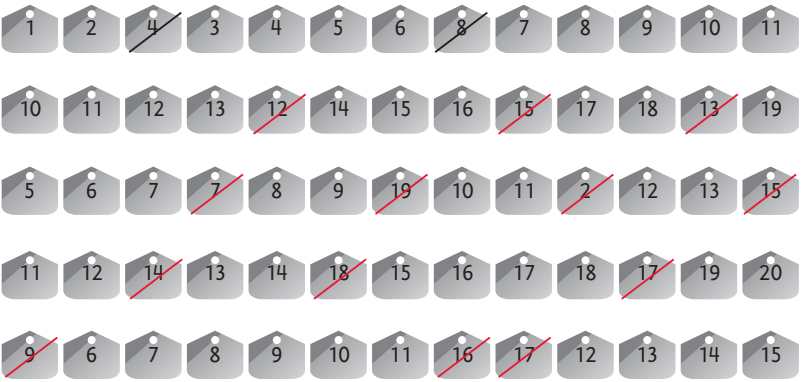

1 cuanto cralchi a pone riba e reki?

4

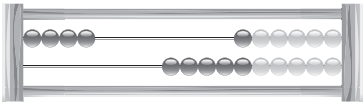

2



3

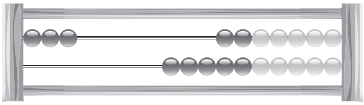

10



5



8



7



6

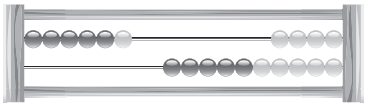

2 cuanto cralchi a pone riba e reki?

11



15



12



17



14

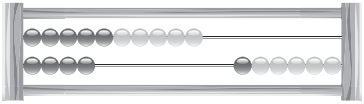

19



16

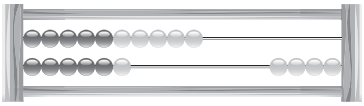

20



3 completa e rijnan.

1 **2** 3 **4** 5 **6** 7 **8** 9 **10**

11 **12** 13 **14** 15 **16** 17 **18** 19 **20**

1 2 **3** 4 **5** 6 **7** 8 **9** 10

11 12 **13** 14 **15** 16 **17** 18 **19** 20

4 un ora mas laat.

pinta e man chikito y yena e ora.

2 or	**8** or	**10** or	**5** or	**9** or
un ora mas laat	un ora mas laat	un ora mas laat	un ora mas laat	un ora mas laat
3 or	**9** or	**11** or	**6** or	**10** or

5 cuant'or tin?

10 or	**2** or	**8** or	**4** or	**3** or

1

cuanto cralchi a pone riba e reki?
conecta cu otro.

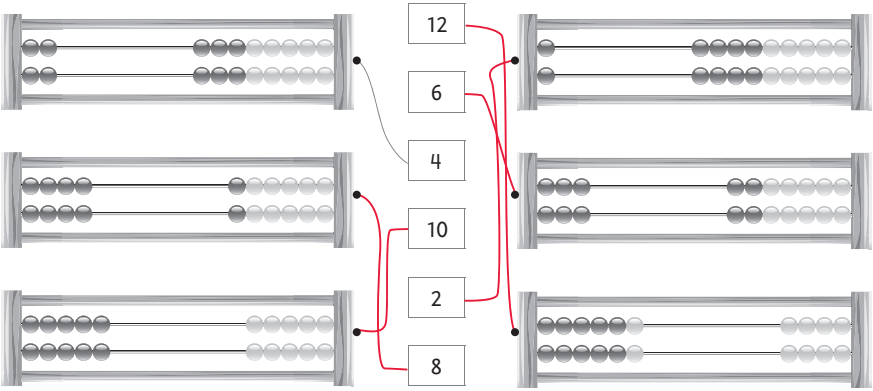

2

cuanto chuculati tin hunto?

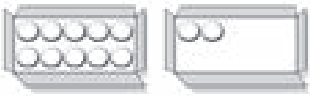

10 y 2 hunto ta 12

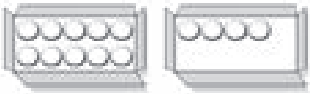

10 y 4 hunto ta 14

9 y 9 hunto ta 18



10 y 6 hunto ta 16

10 y 10 hunto ta 20

3

pinta den forma di dobel.

4



6



2



8



4

casi dobel.
cuanto cralchi a pone riba e reki?

7



13



11

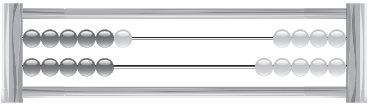

17



5

tin 2 reki cu ta pas cu e number.
conecta nan.





11

12

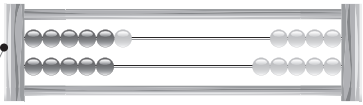



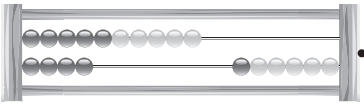



13

14





1 **tin 2 reki cu ta pas cu e number.**
conecta nan.

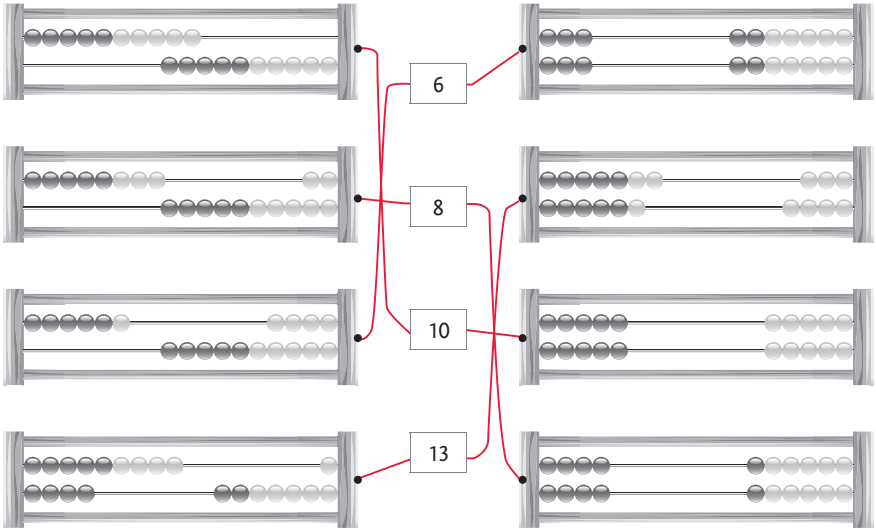

2 **dobel.**
conecta cu otro.

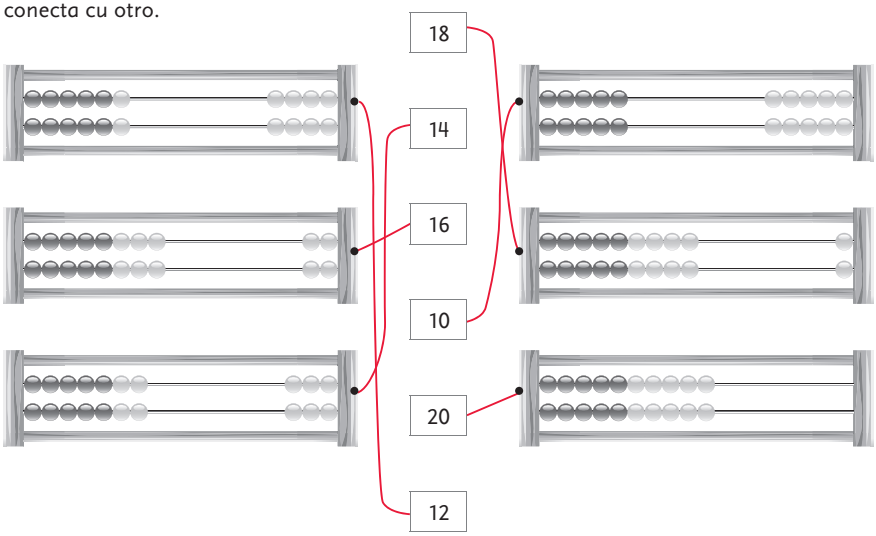

3

casi dobel.
cuanto cralchi a pone?


9


5

11

19

4

cuanto tin hunto?

7

7


7

6


6

3

5

7

9

11

5

split 10.

1	9
2	8
3	7
4	6
5	5

6	4
7	3
8	2
9	1
10	

1 dobel y casi dobel.

4 + 4 = som cu dobel.

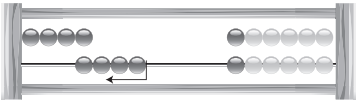

4 + 3 = som cu casi dobel.

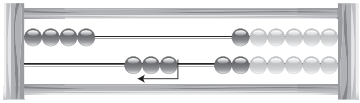

kleur e somnan cu dobel cora.
kleur e somnan cu casi dobel geel.

1 + 1 = 2	3 + 4 = 7	6 + 6 = 12	2 + 8 = 10
1 + 2 = 3	4 + 4 = 8	7 + 6 = 13	9 + 8 = 17
2 + 2 = 4	4 + 5 = 9	1 + 8 = 9	9 + 9 = 18
2 + 3 = 5	5 + 5 = 10	7 + 7 = 14	9 + 1 = 10
3 + 3 = 6	2 + 5 = 7	8 + 7 = 15	10 + 9 = 19
1 + 3 = 4	6 + 5 = 11	8 + 8 = 16	10 + 10 = 20

2 cua som ta pas?

yena e numbernan.

5 4

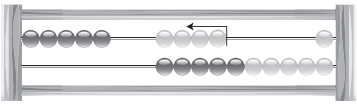

5

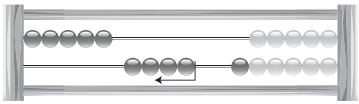

4

5	+	4	=	9	

3 6

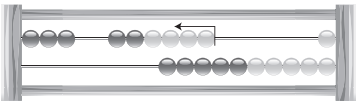

3

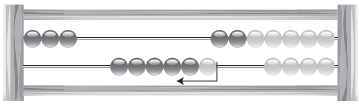

6

3	+	6	=	9	

6 4

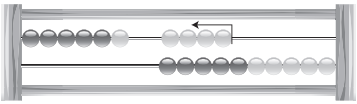

6

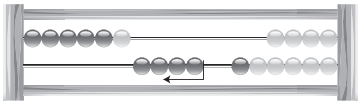

4

6	+	4	=	1	0

3

8 riba e reki.
yena e numbernan.



8 — 4 | 4

4 + 4 = 8



8 — 7 | 1

7 + 1 = 8



8 — 5 | 3

5 + 3 = 8

4

9 riba e reki.
yena e numbernan.



9 — 5 | 4

5 + 4 = 9

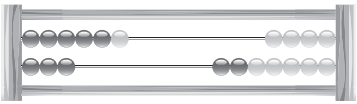

9 — 6 | 3

6 + 3 = 9

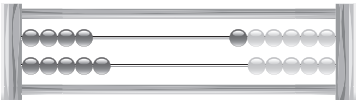

9 — 4 | 5

4 + 5 = 9

5

cuant'or tin?
yena e ora.

2 or

5 or

3 or

10 or

8 or

1

cuant'or tin?
conecta cu otro.

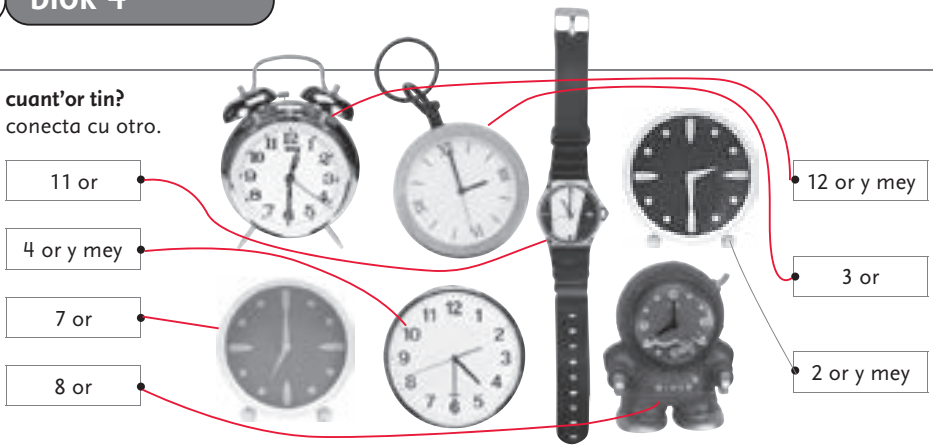

2

cuant'or tin?
riba cua oloshi ta mey ora mas laat?
conecta cu otro.

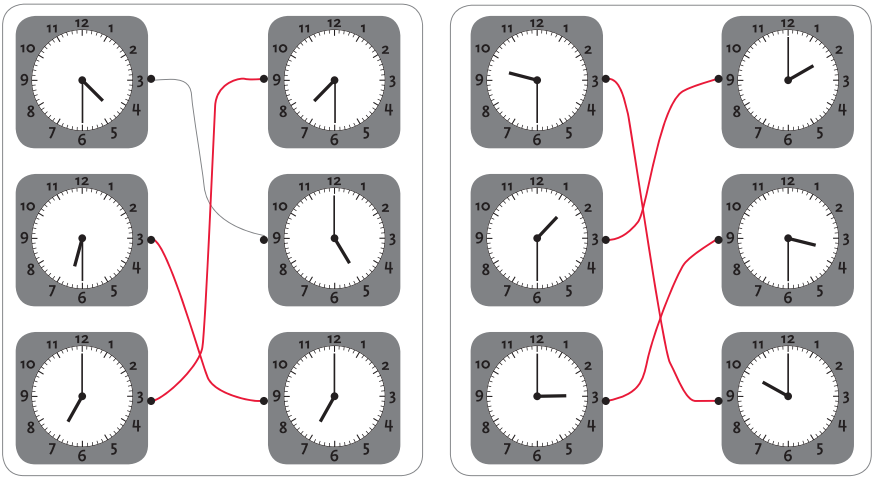

3

cuant'or tin?
conecta cu otro.

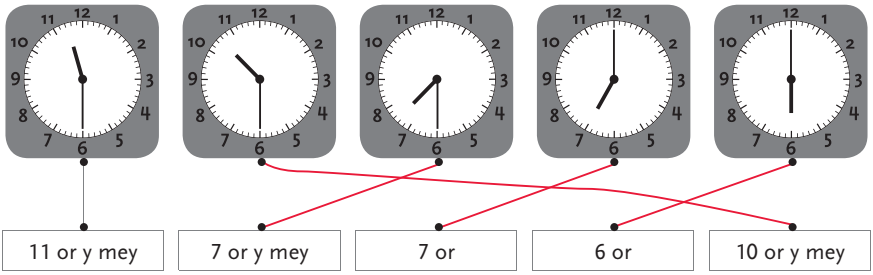

4

split 10. **mas cu 1 contesta.**
abo mes pinta un strepi.
yena e numbernan.

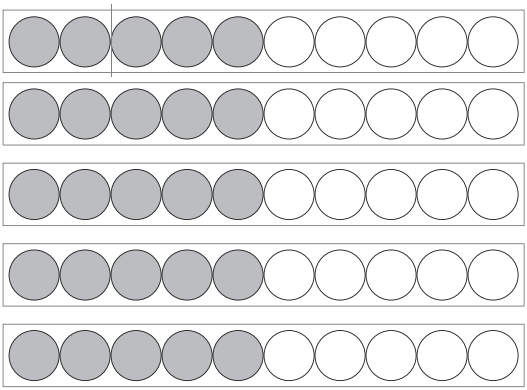

2	y	8
	y	
	y	
	y	
	y	

5

cuanto cralchi a pone?

11



13

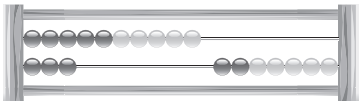

17

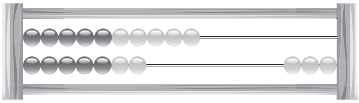

19



6

traha som.

1	+	2	=	3	
2	+	3	=	5	
3	+	4	=	7	
4	+	5	=	9	

2	+	2	=		4
3	+	3	=		6
4	+	4	=		8
5	+	5	=	1	0

2	+	1	=	3	
3	+	2	=	5	
4	+	3	=	7	
5	+	4	=	9	

6	+	4	=	1	0
3	+	7	=	1	0
8	+	2	=	1	0
1	+	9	=	1	0

1

cua som ta pas?
yena e numbernan.

6 4

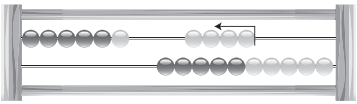

6

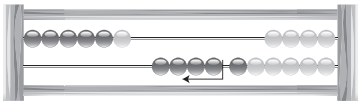

4

6 + 4 = 1 0

2 6

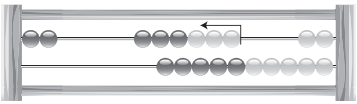

2

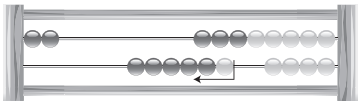

6

2 + 6 = 8

4 5

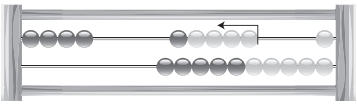

4

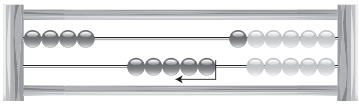

5

4 + 5 = 9

7 2

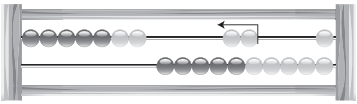

7

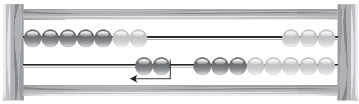

2

7 + 2 = 9

2

cuant'or tin?
conecta cu otro.

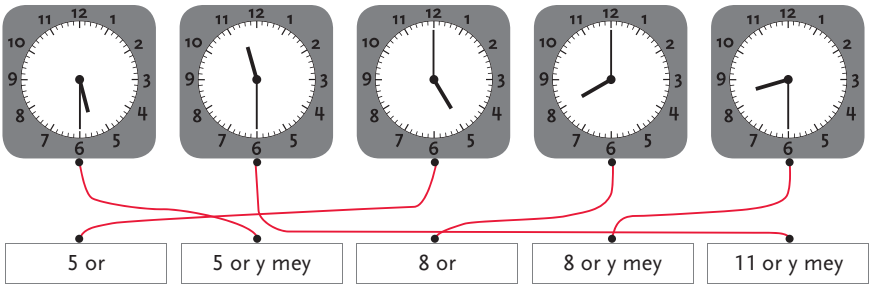

3 **cua di nan ta mes hopi?**
duna e hokinan e mesun colo.



4 **menos y mas.**

pinta 1 menos. pinta 2 mas.

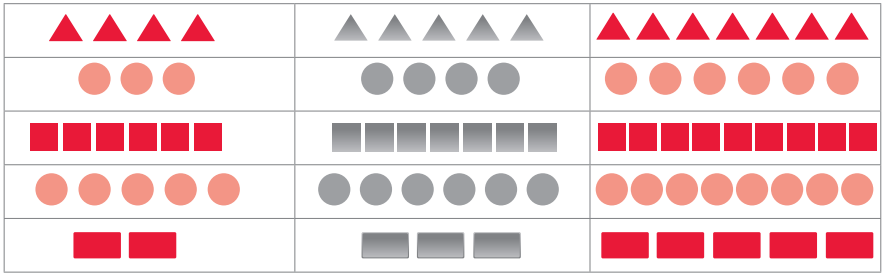

5 **sigui conta.**

6 **conta bay bek.**

1

cua som ta pas?
conecta cu e plachi.



3 + 2 + 5 = 10

3 + 5 = 8

10 = 6 + ?

2

cua som ta pas?
yena e numbernan.

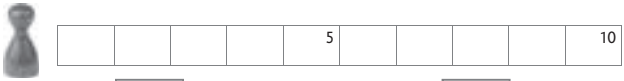

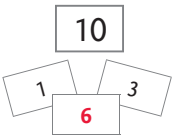

			1	+	3	=		4	
			4	+	6	=	1	0	
	1	0	=	6	+	1	+	3	

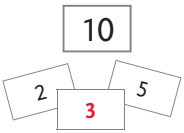

			2	+	5	=		7	
			7	+	3	=	1	0	
	1	0	=	5	+	2	+	3	

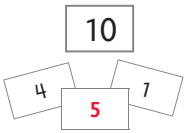

			4	+	1	=		5	
			5	+	5	=	1	0	
	1	0	=	5	+	4	+	1	

3

abo mes pensa som.
yena e numbernan. **mas cu 1 contesta.**

... 2

			2	+		=			
				=	2	+			

3 ...

			3	+		=			
				=	3	+			

... ...

				+		=			
				+		=			
				=		+			

4 cuanto tin hunto?

9

7

7

6

6

9

5 na unda e pion ta yega?

yena e number.

5 8 10



5 6 10

5 10 10

5 9 10

5 10 10

5 6 10

6 split.

6	7	8	9
6 + 0	7 + 0	8 + 0	9 + 0
5 + 1	6 + 1	7 + 1	8 + 1
4 + 2	5 + 2	6 + 2	7 + 2
3 + 3	4 + 3	5 + 3	6 + 3
2 + 4	3 + 4	4 + 4	5 + 4
1 + 5	2 + 5	3 + 5	4 + 5
0 + 6	1 + 6	2 + 6	3 + 6
	0 + 7	1 + 7	2 + 7
		0 + 8	1 + 8
			0 + 9

1 **cuanto bo mester paga?**
cua som ta pas?



2 **con bo ta paga?**
marca cruz. **mas cu 1 contesta.**

hunto f 7			X	X	X			
hunto f 12								
hunto f 12								
hunto f 15								
hunto f 20								

3

cuanto placa tin?
conecta cu otro.

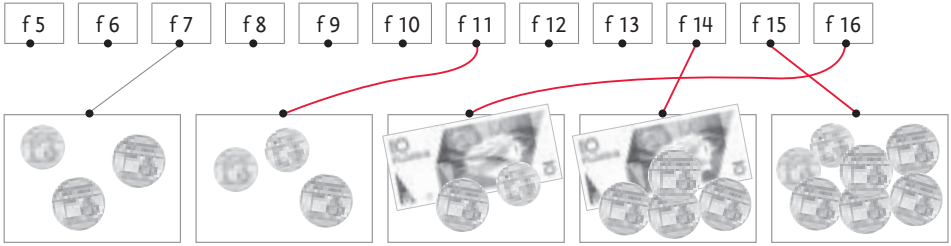

4

hunto ta 10.
pinta un dart acerca.

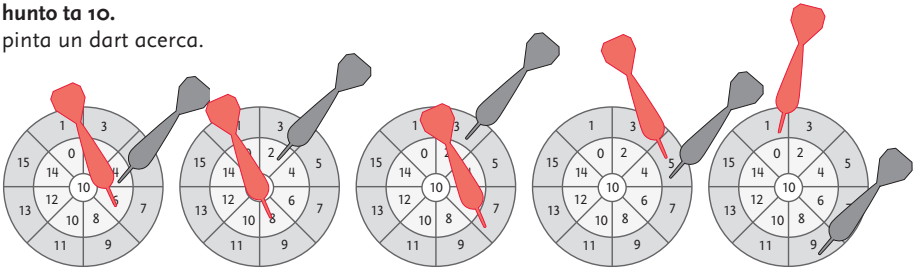

5

cuanto punto bo ta tira? mas cu 1 contesta.
abo mes pinta 2 dart.

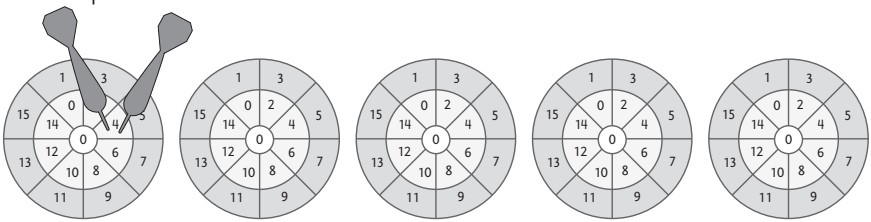

8				

6

kleur e somnan cu casi dobel.

4 + 4 = 8	2 + 5 = 7	2 + 2 = 4	9 + 9 = 18
3 + 4 = 7	5 + 4 = 9	1 + 2 = 3	6 + 5 = 11
2 + 1 = 3	5 + 5 = 10	8 + 8 = 16	9 + 8 = 17
5 + 3 = 8	4 + 3 = 7	8 + 7 = 15	3 + 8 = 11

1

cuanto tin hunto?
skirbi e som.

1 + 2 = 3

2 + 2 = 4

1 + 3 = 4

1 + 4 = 5

3 + 4 = 7

2 + 3 = 5

4 + 6 = 10

5 + 5 = 10

2

cua som bo por traha? **mas cu 1 contesta.**

1 + 2 = 3

2 + 1 = 3

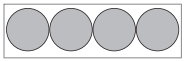

	1	+	3	=	4	
	2	+	2	=	4	
	3	+	1	=	4	
	0	+	4	=	4	

	1	+	4	=	5	
	2	+	3	=	5	
	3	+	2	=	5	
	4	+	1	=	5	

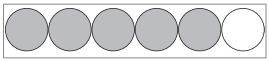

	1	+	5	=	6	
	2	+	4	=	6	
	3	+	3	=	6	
	4	+	2	=	6	

3

cuanto bo mester paga?
cua som ta pas?

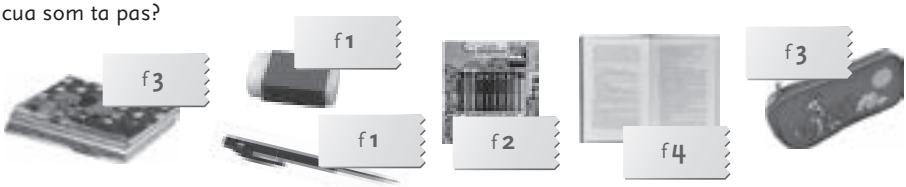



4 + 1 → 4 + 1 = 5

3 + 1 → 3 + 1 = 4

3 + 2 → 3 + 2 = 5

4 cuanto cralchi a pone?

17



15



13



14



18



18



14



13



19



17



5 split. mas cu 1 contesta.

5 — 3 / ☐

5 — ☐ / ☐

5 — ☐ / ☐

6 — ☐ / ☐

6 — ☐ / ☐

6 — ☐ / ☐

7 — ☐ / ☐

7 — ☐ / ☐

7 — ☐ / ☐

8 — ☐ / ☐

8 — ☐ / ☐

8 — ☐ / ☐

1 cuanto bo ta resta?

bo tin 10 paki.
ta kita 3.
cuanto bo ta resta?

7

10 cralchi.
scrap 3.

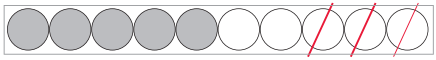

ta resta 7

pone 10, kita 3.

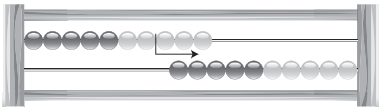

10 – 3 = 7

2 scrap.

cuanto bo ta resta?

10 cralchi, scrap 2.

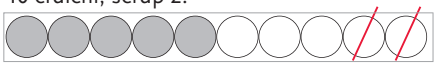

ta resta: 8

pone 10.



kita 2.

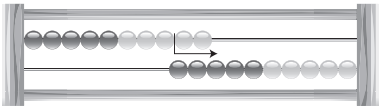

1	0	–	2	=	8

10 cralchi, scrap 4.

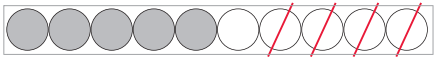

ta resta: 6

pone 10.



kita 4.

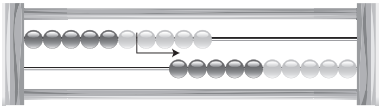

1	0	–	4	=	6

8 cralchi, scrap 3.

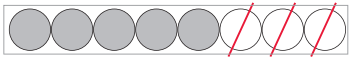

ta resta: 5

pone 8.



kita 3.

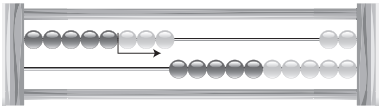

8	–	3	=	5	

3

kita y pone.
traha som.

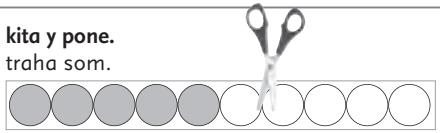

10 – 4 = 6

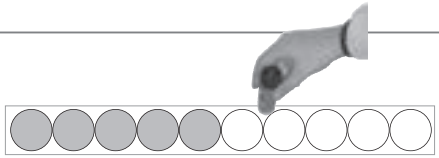

6 + 4 = 10

abo awor.

1	0	–	3	=	7	y	7	+	3	=	1	0	8	–	2	=	6		y	6	+	2	=	8	
1	0	–	2	=	8	y	8	+	2	=	1	0	7	–	2	=	5		y	5	+	2	=	7	
1	0	–	6	=	4	y	4	+	6	=	1	0	6	–	2	=	4		y	4	+	2	=	6	
1	0	–	1	=	9	y	9	+	1	=	1	0	9	–	2	=	7		y	7	+	2	=	9	

4

cuanto mas of cuanto menos?
pinta strepi y scrap e contesta fout.

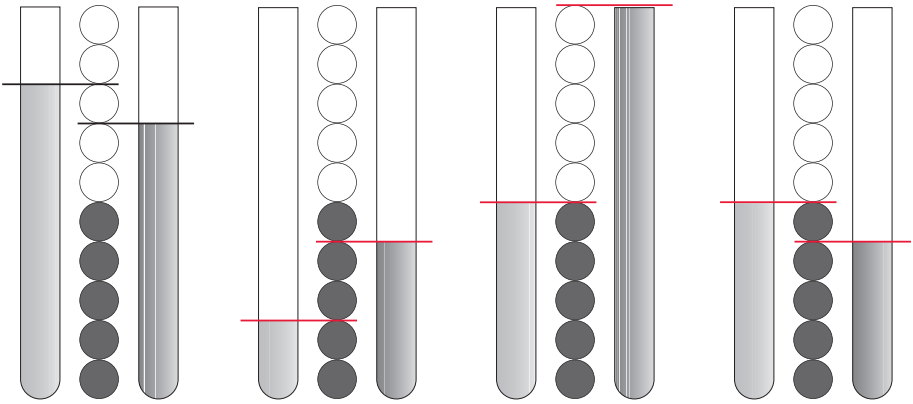

tin 1 mas/ ~~menos~~ cu

tin 2 ~~mas~~/ menos cu

tin 5 ~~mas~~/ menos cu

tin 1 mas/ ~~menos~~ cu

5

traha som.
uza bo reki.

1	+	1	=		2	5	+	5	=	1	0		9	+		9	=	1	8	6	+		7	=	1	3
2	+	2	=		4	6	+	6	=	1	2	1	0	+	1	0	=	2	0	7	+		8	=	1	5
3	+	3	=		6	7	+	7	=	1	4		4	+		5	=		9	8	+		9	=	1	7
4	+	4	=		8	8	+	8	=	1	6		5	+		6	=	1	1	9	+	1	0	=	1	9

1 cua som ta pas? mas cu 1 contesta.

ayera: 

awe: 

8	–	3	=	5

8	–	3	=	5

ayera:

awe:

9	–	5	=	4

9	–	5	=	4

2 cua som ta pas?

conecta cu otro.

5 – 3 = 2

8 – 3 = 5

10 – 6 = 4

7 – 3 = 4



4 3 7



10 aña 6 aña



3 traha som.

5	–	1	=		4
5	–	3	=		2
5	–	2	=		3

5	–	4	=		1
5	–	5	=		0
4	–	2	=		2

4	–	1	=		3
4	–	3	=		1
4	–	4	=		0

3	–	1	=		2
3	–	3	=		0
3	–	2	=		1

4 cua som ta pas?

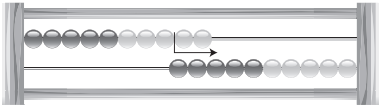

1	0	–	2	=	8

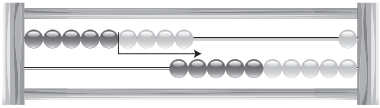

9	–	4	=	5	

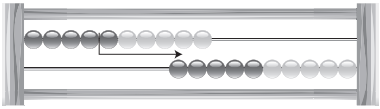

1	0	–	6	=	4

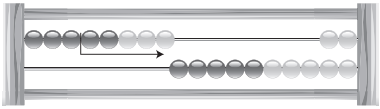

8	–	5	=	3	



5	–	3	=	2

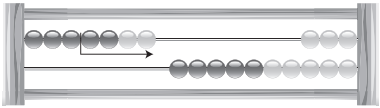

7	–	4	=	3

5 cua som ta pas?

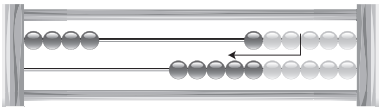

4	+	3	=	7

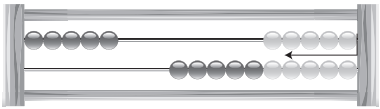

5	+	5	=	1	0



4	+	4	=	8



7	+	1	=	8



6	+	3	=	9

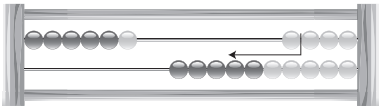

6	+	1	=	7

1

cuanto ta resta?
scrap pa rek e som.

1	0	–	2	=	8

1	0	–	3	=	7



1	0	–	6	=	4



1	0	–	8	=	2

2

cua som ta pas?

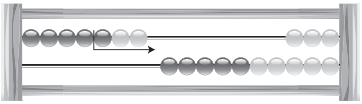

7	–	3	=	4

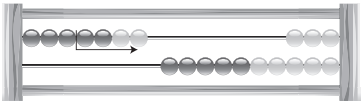

7	–	4	=	3

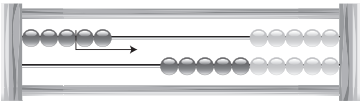

5	–	2	=	3



5	–	3	=	2

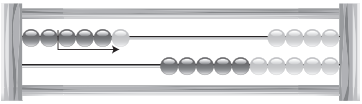

6	–	4	=	2

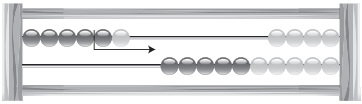

6	–	2	=	4

3

traha som.
uza bo reki.

	5	–	1	=	4
	5	–	4	=	1
	5	–	3	=	2
	5	–	2	=	3

	4	–	2	=	2
	4	–	1	=	3
	4	–	3	=	1
	4	–	4	=	0

	3	–	1	=	2
	3	–	2	=	1
	3	–	3	=	0
	2	–	1	=	1

	6	–	4	=	2
	6	–	2	=	4
	6	–	3	=	3
	6	–	6	=	0

4

cuanto mas of cuanto menos?
pinta strepi y scrap e contesta fout.

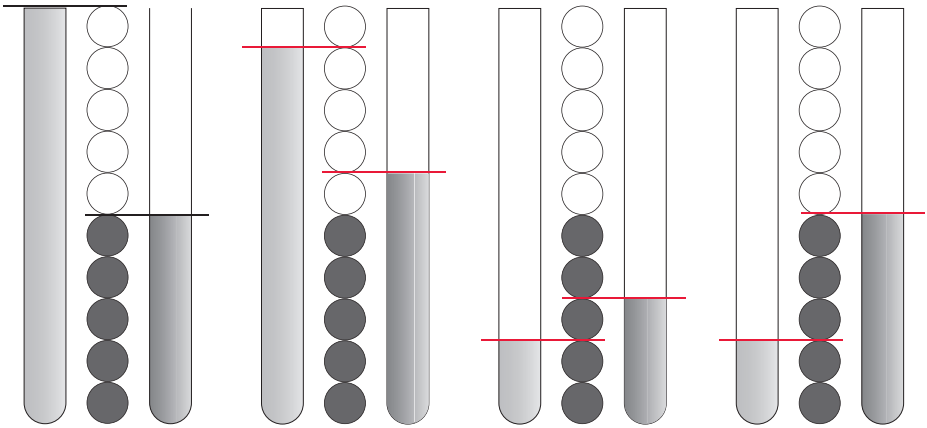

tin 5 mas/ ~~menos~~ cu

tin 3 mas/ ~~menos~~ cu

tin 1 ~~mas~~/ menos cu

tin 3 ~~mas~~/ menos cu

5

cua som ta pas?

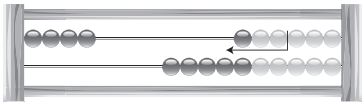

4	+	3	=	7

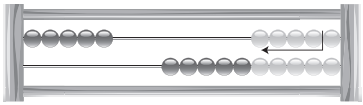

5	+	4	=	9

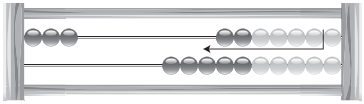

3	+	6	=	9



7	+	2	=	9

6

conta.

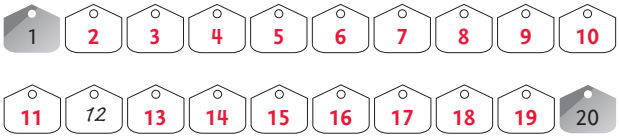

1

yena e numbernan.
bo por pasa 20?

bo por scoge: 2 3 12 14 15 25 4 18 6 7 17 8 27 9 29

1 2 3 4 5 6 7 8 9 10

11 12 13 14 15 16 17 18 19 20

21 22 23 24 25 26 27 28 29 30

2

kleur e number mas grandi.

2 6 4 | 16 13 12 | 9 11 17 | 18 19 20

14 18 17 | 21 22 23 | 27 29 21 | 27 25 26

3

kleur e number mas chikito.

3 7 5 | 17 14 13 | 19 20 21 | 22 23 24

15 19 18 | 28 30 22 | 28 26 27 | 12 22 20

4

yena e numbernan.
bo por scoge: 29 16 18 9 15 21

6 7 8 9 10 11 | 21 20 19 18 17

19 20 21 22 23 | 18 17 16 15 14

14 15 16 17 18 | 30 29 28 27 26

5

cuanto kiniki tin?
marca y turf.

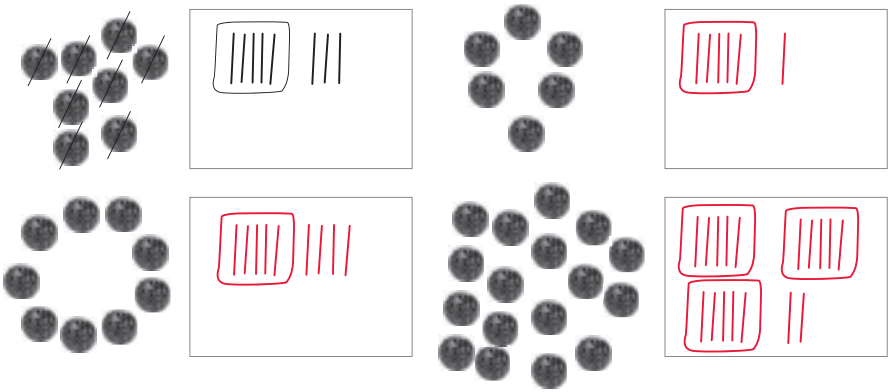

6

cua number ta pas?

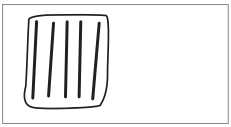

5

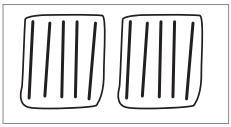

10

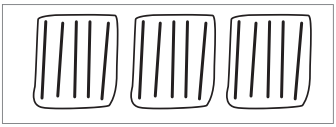

15



6

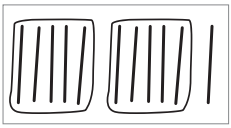

11

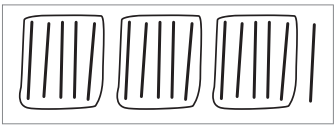

16

7

cuant'or tin?
conecta cu otro.

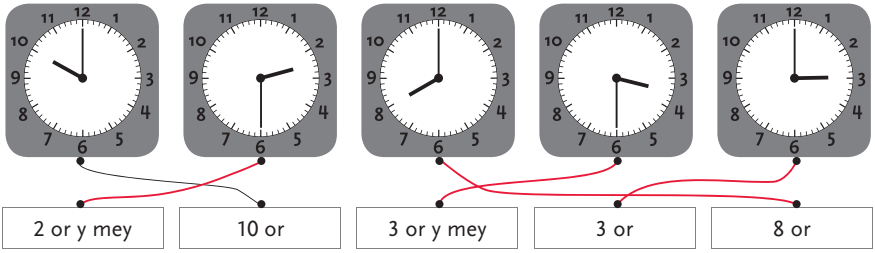

1 cuanto sticker tin?

4	5	10	9	11	10

2 cuanto cralchi a pone?

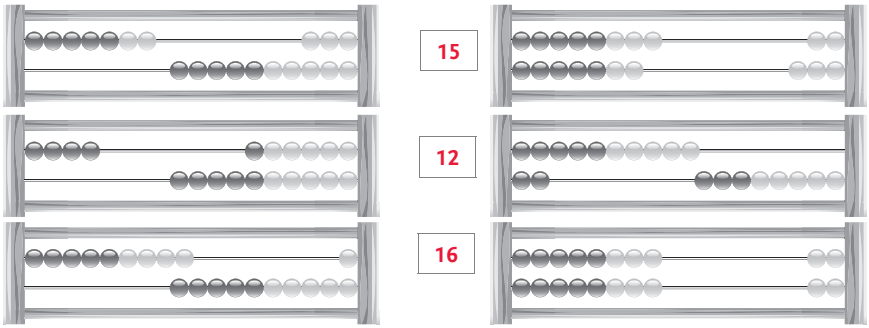

7	15
4	12
9	16

3 traha som.

uza bo reki.

4	+	3	=		7
5	+	2	=		7
6	+	1	=		7
4	+	3	=		7

5	+	1	=		6
4	+	2	=		6
3	+	3	=		6
1	+	5	=		6

4	+	1	=		5
3	+	2	=		5
2	+	3	=		5
1	+	4	=		5

4	+	4	=		8
5	+	3	=		8
2	+	6	=		8
3	+	5	=		8

4

som di pone.
cua som ta pas?

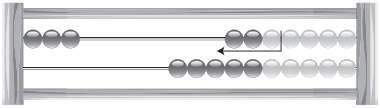

3 + 3 = 6



6 + 3 = 9

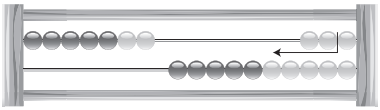

7 + 2 = 9

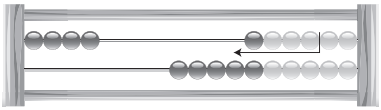

4 + 4 = 8

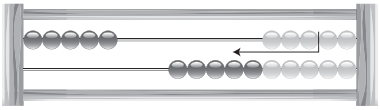

5 + 3 = 8



8 + 2 = 10

5

som di kita.
cua som ta pas?

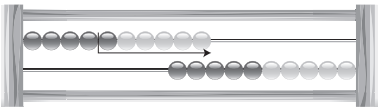

10 – 6 = 4

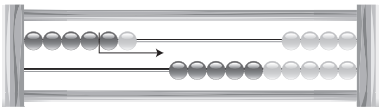

6 – 2 = 4

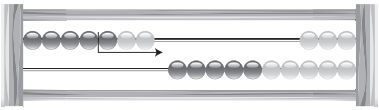

7 – 3 = 4

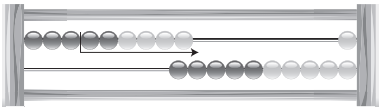

9 – 6 = 3

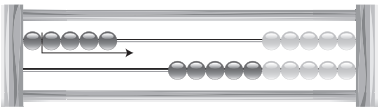

5 – 4 = 1

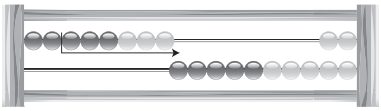

8 – 6 = 2

1 con bo ta conta?

		3				7				11				15				19				23		
	2		4		6		8		10		12		14		16		18		20		22		24	
1				5				9				13				17				21				25

2 kleur e number mas chikito y e number mas grandi.

3	7	5	11
15	19	18	14
28	26	27	24

17	14	13	11
22	23	24	21
12	22	20	27

19	20	21	26
28	30	22	29
18	23	17	24

3 yena e numbernan.

bo por scoge: 19 30 8 14 17 20

6	7	8	9
17	16	15	14

15	16	17	18
21	20	19	18

19	20	21	22
30	29	28	27

4 cua number ta pas?

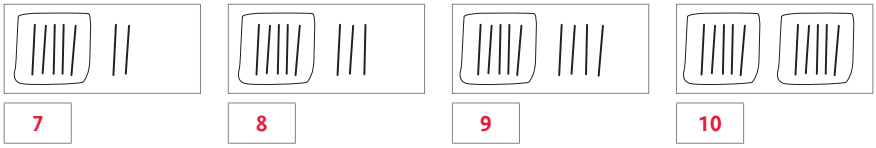

7 8 9 10

5 traha som.

uza bo reki.

9	–	6	=		3	6	–	2	=		4	7	–	2	=		5	1	0	–	5	=	5
8	–	5	=		3	9	–	3	=		6	5	–	4	=		1	1	0	–	7	=	3

6 cuanto florin tin?

7 florin

11 florin

14 florin

18 florin

7 cuanto wowo tin hunto?

cua som ta pas?

5 + 2 = 7

4 + 2 = 6



2 + 3 = 5

1 + 5 = 6

6 + 1 = 7

6 + 4 = 10

6 + 2 = 8

5 + 5 = 10

8 cua som ta pas?

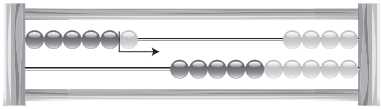

6 – 1 = 5

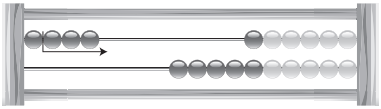

4 – 3 = 1

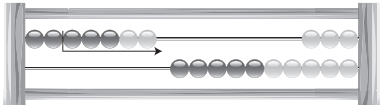

7 – 5 = 2

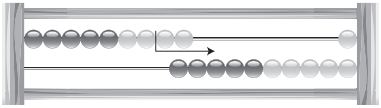

9 – 2 = 7

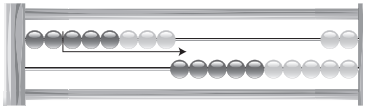

8 – 6 = 2

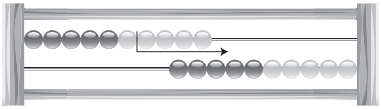

10 – 4 = 6

1 con bo por midi aki?

e hanchura di klas.
ken ta dal mas hopi stap?
marca un cruz.

☐ juffrouw ☒ anna

di con?

kico e juffrouw ta midi?
marca un cruz.

☒ hanchura ☐ haltura

con?

e puzzelnan ta mes grandi?



☒ si ☐ no

kleur e puzzel cu tin menos pida

2 cuanto pia?

marc		5	pia
nora		6	pia
juffrouw		4	pia
kim		8	pia

3 pinta repi.

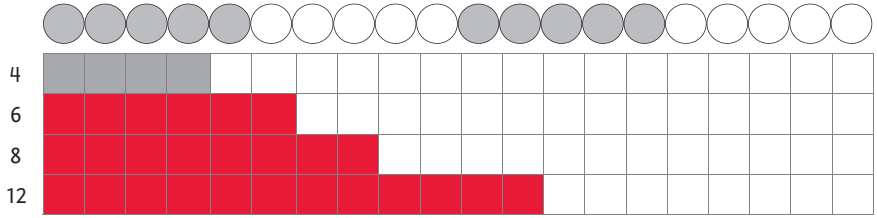

4 **cua di e pidanan ta mes largo?**
duna nan e mesun colo.

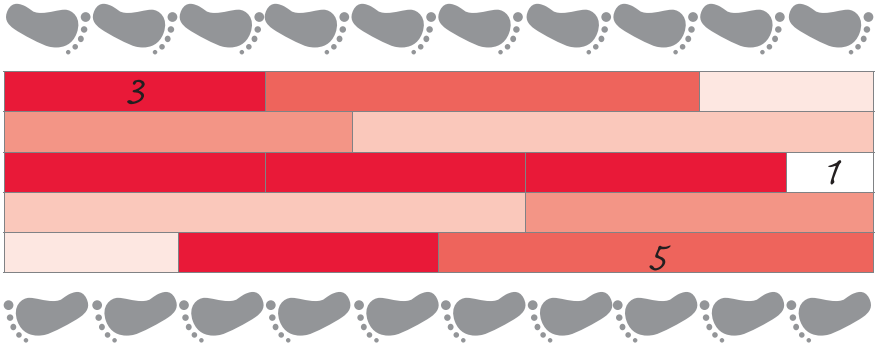

5 **cua number ta pas den e hokinan?**

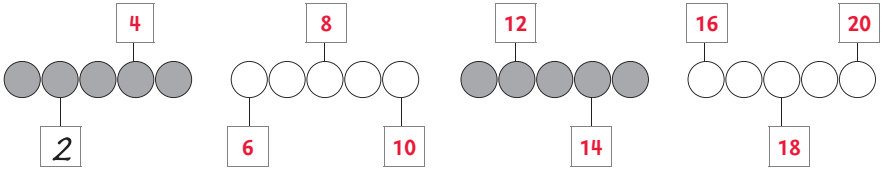

6 **conecta cu otro.**

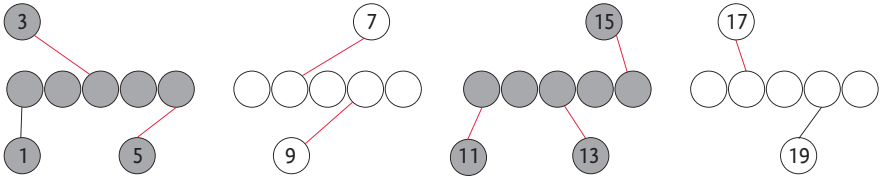

7 **cuanto cralchi a pone?**



1 conta te 50.

1 **2** 3 4 5 6 7 **8** 9 10

11 **12** 13 14 **15** 16 **17** 18 **19** 20

21 22 23 24 25 26 27 28 29 30

31 32 33 34 35 36 37 38 39 40

41 42 43 44 45 46 47 48 49 50

2 conecta cu otro.

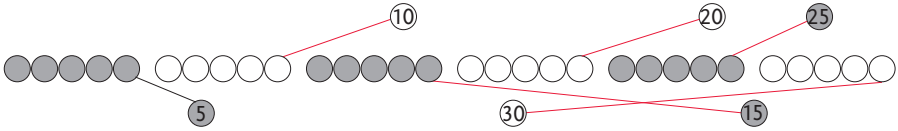

3 skirbi e numbernan di chikito bay grandi.

14	19	10	17	12
10	12	14	17	19

24	29	20	27	22
20	22	24	27	29

34	39	30	37	32
30	32	34	37	39

44	49	40	47	42
40	42	44	47	49

4 split.

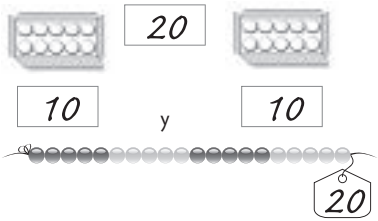

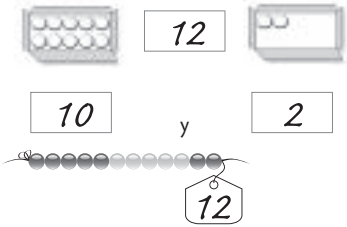

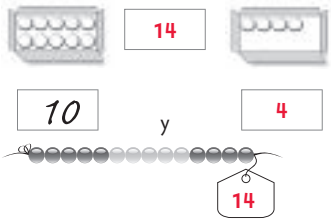

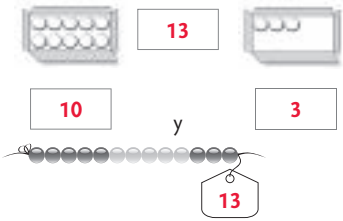

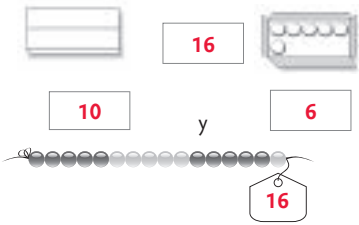

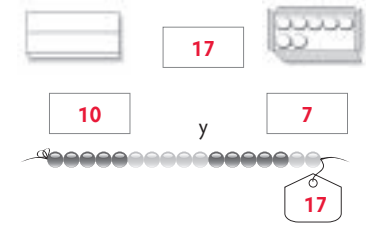

5 split y traha som.

9 < 5 / 4

	9	=	5	+	4	

7 < 2 / 5

	7	=	2	+	5	

8 < 4 / 4

	8	=	4	+	4	

9 < 6 / 3

	9	=	6	+	3	

19 < 10 / 9

1	9	=	1	0	+	9

16 < 10 / 6

1	6	=	1	0	+	6

13 < 10 / 3

1	3	=	1	0	+	3

12 < 2 / 10

1	2	=	2	+	1	0

1 cuanto pia ta pas den cada pida?

5	2	3

3	3	2	2

1	4	5

2 pinta repi.

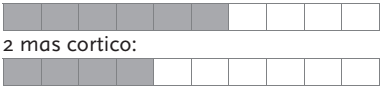

2 mas cortico:

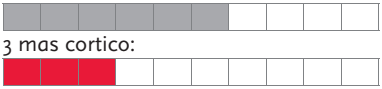

3 mas cortico:

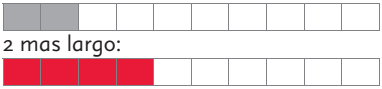

2 mas largo:

4 mas cortico:

2 mas largo:

3 mas largo:

3 mas largo:

3 e buki falta pagina.

cua di nan?

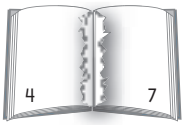

5, 6

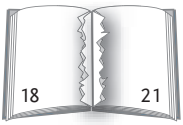

19, 20



23, 24, 25, 26

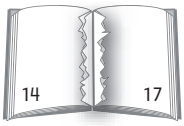

15, 16

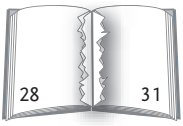

29, 30

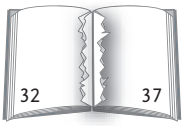

33, 34, 35, 36

4

skirbi e numbernan di chikito bay grandi.

13	19	8	17
8	13	17	19

23	43	33	13
13	23	33	43

47	41	44	49
41	44	47	49

35	33	38	36
33	35	36	38

5

cuanto cralchi a pone?
yena e number.
conecta e som cu ta pas.

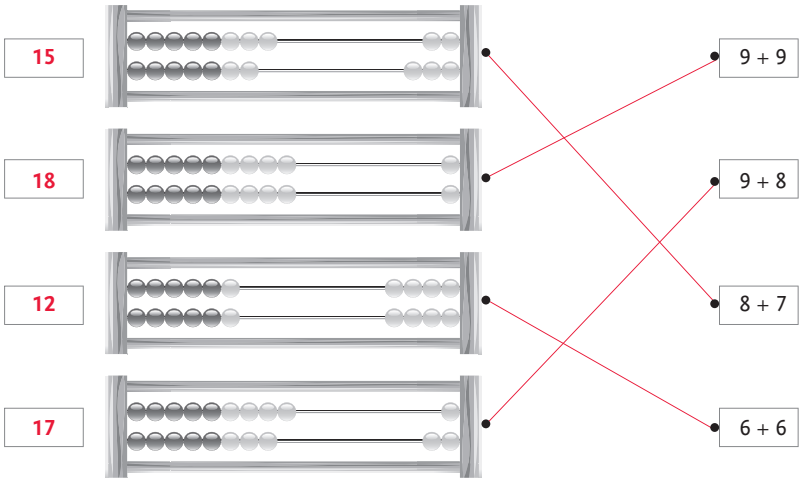

6

cua som ta pas?

5	5

5	+	5	=	1	0

3	7

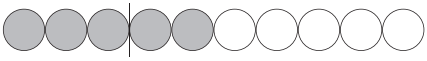

3	+	7	=	1	0

8	2

8	+	2	=	1	0

6	4

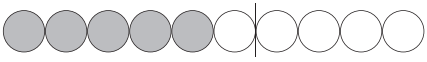

6	+	4	=	1	0

1 split.

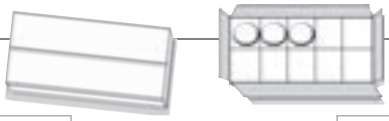

13 < 10 / 3	14 < 10 / 4	15 < 10 / 5
19 < 10 / 9	16 < 10 / 6	12 < 10 / 2
17 < 10 / 7	18 < 10 / 8	11 < 10 / 1

2 rek e somnan.

1 3 + 4 = 1 0 + 3 + 4 = 1 7

3 + 4 = 7

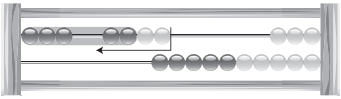

1 3 + 4 = 1 7

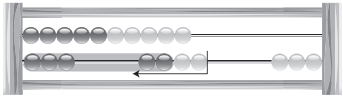

4 + 4 = 8



1 4 + 4 = 1 8

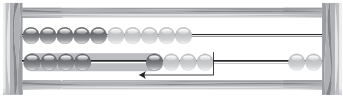

5 + 2 = 7

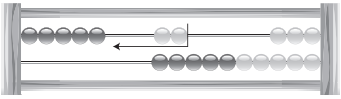

1 5 + 2 = 1 7

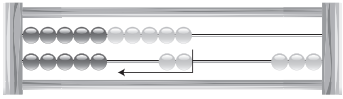

3 traha som.

uza bo reki.



2 + 2 = 4	3 + 3 = 6	2 + 3 = 5
4 + 4 = 8	5 + 5 = 10	4 + 5 = 9
8 + 8 = 16	7 + 7 = 14	8 + 9 = 17
10 + 10 = 20	9 + 9 = 18	8 + 7 = 15

3 + 4 = 7	
5 + 6 = 11	
7 + 8 = 15	
9 + 10 = 19	

4 sigui yena e wiel.

2 + 6 = ?

2 + 1 = 3

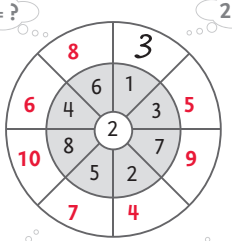

2 + 5 = ?

2 + 2 = ?

11 + 1 = 12

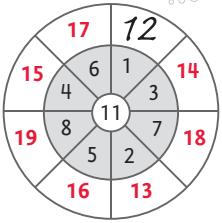

5 cuanto florin tin?

10 florin y 3 florin

ta suma 13 florin

10 florin y 5 florin

ta suma 15 florin

10 florin y 7 florin

ta suma 17 florin

10 florin y 8 florin

ta suma 18 florin

6 completa e rijnan.

7 split.



24

20 y 4

24 = 20 + 4



32

30 y 2

32 = 30 + 2

1	5	=	1	0	+	5		2	3	=	2	0	+	3		3	1	=	3	0	+	1		4	6	=	4	0	+	6	
1	6	=	1	0	+	6		2	7	=	2	0	+	7		3	3	=	3	0	+	3		4	2	=	4	0	+	2	
1	8	=	1	0	+	8		2	4	=	2	0	+	4		3	4	=	3	0	+	4		4	5	=	4	0	+	5	
1	9	=	1	0	+	9		2	8	=	2	0	+	8		3	8	=	3	0	+	8		4	9	=	4	0	+	9	

1 cuanto mucha tin?

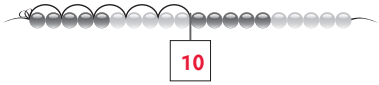

2	+	2	+	2	+	2	+	2	=	1	0			

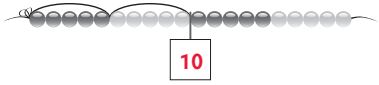

5	+	5	=	1	0									



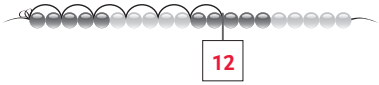

2	+	2	+	2	+	2	+	2	+	2	=	1	2	



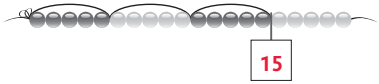

5	+	5	+	5	=	1	5							

2 cua som ta pas?



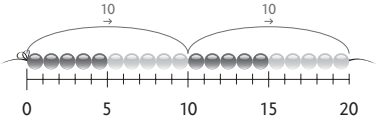

1	0	+	1	0	=	2	0		

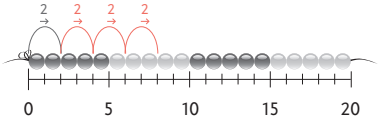

2	+	2	+	2	+	2	=	8	



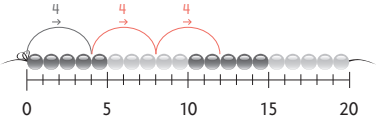

4	+	4	+	4	=	1	2		



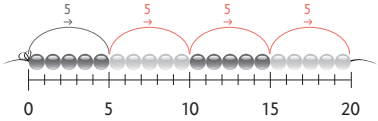

5	+	5	+	5	+	5	=	2	0

3 conecta cu otro.

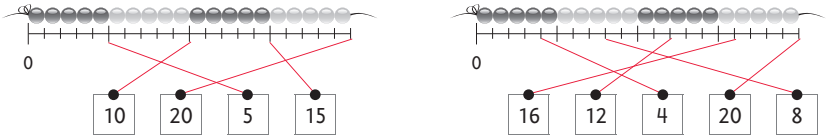

4 cua som ta pas?

conecta y rek e som.

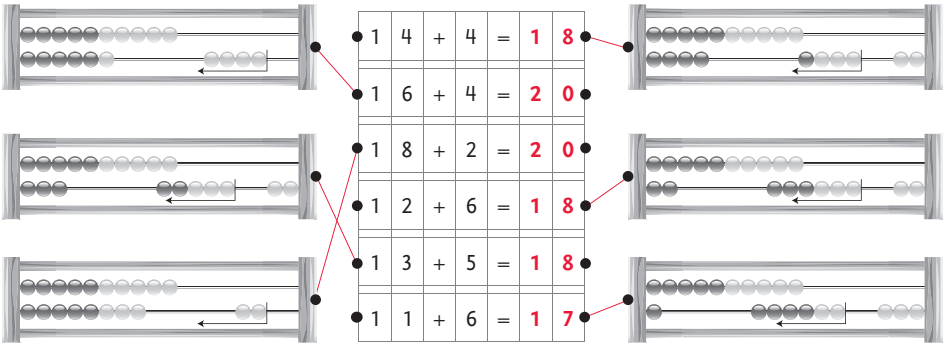

5 cuant'or tin?

1 or	6 or	3 or	8 or	5 or

6 cuant'or tin?

3 or y mey	1 or y mey	10 or y mey	7 or y mey	11 or y mey

1 cuanto tin hunto?

10 y 10 — 20

10 y 4 — 14

10 y 6 — 16

10 y 9 — 19

10 y 8 — 18

10 y 2 — 12

10 y 3 — 13

10 y 7 — 17

10 y 1 — 11

10 y 4 — 14

2 cua som ta pas?

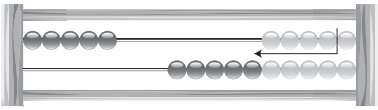

5 + 4 = 9



15 + 4 = 19



8 + 1 = 9



18 + 1 = 19

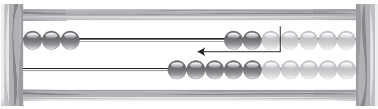

3 + 3 = 6

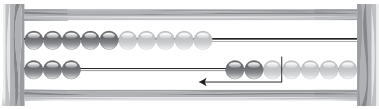

13 + 3 = 16

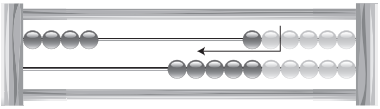

4 + 2 = 6

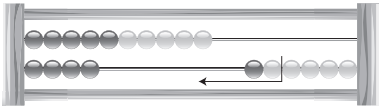

14 + 2 = 16

3 cua som ta pas?

2 + 2 + 2 + 2 = 8

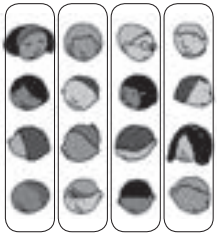

4 + 4 + 4 + 4 = 16

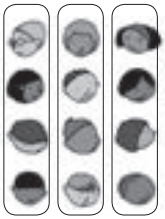

4 + 4 + 4 = 12

2 + 2 + 2 = 6

4 completa e rij.

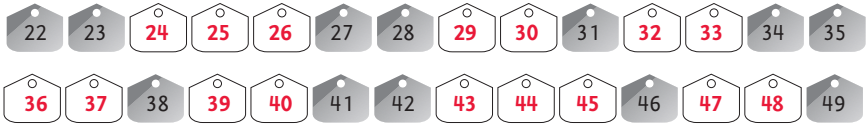

5 hala strepi y kleur.

cada biaha 2 cralchi menos.

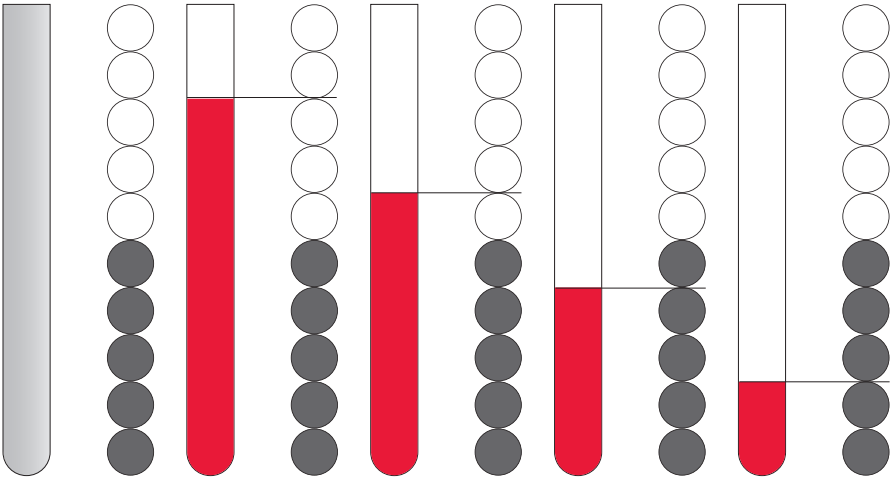

10 8 6 4 2

1

kico marco ta haci na scol?
pinta e man chikito.



7 or y mey
9 or
9 or y mey
10 or



10 or y mey
11 or y mey
12 or y mey
1 or y mey

ta drenta klas:	7 or y mey	8 or	8 or y mey
ta come:	10 or	10 or y mey	11 or
ta hunga pafo:	10 or	10 or y mey	11 or
ta haci gym:	10 or y mey	11 or	11 or y mey
ta cana bay cas:	12 or y mey	1 or	1 or y mey

2

cada biaha mey ora mas tempran.
yena e ora.

4 or	3 or y mey	3 or	2 or y mey	2 or

3 cuant'or tin?

conecta cu otro.





7 or y mey | 5 or | 2 or y mey | 4 or | 4 or y mey | 5 or y mey

cua di e oloshinan ta pas cu e fiesta?
marca un cruz.

4 cada biaha 1 ora mas laat.

pinta e man chikito.

1 or y mey | 2 or y mey | 3 or y mey | 4 or y mey | 5 or y mey

5 cua som ta pas?

bo tin **10** boter

ta kita **4** boter

bo ta resta **6** boter

som 1 0 – 4 = **6**

bo tin **7** bleki

ta kita **4** bleki

bo ta resta **3** bleki

som **7** – **4** = **3**

1

som di kita.
scrap y rek e somnan.

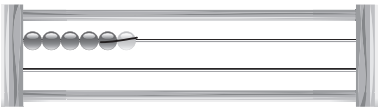

6	–	2	=	4



1	6	–	2	=	1	4

abo mes pinta e cralchinan prome.

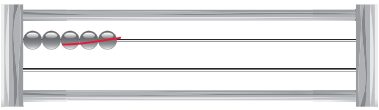

5	–	3	=	**2**	

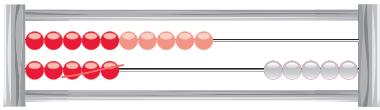

1	5	–	3	=	**1**	**2**	

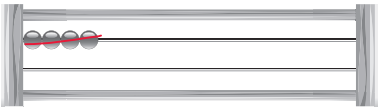

4	–	4	=	**0**	

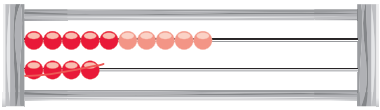

1	4	–	4	=	**1**	**0**	

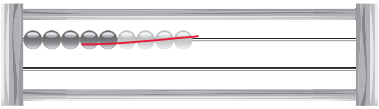

9	–	6	=	**3**	

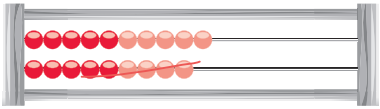

1	9	–	6	=	**1**	**3**	

2

plachi cu som. **mas cu 1 contesta.**

		–			=	*1*	*1*

		–			=		

		–			=		

		–			=		

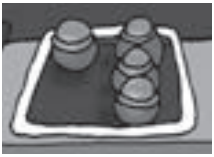

6	–			=			



		–			=		

3 traha som.

1	5	–	5	=	1	0
1	8	–	8	=	1	0

1	3	–	3	=	1	0
1	7	–	7	=	1	0

1	1	–	1	=	1	0
1	9	–	9	=	1	0

2	6	–	6	=	2	0
2	4	–	4	=	2	0

4 cuanto placa falta?

pinta y skirbi.

	bo tin	pinta e placa cu falta	skirbi
	7 florin	1 1 1	3 florin
	4 florin	1 1 1 1 1 1	6 florin
	3 florin	1 1 1 1 1 1 1	7 florin
	5 florin	1 1 1 1 1	5 florin
	8 florin	1 1	2 florin

1

pinta e mannan.

3 or	5 or	7 or	9 or	12 or

mey ora mas laat.

3 or y mey	5 or y mey	7 or y mey	9 or y mey	12 or y mey

2

pinta e mannan.

2 or	6 or	8 or	11 or	1 or

mey ora mas tempran.

1 or y mey	5 or y mey	7 or y mey	10 or y mey	12 or y mey

3

traha som.

	4	–	3	=		1
1	4	–	3	=	1	1

	5	–	2	=		3
1	5	–	2	=	1	3

	9	–	5	=		4
1	9	–	5	=	1	4

	7	–	4	=		3
1	7	–	4	=	1	3

4 cua som ta pas?

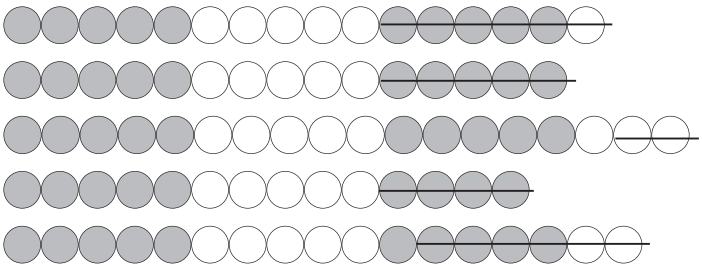

1	6	–	6	=	1	0
1	5	–	5	=	1	0
1	8	–	2	=	1	6
1	4	–	4	=	1	0
1	7	–	6	=	1	1

5 conecta cu otro.

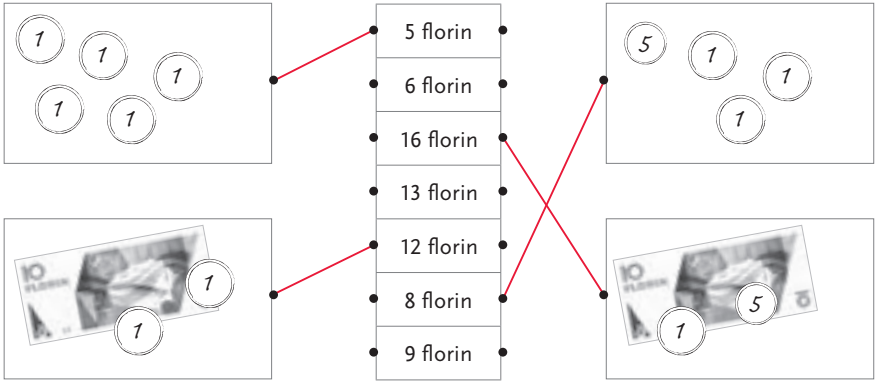

6 yena e numbernan cu falta.

7 traha som.

uza bo reki.

1	0	–	5	=		5
2	0	–	5	=	1	5

1	0	–	6	=		4
2	0	–	6	=	1	4

1	0	–	3	=		7
2	0	–	3	=	1	7

1	0	–	2	=		8
2	0	–	2	=	1	8

1

mes hopi?
pinta mes hopi den tur dos glas.



tin mas, menos of mes hopi?
trata den grupo.

2

tin mes hopi?
kleur si of no.



si	no



si	no



si	no



si	no



si	no



si	no

3

e pidanan ta mes grandi?
kleur si of no.

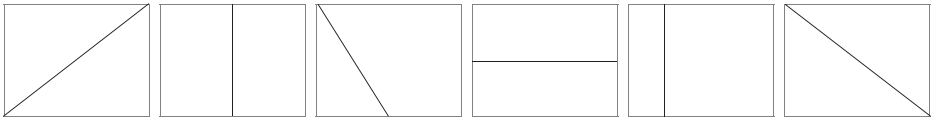

si	no	si	no	si	no	si	no	si	no	si	no

4

parti kiniki.
cada un ta haya 5.
pinta strepi.

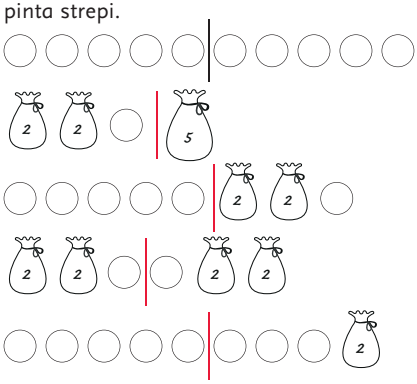

5

traha som.

5	+	2	=	7	

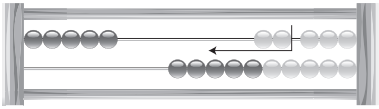

1	5	+	2	=	1 7

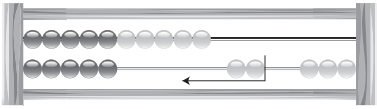

	3	+	3	=	6
1	3	+	3	=	1 6
	6	+	3	=	9
1	6	+	3	=	1 9

	4	+	2	=	6
1	4	+	2	=	1 6
	5	+	2	=	7
1	5	+	2	=	1 7

	4	+	4	=	8
1	4	+	4	=	1 8
	2	+	7	=	9
1	2	+	7	=	1 9

	3	+	7	=	1 0
1	3	+	7	=	2 0
	8	+	2	=	1 0
1	8	+	2	=	2 0

6

traha som.

6	–	2	=	4	

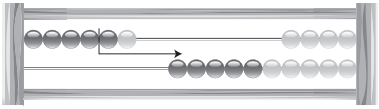

1	6	–	2	=	1 4

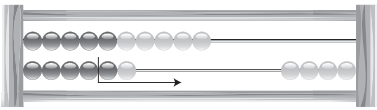

	4	–	3	=	1
1	4	–	3	=	1 1
	5	–	2	=	3
1	5	–	2	=	1 3

	7	–	4	=	3
1	7	–	4	=	1 3
	6	–	5	=	1
1	6	–	5	=	1 1

	7	–	7	=	0
1	7	–	7	=	1 0
	4	–	4	=	0
1	4	–	4	=	1 0

1	0	–	7	=	3
2	0	–	7	=	1 3
1	0	–	8	=	2
2	0	–	8	=	1 2

1

cuanto puzzel nan por cumpra?
cuanto placa nan ta resta?

lidia tin:  e por cumpra **1** e ta resta: f **1**

tico tin:  e por cumpra **2** e ta resta: f **2**

lisa tin: e por cumpra **5** e ta resta: f **0**

2

unda tin f 20?
marca un cruz.

☐	x
x	x
☐	x

3 cuanto nan ta haya bek?

scrap y yena e contesta.

rosa ta cumpra: f 1	e ta duna:	gina ta cumpra f 2	e ta duna:
e ta haya bek: f 4		e ta haya bek: f 3	

tito ta cumpra: f 2	e ta duna:	mel ta cumpra: f 3, f 2	e ta duna:
e ta haya bek: f 8		e ta haya bek: f 5	

padushi ta cumpra: f 1, f 2	e ta duna:	madushi ta cumpra: f 4, f 2	e ta duna:
e ta haya bek: f 7		e ta haya bek: f 4	

4 completa e rij.

23 24 25 26 27 28 29 30 31 32 33 34 35 36

37 38 39 40 41 42 43 44 45 46 47 48 49 50

1 **nora y leo ta parti kiniki.**
tur dos ta haya mes hopi.
marca cu ronchi.

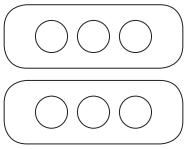

3 pa cada un.

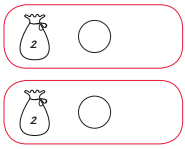

3 pa cada un.

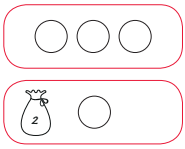

3 pa cada un.

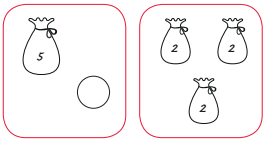

6 pa cada un.

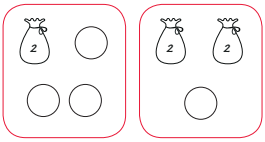

5 pa cada un.

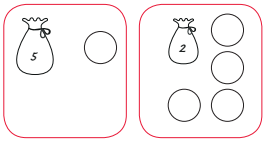

6 pa cada un.

2 **e muchanan ta spaar.**
cuanto placa nan falta ainda?

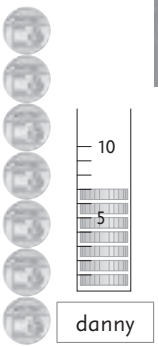

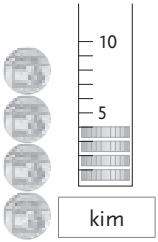

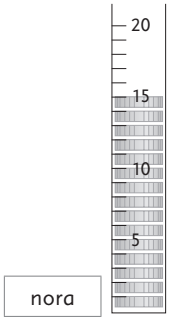

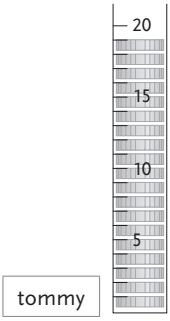

falta: f 3 falta: f 6 falta: f 5 falta: f 1

3 **conecta cu otro.**

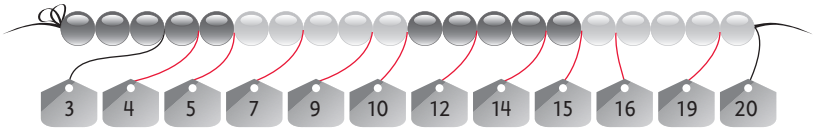

4 cua som ta pas?

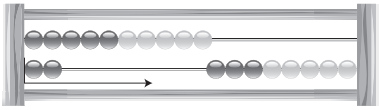

1	2	–	2	=	1	0	

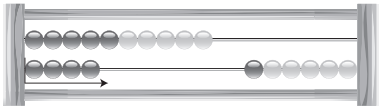

1	4	–	4	=	1	0	

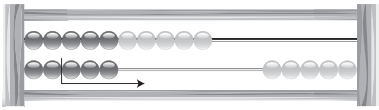

1	5	–	3	=	1	2	

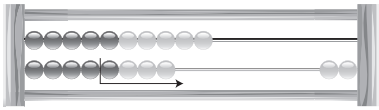

1	8	–	4	=	1	4	

5 traha som.

uza bo reki.

		1	+	1	=	2	
		2	+	2	=	4	
		3	+	3	=	6	
		4	+	4	=	8	

		5	+	5	=	1	0
		6	+	6	=	1	2
		7	+	7	=	1	4
		8	+	8	=	1	6

	9	+		9	=	1	8
1	0	+	1	0	=	2	0
	4	+		5	=		9
	5	+		6	=	1	1

	6	+		7	=	1	3
	7	+		8	=	1	5
	8	+		9	=	1	7
	9	+	1	0	=	1	9

6 na unda e pion ta yega?

traha e som y marca e hoki.

5	+	5	+	3	=	1	3

									10			x							20

									10						x				20

									10		x								20

1 con largo nan ta?

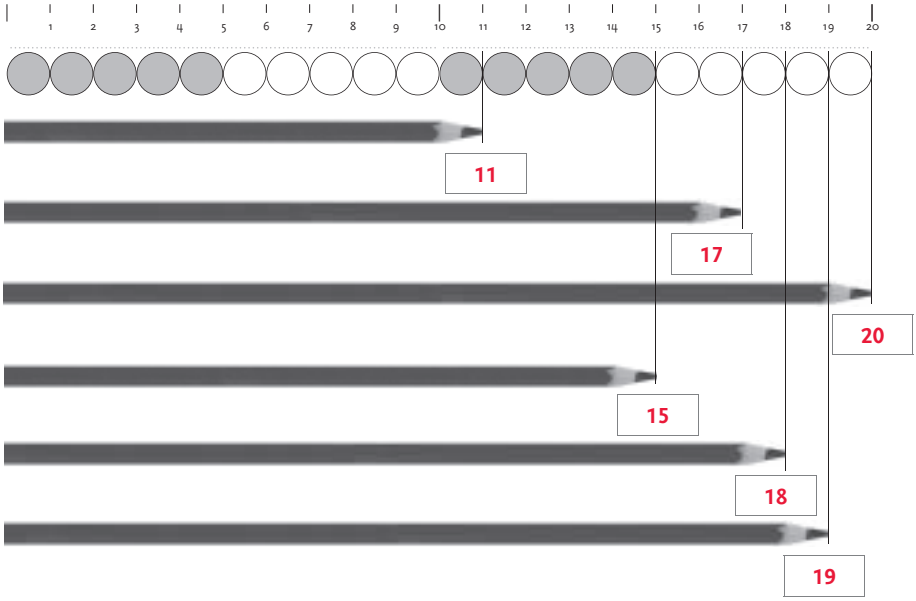

2 rek e somnan.

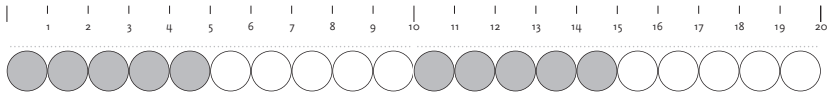

3	2	3	+	2	=	5													
13	2	1	3	+	2	=	1	5											

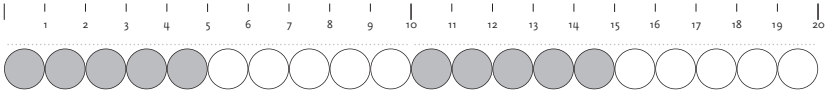

2	5	2	+	5	=	7													
12	5	1	2	+	5	=	1	7											

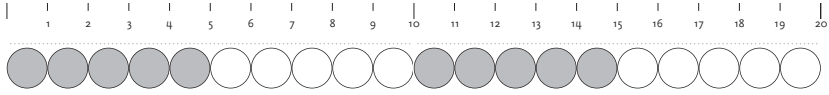

6	2	6	+	2	=	8													
16	2	1	6	+	2	=	1	8											

3

pone y kita.
scrap e number cu mester kita.
traha e som.

3	4	3	+	4	=	7	6	2	6	+	2	=	8
3	~~4~~	7	–	4	=	3	6	~~2~~	8	–	2	=	6
~~3~~	4	7	–	3	=	4	~~6~~	2	8	–	6	=	2

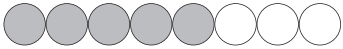

4

pone y kita.
cua som bo por traha?

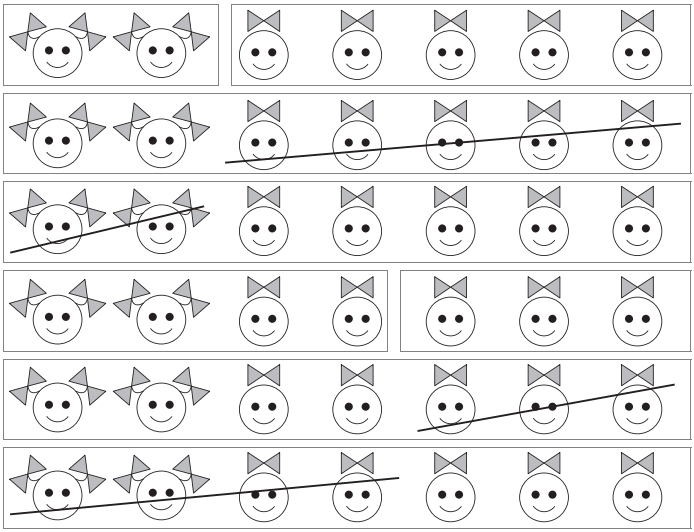

4	+	5	=	9
9	–	5	=	4
9	–	4	=	5
6	+	3	=	9
9	–	3	=	6
9	–	6	=	3

5

cuanto placa tin?

			
f 11	f 6	f 6	f 12

1 completa e kalender.

dialuna	1	8	15	22	29
diamars	2	9	16	23	30
diaranson	3	10	17	24	31
diahuebs	4	11	18	25	
diabierna	5	12	19	26	
diasabra	6	13	20	27	
diadomingo	7	14	21	28	

2 e dianan di siman.

marca e rijnan cu ta coreco.

☒ dialuna – diamars – diaranson
☐ diabierna – diasabra – dialuna
☒ diamars – diaranson – diahuebs
☐ diamars – diaranson – diabierna
☒ diabierna – diasabra – diadomingo
☒ diabierna – diasabra – diadomingo – dialuna
☐ diamars – diaranson – diahuebs – diasabra
☒ diasabra – diadomingo – dialuna – diamars

3 e dianan di siman.

e hokinan shinishi ta diadomingo.
marca ronchi.

na cada dialuna.

1	2	3	4	5	6	7	8	9	10	11	12	13	14	15	
16	17	18	19	20	21	22	23	24	25	26	27	28	29	30	31

na cada diamars.

1	2	3	4	5	6	7	8	9	10	11	12	13	14	15	
16	17	18	19	20	21	22	23	24	25	26	27	28	29	30	31

na cada diasabra.

1	2	3	4	5	6	7	8	9	10	11	12	13	14	15	
16	17	18	19	20	21	22	23	24	25	26	27	28	29	30	31

4 traha som.

1	0	+	3	=	1	3



1	0	+	6	=	1	6
1	0	+	1	=	1	1

1	0	+	4	=	1	4
1	0	+	8	=	1	8

1	0	+	3	=	1	3
1	0	+	9	=	1	9

1	0	+	2	=	1	2
1	0	+	5	=	1	5

5 traha som.

1	3	–	3	=	1	0



1	8	–	8	=	1	0
1	6	–	6	=	1	0

1	5	–	5	=	1	0
1	9	–	9	=	1	0

1	1	–	1	=	1	0
1	4	–	4	=	1	0

1	7	–	7	=	1	0
1	3	–	3	=	1	0

6 cu 3 number bo por traha hopi som.

1 2 8

	8	+	1	=		9
	8	–	1	=		7
	8	+	2	=	1	0
	8	–	2	=		6
	2	+	1	=		3
	2	–	1	=		1

2 3 14

1	4	+	2	=	1	6
1	4	–	2	=	1	2
1	4	+	3	=	1	7
1	4	–	3	=	1	1
	3	+	2	=		5
	3	–	2	=		1

3 4 15

1	5	+	3	=	1	8
1	5	–	3	=	1	2
1	5	+	4	=	1	9
1	5	–	4	=	1	1
	4	+	3	=		7
	4	–	3	=		1

7 completa e rijnan.

8 9 10 11
13 14 15 16
19 20 21 22

12 13 14 15
17 18 19 20
18 19 20 21

1

pone y kita.
scrap e number cu mester kita.
traha e som.

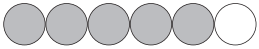

4	2	4	+	2	=	6
4	~~2~~	6	–	2	=	4
~~4~~	2	6	–	4	=	2

6	4		6	+	4	=	1 0
6	~~4~~	1 0	–	4	=		6
~~6~~	4	1 0	–	6	=		4

2

traha e somnan.
kico bo ta ripara?

1 0	+	2	=	1 2	→	1 2	–	2	=	1 0		1 4	+	4	=	1 8	→	1 8	–	4	=	1 4
1 0	+	6	=	1 6	→	1 6	–	6	=	1 0		1 3	+	4	=	1 7	→	1 7	–	4	=	1 3
1 2	+	5	=	1 7	→	1 7	–	5	=	1 2		1 4	+	2	=	1 6	→	1 6	–	2	=	1 4
1 7	+	2	=	1 9	→	1 9	–	2	=	1 7		1 1	+	6	=	1 7	→	1 7	–	6	=	1 1

3

completa e kalender.

dialuna	1	8	15	22	29
diamars	2	9	16	23	30
diaranson	3	10	17	24	31
diahuebs	4	11	18	25	
diabierna	5	12	19	26	
diasabra	6	13	20	27	
diadomingo	7	14	21	28	

riba ki dia e fechanan aki ta cay?

8: dialuna
16: diamars
19: diabierna
28: diadomingo

4 cuanto florin tin?

			
f 15	f 12	f 14	f 11

			
f 13	f 15	f 12	f 18

5 cuanto ta resta?

bo tin:	bo ta paga:	ta resta:
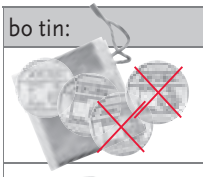	f 2	f 6
	f 6	f 2

bo tin:	bo ta paga:	ta resta:
	f 16	f 4
	f 8	f 5

6 cu 3 number bo por traha hopi som.

1 2 8

	1	+	2	=		3	
	2	+	1	=		3	
	1	+	8	=		9	
	8	+	1	=		9	
	2	+	8	=	1	0	

2 3 14

	2	+		3	=		5
	3	+		2	=		5
	2	+	1	4	==	1	6
1	4	+		2	=	1	6
	3	+	1	4	=	1	7

3 4 15

	3	+		4	=		7
	4	+		3	=		7
	3	+	1	5	=	1	8
1	5	+		3	=	1	8
	4	+	1	5	=	1	9

1

cuanto nan ta hunto?
conecta cu otro.

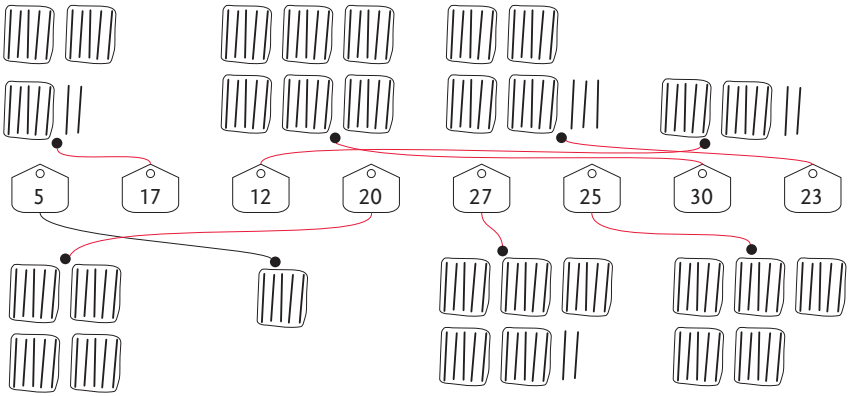

2

conecta cu otro.

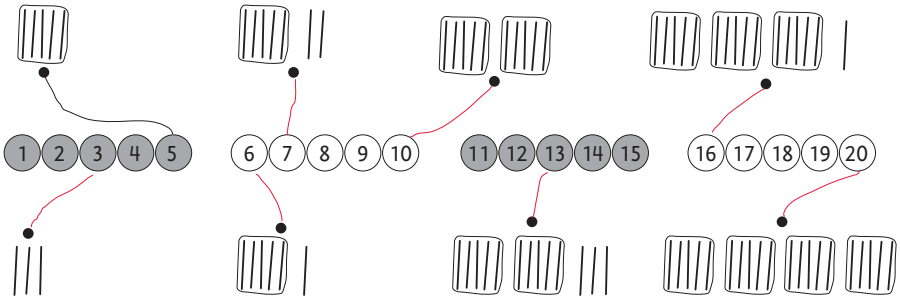

3

traha som.
uza bo reki.

1	0	–	4	=	6	
1	0	–	3	=	7	
1	0	–	5	=	5	
1	0	–	8	=	2	

1	0	–	1	=	9	
1	0	–	7	=	3	
1	0	–	2	=	8	
1	0	–	6	=	4	

2	0	–	7	=	1	3
2	0	–	6	=	1	4
2	0	–	5	=	1	5
2	0	–	8	=	1	2

2	0	–	3	=	1	7
2	0	–	4	=	1	6
2	0	–	1	=	1	9
2	0	–	2	=	1	8

4

na unda e pion ta yega?
conta bay bek.
yena e number.

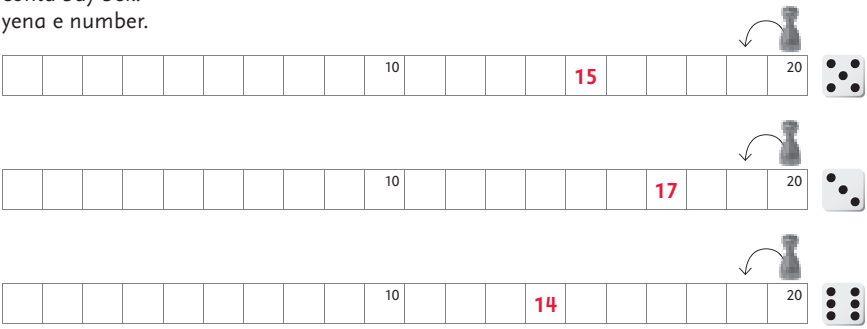

5

traha som.

1	0	+	4	=	1	4
1	0	+	3	=	1	3
1	0	+	5	=	1	5
1	0	+	8	=	1	8

1	0	+	1	=	1	1
1	0	+	7	=	1	7
1	0	+	2	=	1	2
1	0	+	9	=	1	9

2	0	+	7	=	2	7
2	0	+	6	=	2	6
2	0	+	5	=	2	5
2	0	+	8	=	2	8

2	0	+	3	=	2	3
2	0	+	4	=	2	4
2	0	+	1	=	2	1
2	0	+	2	=	2	2

6

na unda e pion ta yega?
yena e number.
traha e som.

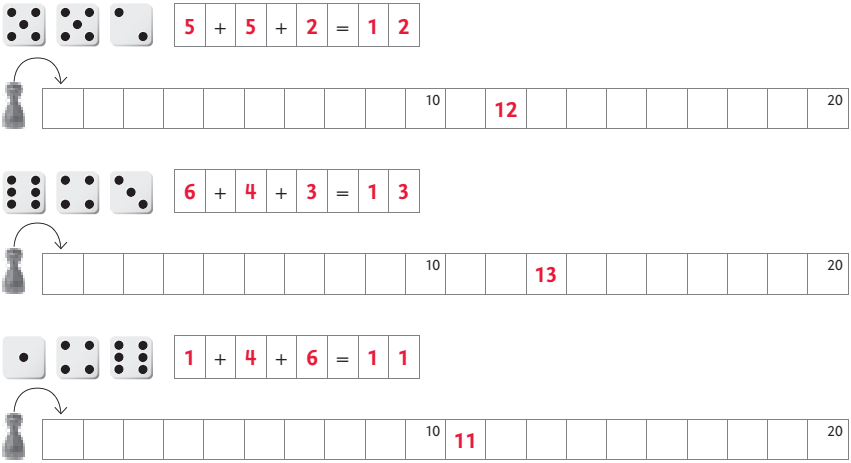

1 unda cu bo bira ta number bo ta mira.

busca e numbernan aki:

34 20 70 50 40 100

2 skirbi e numbernan di chikito bay grandi.

20 70 10 50 100 30 90 60 80 40

10 20 30 40 50 60 70 80 90 100

3 salto di 5.

conecta.

20 30 40 50 60

25 35 45 55 65

4 sigui conta.

50 51 52 53 54 55 56 57 58 59 60 61 62

70 71 72 73 74 75 76 77 78 79 80 81 82

35 36 37 38 39 40 41 42 43 44 45 46 47

80 81 82 83 84 85 86 87 88 89 90 91 92

5 cua number ta pas memey?

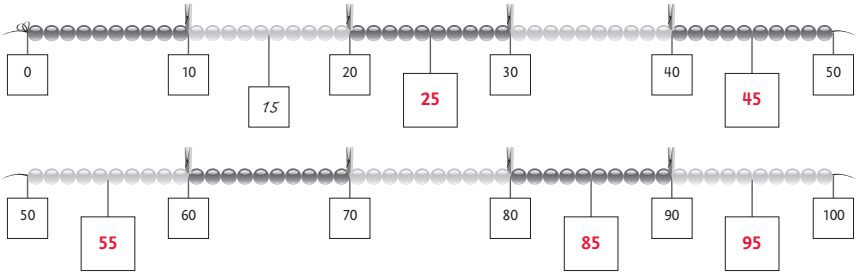

6 cuanto placa nan ta resta?

scrap y pinta e placa.

lito tin:	e ta cumpra:	e ta resta:
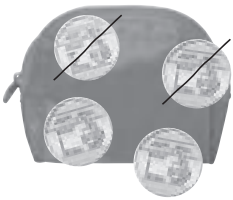		

dolf tin:	e ta cumpra:	e ta resta:
		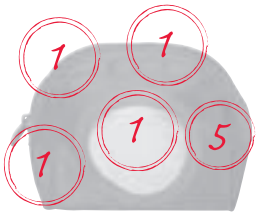

tica tin:	e ta cumpra:	e ta resta:

1 conecta cu otro.

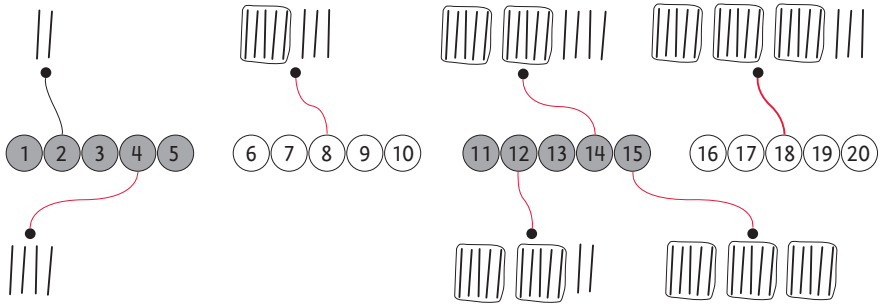

2 skirbi e numbernan di chikito bay grandi.

70	20	40	10	60	100	50	90	30	80
10	20	30	40	50	60	70	80	90	100

3 skirbi e numbernan di chikito bay grandi.

20	40	30	10
10	20	30	40

21	44	33	12
12	21	33	44

60	90	70	80
60	70	80	90

61	92	74	81
61	74	81	92

40	60	50	70
40	50	60	70

49	62	58	73
49	58	62	73

4 cuanto ficha tin?

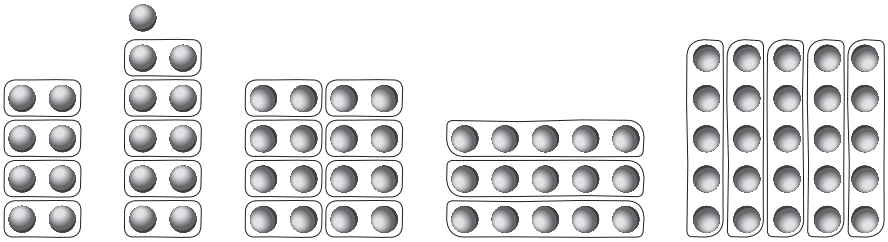

8 11 16 15 25

5 cuant' or tin?

2 or

6 or

8 or

11 or

1 or

5 or

3 or

9 or

4 or

7 or

6 cuant' or tin?

unda e man chikito ta?

entre 9 y 10

9 or y mey

entre 2 y 3

2 or y mey

entre 10 y 11

10 or y mey

entre 6 y 7

6 or y mey

entre 3 y 4

3 or y mey

entre 8 y 9

8 or y mey

entre 1 y 2

1 or y mey

entre 11 y 12

11 or y mey

entre 4 y 5

4 or y mey

entre 7 y 8

7 or y mey

7 conta bay bek.

1 cuanto nan ta hunto?

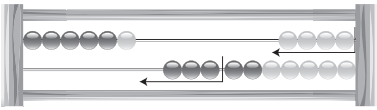

6 + 7 =

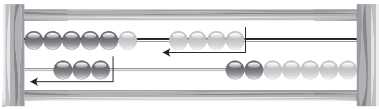

6 + 7 = (6 + 4) + 3 = 13
10
4 3

abo awor.

5 + 8 = (5 + 5) + 3 = 13
10
5 3

9 + 4 = (9 + 1) + 3 = 13
10
1 3

2 split y rek.

uza bo reki.

9 + 3 = (9 + 1) + 2 = 12
10
1 2

8 + 4 = (8 + 2) + 2 = 12
10
2 2

7 + 8 = (7 + 3) + 5 = 15
10
3 5

9 + 5 = (9 + 1) + 4 = 14
10
1 4

7 + 9 = (7 + 3) + 6 = 16
10
3 6

5 + 7 = (5 + 5) + 2 = 12
10
5 2

3 con bo ta yega 10?

pinta e wowonan y traha e somnan.

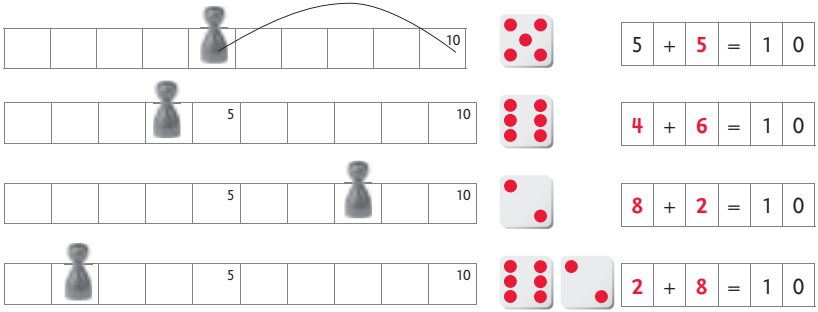

4 split.

5	5	5	5		
3 2	4 1	2 3	1 4		
7	7	7	7	7	7
3 4	5 2	2 5	4 3	1 6	6 1
8	8	8	8	8	8
3 5	5 3	6 2	4 4	2 6	1 7

5 cuanto cralchi a pone?

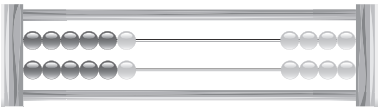

12

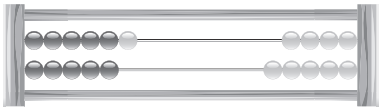

11



14



13



16



15

6 cuanto tin hunto?

9

6

9

8

5

8

9

6

8

6

1

som cu dobel.

marca nan cu un cruz.

0 + 0	1 + 1	2 + 2	3 + 3	4 + 4	5 + 5	6 + 6	7 + 7	8 + 8	9 + 9	10 + 10

despues kleur tur som cu 5 aden.

0 + 0	1 + 0	2 + 0	3 + 0	4 + 0	5 + 0	6 + 0	7 + 0	8 + 0	9 + 0	10 + 0
0 + 1	1 + 1	2 + 1	3 + 1	4 + 1	5 + 1	6 + 1	7 + 1	8 + 1	9 + 1	10 + 1
0 + 2	1 + 2	2 + 2	3 + 2	4 + 2	5 + 2	6 + 2	7 + 2	8 + 2	9 + 2	10 + 2
0 + 3	1 + 3	2 + 3	3 + 3	4 + 3	5 + 3	6 + 3	7 + 3	8 + 3	9 + 3	10 + 3
0 + 4	1 + 4	2 + 4	3 + 4	4 + 4	5 + 4	6 + 4	7 + 4	8 + 4	9 + 4	10 + 4
0 + 5	1 + 5	2 + 5	3 + 5	4 + 5	5 + 5	6 + 5	7 + 5	8 + 5	9 + 5	10 + 5
0 + 6	1 + 6	2 + 6	3 + 6	4 + 6	5 + 6	6 + 6	7 + 6	8 + 6	9 + 6	10 + 6
0 + 7	1 + 7	2 + 7	3 + 7	4 + 7	5 + 7	6 + 7	7 + 7	8 + 7	9 + 7	10 + 7
0 + 8	1 + 8	2 + 8	3 + 8	4 + 8	5 + 8	6 + 8	7 + 8	8 + 8	9 + 8	10 + 8
0 + 9	1 + 9	2 + 9	3 + 9	4 + 9	5 + 9	6 + 9	7 + 9	8 + 9	9 + 9	10 + 9
0 + 10	1 + 10	2 + 10	3 + 10	4 + 10	5 + 10	6 + 10	7 + 10	8 + 10	9 + 10	10 + 10

2

traha som for di e tabla di conta.

1 + 1 = 2	2 + 1 = 3	3 + 1 = 4	4 + 1 = 5	5 + 1 = 6	6 + 1 = 7
1 + 2 = 3	2 + 2 = 4	3 + 2 = 5	4 + 2 = 6	5 + 2 = 7	6 + 2 = 8
1 + 3 = 4	2 + 3 = 5	3 + 3 = 6	4 + 3 = 7	5 + 3 = 8	6 + 3 = 9
1 + 4 = 5	2 + 4 = 6	3 + 4 = 7	4 + 4 = 8	5 + 4 = 9	6 + 4 = 10

3

traha som for di e tabla di conta.

5 + 1 = 6	6 + 1 = 7	7 + 1 = 8	8 + 1 = 9	9 + 1 = 10	10 + 1 = 11
5 + 2 = 7	6 + 2 = 8	7 + 2 = 9	8 + 2 = 10	9 + 2 = 11	10 + 2 = 12
5 + 3 = 8	6 + 3 = 9	7 + 3 = 10	8 + 3 = 11	9 + 3 = 12	10 + 3 = 13
5 + 4 = 9	6 + 4 = 10	7 + 4 = 11	8 + 4 = 12	9 + 4 = 13	10 + 4 = 14

4 kleur e somnan cu ta sali 5.

0 + 0	1 + 0	2 + 0	3 + 0	4 + 0	5 + 0
0 + 1	1 + 1	2 + 1	3 + 1	4 + 1	5 + 1
0 + 2	1 + 2	2 + 2	3 + 2	4 + 2	5 + 2
0 + 3	1 + 3	2 + 3	3 + 3	4 + 3	5 + 3
0 + 4	1 + 4	2 + 4	3 + 4	4 + 4	5 + 4
0 + 5	1 + 5	2 + 5	3 + 5	4 + 5	5 + 5

5 cua som ta pas?

conecta cu otro.

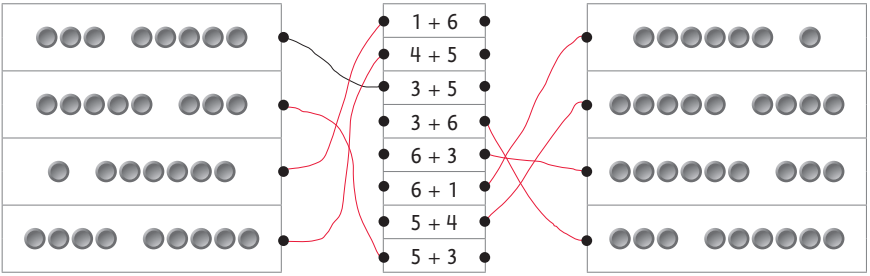

6 cua number ta pas?

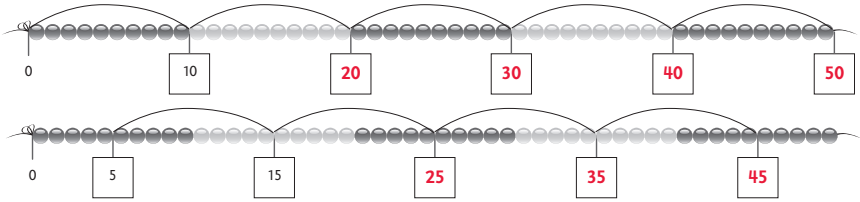

7 traha som.

	1	0	–	1	=	9
	1	0	–	2	=	8
	1	0	–	3	=	7
	1	0	–	4	=	6

	1	0	–	5	=	5
	1	0	–	6	=	4
	1	0	–	7	=	3
	1	0	–	8	=	2

1	0	–	9	=		1
1	1	–	1	=	1	0
1	2	–	2	=	1	0
1	3	–	3	=	1	0

1	4	–	4	=	1	0
1	5	–	5	=	1	0
1	6	–	6	=	1	0
1	7	–	7	=	1	0

1 traha som.

5	+	5	=	1	0
5	+	4	=		9
4	+	5	=		9

4	+	4	=	8	
4	+	3	=	7	
3	+	4	=	7	

3	+	3	=	6	
2	+	3	=	5	
3	+	2	=	5	

2	+	2	=	4	
1	+	2	=	3	
2	+	1	=	3	

2 traha som.

1	0	–	7	=	3
1	0	–	3	=	7

1	0	–	4	=	6
1	0	–	6	=	4

8	–	5	=	3	
8	–	3	=	5	

9	–	2	=	7	
9	–	7	=	2	

3 split y rek.

uza bo reki.

8 + 5 = (8 + 2) + 3 = 13
10
2 3

9 + 6 = (9 + 1) + 5 = 15
10
1 5

6 + 9 = (6 + 4) + 5 = 15
10
4 5

9 + 8 = (9 + 1) + 7 = 17
10
1 7

6 + 7 = (6 + 4) + 3 = 13
10
4 3

7 + 6 = (7 + 3) + 3 = 13
10
3 3

7 + 4 = (7 + 3) + 1 = 11
10
3 1

4 + 7 = (4 + 6) + 1 = 11
10
6 1

5 + 8 = (5 + 5) + 3 = 13
10
5 3

8 + 7 = (8 + 2) + 5 = 15
10
2 5

7 + 8 = (7 + 3) + 5 = 15
10
3 5

8 + 9 = (8 + 2) + 7 = 17
10
2 7

4 e tabla di conta.

kleur tur som cu ta sali 10.
traha tur som cu ta cuminsa cu 10.

5 + 1	6 + 1	7 + 1	8 + 1	9 + 1	10 + 1	11
5 + 2	6 + 2	7 + 2	8 + 2	9 + 2	10 + 2	12
5 + 3	6 + 3	7 + 3	8 + 3	9 + 3	10 + 3	13
5 + 4	6 + 4	7 + 4	8 + 4	9 + 4	10 + 4	14
5 + 5	6 + 5	7 + 5	8 + 5	9 + 5	10 + 5	15

5 **kleur e numbernan cu ta suma 10.**

2 4 8 5 7 3 9 1 8 6 3 4 5 6 5

6 **kleur e numbernan cu ta suma 12.**

10 1 2 11 2 1 9 1 3 8 2 4 6 6 7

7 **kleur e numbernan cu ta suma 14.**

7 7 6 14 0 1 12 3 2 11 3 2 9 4 5

8 **cuant'or tin?**
pinta e mannan y yena e ora.

awor tin: 2 or
mey ora mas tempran: 1 or y mey

awor tin: 7 or
mey ora mas tempran: 6 or y mey

awor tin: 9 or
mey ora mas tempran: 8 or y mey

awor tin: 11 or
mey ora mas tempran: 10 or y mey

9 **yena e numbernan cu falta.**

21 22 23 24 25 26 27 28 29 30
31 32 33 34 35 36 37 38 39 40

1 cuanto ta resta?

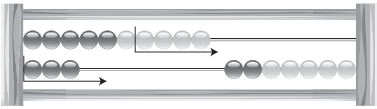

13 – 7 =

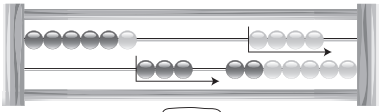

13 – 7 = (13 – 3) – 4 = 6

10

3 4

abo awor:

14 – 6 = (14 – 4) – 2 = 8

10

4 2

11 – 6 = (11 – 1) – 5 = 5

10

1 5

2 split y rek.

uza bo reki.

13 – 5 = (13 – 3) – 2 = 8

10

3 2

15 – 7 = (15 – 5) – 2 = 8

10

5 2

12 – 4 = (12 – 2) – 2 = 8

10

2 2

17 – 9 = (17 – 7) – 2 = 8

10

7 2

11 – 5 = (11 – 1) – 4 = 6

10

1 4

16 – 9 = (16 – 6) – 3 = 7

10

6 3

3 cua som ta pas? mas cu 1 contesta.



1	1	–		6	=	5	

1	6	–		7	=	9	

1	6	–		8	=	8	

4 cuanto cralchi a pone?



19



15

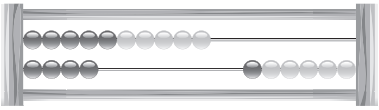

14



16



18



17

5 e tabla di conta.

kleur tur som cu 7.
marca e somnan cu ta sali 7 cu un cruz.

0 + 0	1 + 0	2 + 0	3 + 0	4 + 0	5 + 0	6 + 0	7 + 0	8 + 0	9 + 0	10 + 0
0 + 1	1 + 1	2 + 1	3 + 1	4 + 1	5 + 1	6 + 1	7 + 1	8 + 1	9 + 1	10 + 1
0 + 2	1 + 2	2 + 2	3 + 2	4 + 2	5 + 2	6 + 2	7 + 2	8 + 2	9 + 2	10 + 2
0 + 3	1 + 3	2 + 3	3 + 3	4 + 3	5 + 3	6 + 3	7 + 3	8 + 3	9 + 3	10 + 3
0 + 4	1 + 4	2 + 4	3 + 4	4 + 4	5 + 4	6 + 4	7 + 4	8 + 4	9 + 4	10 + 4
0 + 5	1 + 5	2 + 5	3 + 5	4 + 5	5 + 5	6 + 5	7 + 5	8 + 5	9 + 5	10 + 5
0 + 6	1 + 6	2 + 6	3 + 6	4 + 6	5 + 6	6 + 6	7 + 6	8 + 6	9 + 6	10 + 6
0 + 7	1 + 7	2 + 7	3 + 7	4 + 7	5 + 7	6 + 7	7 + 7	8 + 7	9 + 7	10 + 7
0 + 8	1 + 8	2 + 8	3 + 8	4 + 8	5 + 8	6 + 8	7 + 8	8 + 8	9 + 8	10 + 8
0 + 9	1 + 9	2 + 9	3 + 9	4 + 9	5 + 9	6 + 9	7 + 9	8 + 9	9 + 9	10 + 9
0 + 10	1 + 10	2 + 10	3 + 10	4 + 10	5 + 10	6 + 10	7 + 10	8 + 10	9 + 10	10 + 10

6 conta cu salto.

2 4 6 8 10 12 14 16 18 20 22 24 26 28 30

5 10 15 20 25 30 35 40 45 50 55 60 65 70 75

1

midi cu e liniaal di borchi.
kico ta mas cu 1 meter?
marca cu un cruz.
mas cu 1 contesta.

2

wak rond.
skirbi of pinta. **mas cu 1 contesta.**

algo cu ta menos cu 1 meter	algo di 1 meter	algo cu ta mas cu 1 meter

3

cua number ta pas?

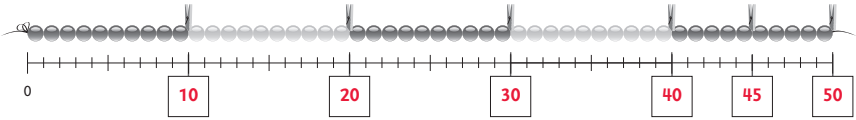

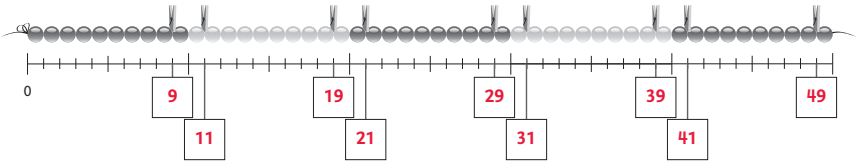

4 traha e somnan gekleur di e tabla di conta.

0 + 0	1 + 0	2 + 0	3 + 0	4 + 0	5 + 0	6 + 0	7 + 0	8 + 0	9 + 0	10 + 0
0 + 1	1 + 1	2 + 1	3 + 1	4 + 1	5 + 1	6 + 1	7 + 1	8 + 1	9 + 1	10 + 1
0 + 2	1 + 2	2 + 2	3 + 2	4 + 2	5 + 2	6 + 2	7 + 2	8 + 2	9 + 2	10 + 2
0 + 3	1 + 3	2 + 3	3 + 3	4 + 3	5 + 3	6 + 3	7 + 3	8 + 3	9 + 3	10 + 3
0 + 4	1 + 4	2 + 4	3 + 4	4 + 4	5 + 4	6 + 4	7 + 4	8 + 4	9 + 4	10 + 4
0 + 5	1 + 5	2 + 5	3 + 5	4 + 5	5 + 5	6 + 5	7 + 5	8 + 5	9 + 5	10 + 5
0 + 6	1 + 6	2 + 6	3 + 6	4 + 6	5 + 6	6 + 6	7 + 6	8 + 6	9 + 6	10 + 6
0 + 7	1 + 7	2 + 7	3 + 7	4 + 7	5 + 7	6 + 7	7 + 7	8 + 7	9 + 7	10 + 7
0 + 8	1 + 8	2 + 8	3 + 8	4 + 8	5 + 8	6 + 8	7 + 8	8 + 8	9 + 8	10 + 8
0 + 9	1 + 9	2 + 9	3 + 9	4 + 9	5 + 9	6 + 9	7 + 9	8 + 9	9 + 9	10 + 9
0 + 10	1 + 10	2 + 10	3 + 10	4 + 10	5 + 10	6 + 10	7 + 10	8 + 10	9 + 10	10 + 10

	7	+	4	=	1	1
	0	+	9	=		9
	8	+	3	=	1	1
	2	+	7	=		9
	9	+	0	=		9

1	+	1	0	=	1	1
3	+		8	=	1	1
3	+		6	=		9
4	+		5	=		9
2	+		9	=	1	1

	6	+	3	=		9
	7	+	2	=		9
	4	+	7	=	1	1
	8	+	1	=		9
	5	+	6	=	1	1

	5	+	4	=		9
	9	+	2	=	1	1
1	0	+	1	=	1	1
	1	+	8	=		9
	6	+	5	=	1	1

5 na unda e pion ta yega?

conta bay bek.
yena e number.

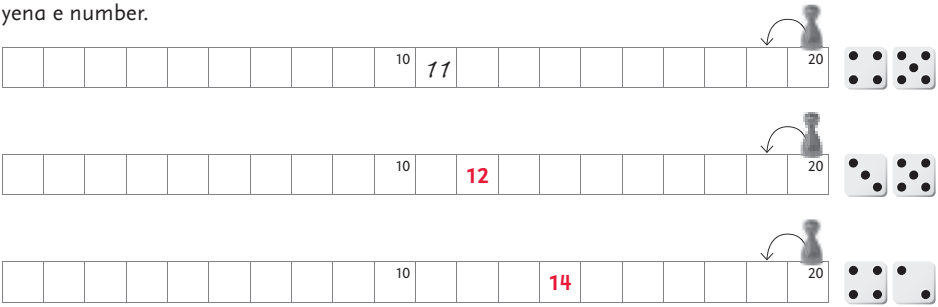

1 cua som ta pas?

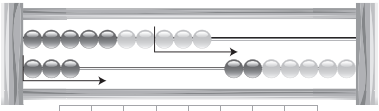

1	3	–	6	=	7		

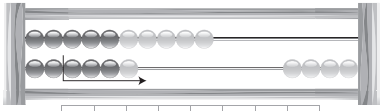

1	6	–	4	=	1	2	

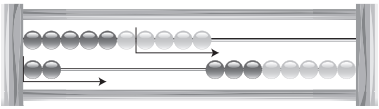

1	2	–	6	=	6		



1	4	–	4	=	1	0	

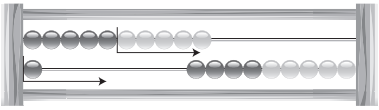

1	1	–	6	=	5		



1	2	–	4	=	8		

2 kita 9.

pinta e flechanan y traha e somnan.

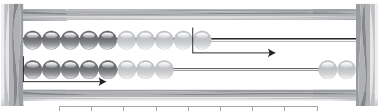

1	8	–	9	=	9		

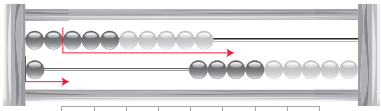

1	1	–	9	=	2		

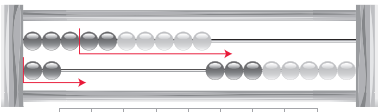

1	2	–	9	=	3		

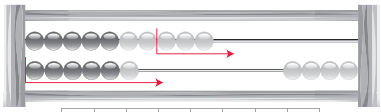

1	6	–	9	=	7		

3 split.

1	9	=	1	0	+	9
1	5	=	1	0	+	5

1	2	=	1	0	+	2
1	7	=	1	0	+	7

1	8	=	1	0	+	8
1	1	=	1	0	+	1

1	3	=	1	0	+	3
1	4	=	1	0	+	4

4

cuanto?
con ta sigui?

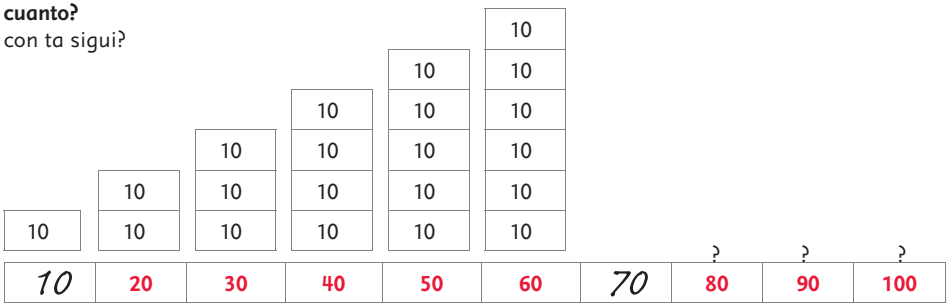

5

salto di 5.
yena e numbernan.

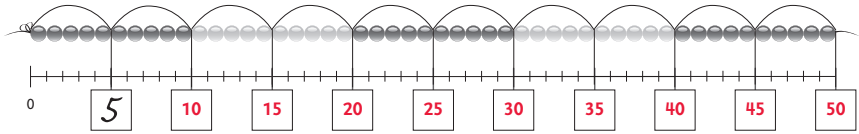

conecta.

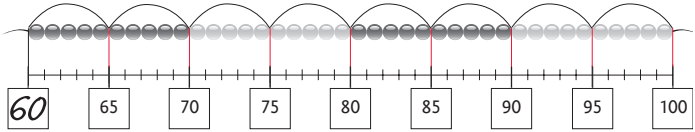

6

cuanto bo mester tira?
bo kier yega na e cruz.
yena e numbernan.
pinta e wowonan.

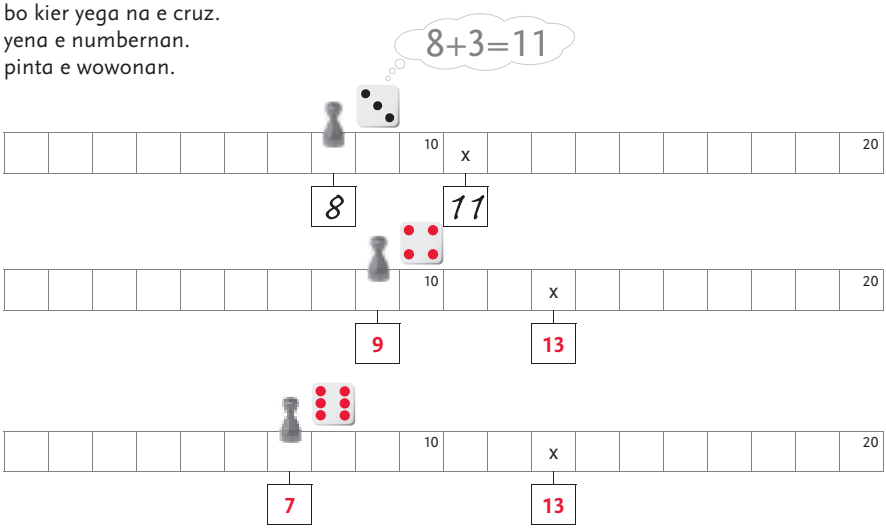

1

rek cu driehoek.
yena e numbernan y conecta.

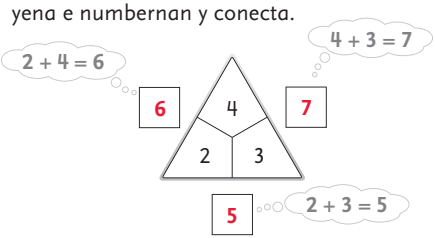

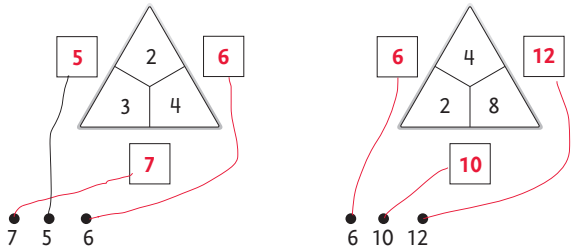

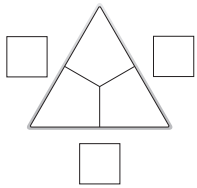

mas cu 1 contesta.

2

rek cu driehoek.

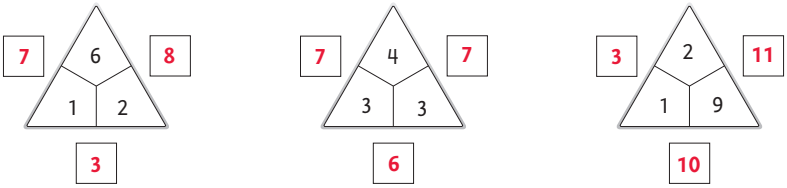

3

rek cu driehoek.

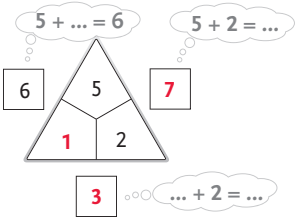

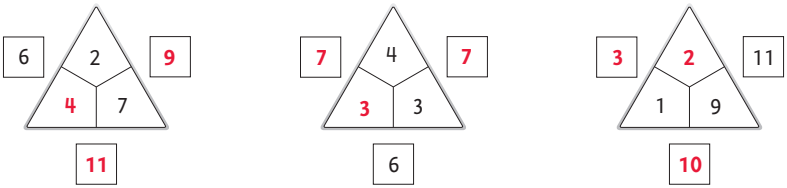

4 muraya di number.

cua di e somnan bo ta mira?
marca nan.

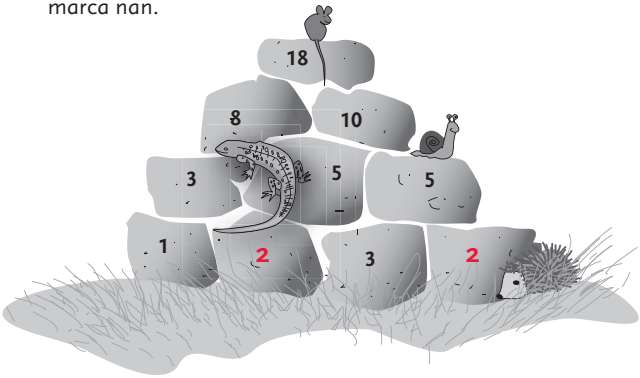

- [x] 5 + 5 = 10
- [x] 3 + 5 = 8
- [x] 1 + 2 = 3
- [ ] 1 + 4 = 5
- [x] 3 + 2 = 5
- [ ] 2 + 8 = 10
- [x] 2 + 3 = 5

completa e muraya.

5 traha muraya di number.

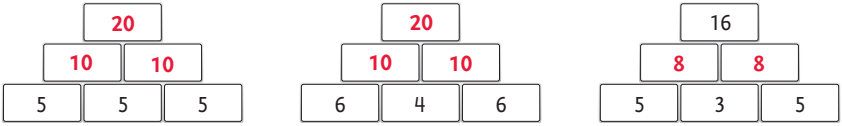

6 traha muraya di number.

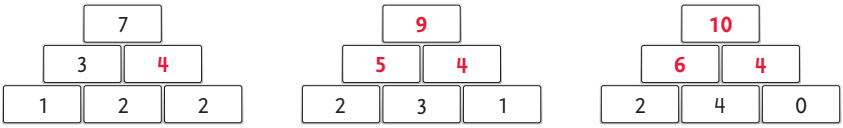

7 bo mes traha muraya di number. mas cu 1 contesta.

cuminsa abou.

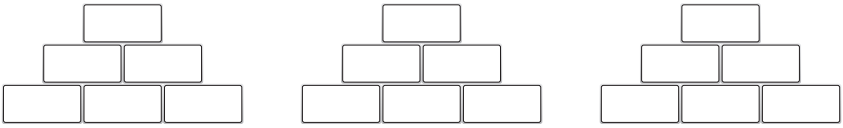

1 **cuanto mangel tin?** **mas cu 1 contesta.**
bo por traha 2 grupo igual?

bo mes pinta.

si/no

si/no

si/no

2 **2 mucha ta parti mangel.**
tur dos por haya mes hopi?



si/no



si/no



si/no

3 **par y impar.**
kleur e numbernan par.

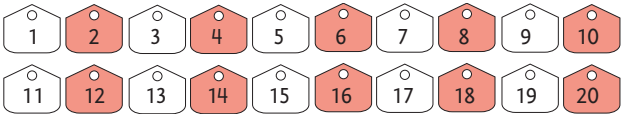

4 **cuanto cralchi a pone?**
par of impar?
yena e number y marca un cruz.



18 ☒ par ☐ impar

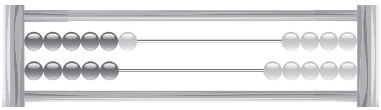

11 ☐ par ☒ impar



18 ☒ par ☐ impar

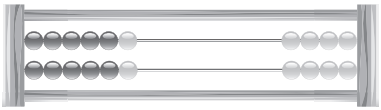

12 ☒ par ☐ impar

5

completa e som.
e contesta ta par of impar?
marca un cruz.



1 0 + 8 = 1 8 ☒ par ☐ impar



1 0 + 5 = 1 5 ☐ par ☒ impar



1 0 + 1 = 1 1 ☐ par ☒ impar

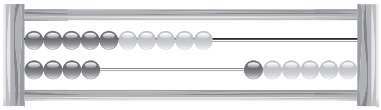

1 0 + 4 = 1 4 ☒ par ☐ impar

6

dobel y casi dobel.
pinta e somnan.



4 + 4 = 8



6 + 5 = 1 1

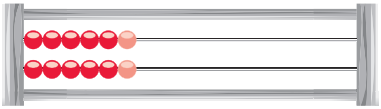

6 + 6 = 1 2



5 + 4 = 9

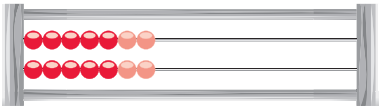

7 + 7 = 1 4

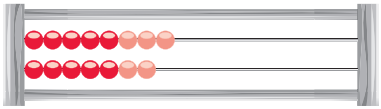

8 + 7 = 1 5

7

skirbi e numbernan di chikito bay grandi.

40	60	30	50
30	40	50	60

25	45	35	15
15	25	35	45

33	32	39	36
32	33	36	39

23	20	32	30
20	23	30	32

71	77	17	70
17	70	71	77

44	45	55	54
44	45	54	55

1 rek cu driehoek.

3 + 6 =

7 | 3 | 9 | 4 | 6

4 + 6 = 10

5 + 5 =

10 | 5 | 15 | 5 | 10

5 + 10 = 15

8 | 8 | 10 | 0 | 2

2

2 rek cu driehoek.

17 = 7 + ...

17 | 10 | 17 | 7 | 7

14 = 7 + ... 14

9 = 7 + ... 10 = 7 + ...

9 | 7 | 10 | 2 | 3

5

20 = 5 + ...

20 | 15 | 20 | 5 | 5

10

3 traha muraya di number.

10
5 | 5
2 | 3 | 2

12
6 | 6
3 | 3 | 3

14
7 | 7
3 | 4 | 3

4 cuanto cralchi a pone?

par of impar?
yena e number y marca un cruz.



16 ☒ par ☐ impar



13 ☐ par ☒ impar



17 ☐ par ☒ impar



19 ☐ par ☒ impar

5 conecta.

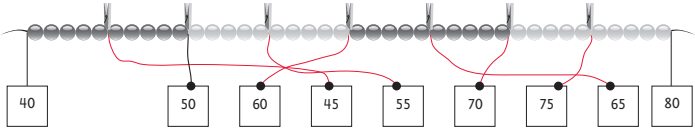

6 salto di 10.

completa e rij.

7 cua number ta pas memey?

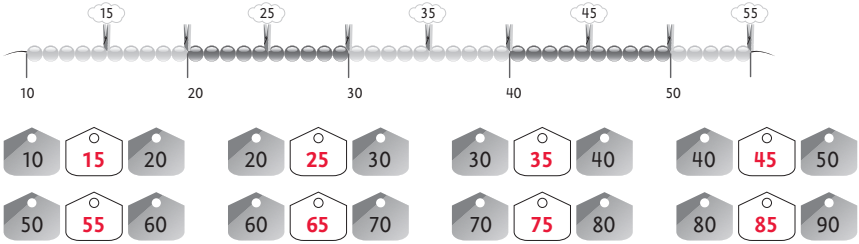

8 cuant'or tin?

awor tin:

9 or

aki mey ora:

9 or y mey

awor tin:

4 or y mey

aki mey ora:

5 or

awor tin:

7 or

mey ora pasa:

6 or y mey

awor tin:

11 or y mey

mey ora pasa:

11 or

1 cua number ta pas?

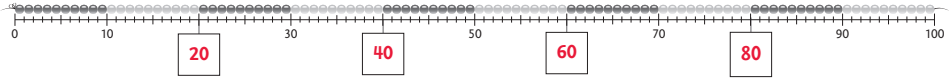

2 e cadena di cralchi.

marca 50.

marca 70.

marca 40.

marca 80.

3 conta decena y unidad.

skirbi y marca.

d decena	u unidad
2	6

26



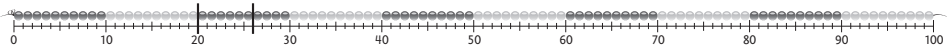

d decena	u unidad
3	2

32



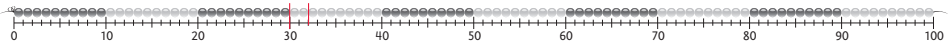

4 cuanto sticker tin?

d	u
5	3

53



d	u
8	7

87



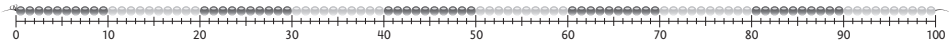

5 scrap e number cu no ta pas.

20	21	22	23	24	25	26	~~28~~	27	28	29	30
48	49	50	51	52	53	54	55	56	~~55~~	57	58
78	79	~~70~~	80	81	82	83	84	85	86	87	88

6 traha grupo di 10.

cuanto decena tin? cuanto unidad tin?

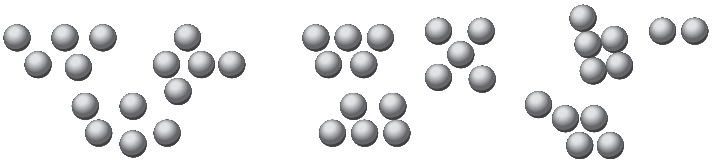

d	u
4	2

42

7 cuanto placa tin?

d	u
3	5

f 35



d	u
5	3

f 53



8 rek cu driehoek.

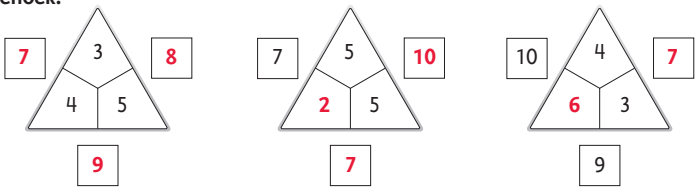

1 **cua grupo abo ta mira?**



5 grupo
grupo di 4
5 grupo di 4



4 grupo
grupo di 5
4 grupo di 5

10 grupo
grupo di 2
10 grupo di 2

2 **traha grupo.**

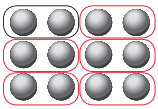

6 grupo
grupo di 2
6 grupo di 2

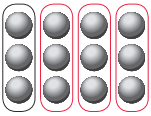

4 grupo
grupo di 3
4 grupo di 3

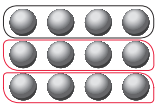

3 grupo
grupo di 4
3 grupo di 4

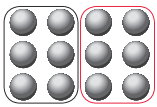

2 grupo
grupo di 6
2 grupo di 6

3 **traha grupo.**

2 grupo di 10.



5 grupo di 4.

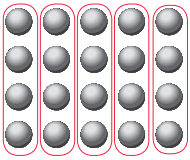

10 grupo di 2.

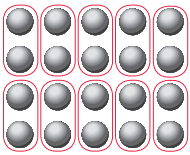

4 grupo di 5.

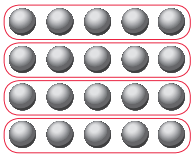

4

cua grupo bo ta mira?
cuanto tin hunto?



4 grupo di 2
hunto 8

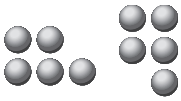

2 grupo di 5
hunto 10



3 grupo di 3
hunto 9

5

traha grupo.

grupo di 2.

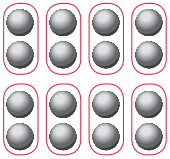

8 grupo di 2
hunto 16

grupo di 4.



4 grupo di 4
hunto 16

grupo di 4.

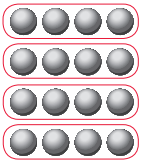

4 grupo di 4
hunto 16

grupo di 8.

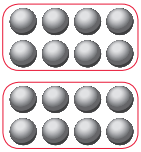

2 grupo di 8
hunto 16

6

cuant'or tin?
yena e ora.
marca e contesta corecto.

8 or y mey

8 or
mey ora mas
tempran/laat.

1 or y mey

2 or
mey ora mas
tempran/laat.

7 or y mey

7 or
mey ora mas
tempran/laat.

5 or y mey

6 or
mey ora mas
tempran/laat.

1

traha grupo di 10.
cuanto decena tin? cuanto unidad tin?



d	u
2	3

23



d	u
3	9

39



d	u
3	6

36

2

traha grupo.

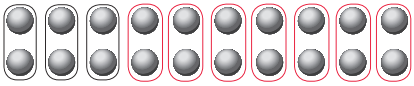

10 grupo di 2. hunto 20

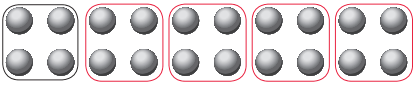

5 grupo di 4. hunto 20



4 grupo di 5. hunto 20

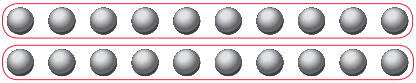

2 grupo di 10. hunto 20

3

traha 2 grupo igual.
pinta y yena e number.

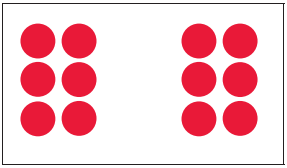

hunto tin 12.
cada un ta haya 6

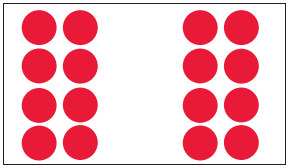

hunto tin 16.
cada un ta haya 8

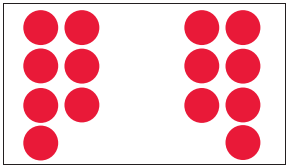

hunto tin 14.
cada un ta haya 7

4 yena e mita.

number	2	4	6
mita	1	2	3

number	8	10	12
mita	4	5	6

number	14	16	18
mita	7	8	9

5 yena e dobel.

number	1	2	4
dobel	2	4	8

number	5	10	7
dobel	10	20	14

number	3	6	9
dobel	6	12	18

6 traha grupo di 14 florin.

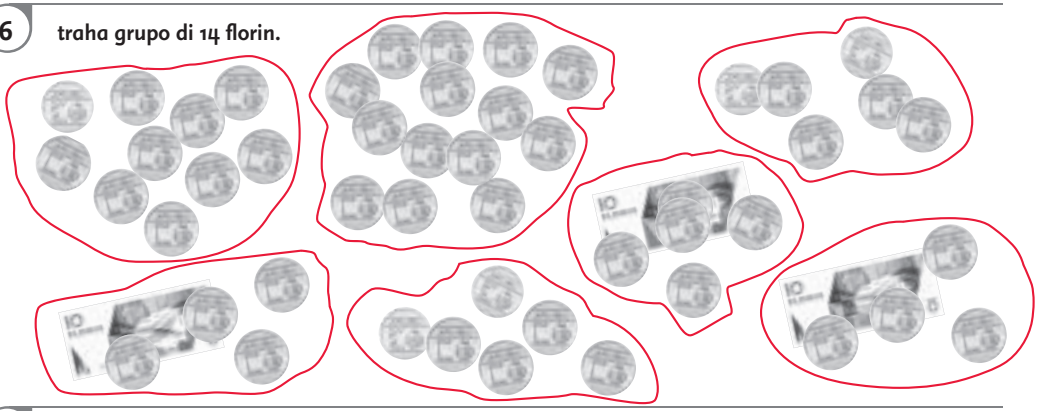

7 cuanto mester paga?

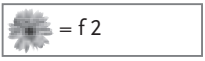 = f 2

= f 4

= f 6

 = f 8

 = f 10

 = f 12

8 traha som.

	7	+	7	=	1	4
	4	+	4	=		8
	9	+	9	=	1	8
	3	+	3	=		6

7	+		8	=	1	5
4	+		5	=		9
9	+	1	0	=	1	9
3	+		4	=		7

	7	+	6	=	1	3
	4	+	3	=		7
	9	+	8	=	1	7
	3	+	2	=		5

	8	+	7	=	1	5
	5	+	4	=		9
1	0	+	9	=	1	9
	5	+	3	=		8